Task card 1 Elapsed Time

A recess starts at 4:20. It lasts 2 hours. What time does it end?



Task card 2 Elapsed Time

A game starts at 9:35. It lasts 1 hour. What time does it end?



Task card 3 Elapsed Time

A class starts at 3:50. It lasts 1 hour. What time does it end?



Task card 4 Elapsed Time

A game starts at 12:55. It lasts 3 hours. What time does it end?



Task card 5 Elapsed Time

A game starts at 1:35. It lasts 2 hours. What time does it end?



Task card 6 Elapsed Time

A game starts at 4:00. It lasts 2 hours. What time does it end?



Task card 7 Elapsed Time

A recess starts at 6:00. It lasts 2 hours. What time does it end?



Task card 8 Elapsed Time

A movie starts at 9:25. It lasts 2 hours. What time does it end?



Task card 9 Elapsed Time

A movie starts at 4:30. It lasts 1 hour. What time does it end?



Task card 10 Elapsed Time

A game starts at 6:45. It lasts 3 hours. What time does it end?



Task card 11 Elapsed Time

A movie starts at 11:15. It lasts 2 hours. What time does it end?



Task card 12 Elapsed Time

A recess starts at 10:50. It lasts 2 hours. What time does it end?



Task card 13 Elapsed Time

A movie starts at 12:30. It lasts 3 hours. What time does it end?



Task card 14 Elapsed Time

A movie starts at 7:35. It lasts 3 hours. What time does it end?



Task card 15 Elapsed Time

A class starts at 1:50. It lasts 1 hour. What time does it end?



Task card 16 Elapsed Time

A game starts at 10:00. It lasts 3 hours. What time does it end?



Task card 17 Elapsed Time

A class starts at 4:00. It lasts 1 hour. What time does it end?



Task card 18 Elapsed Time

A recess starts at 1:10. It lasts 1 hour. What time does it end?



Task card 19 Elapsed Time

A class starts at 8:20. It lasts 3 hours. What time does it end?



Task card 20 Elapsed Time

A movie starts at 10:10. It lasts 1 hour. What time does it end?



Task card 21 Elapsed Time

A recess starts at 4:40. It lasts 3 hours. What time does it end?



Task card 22 Elapsed Time

A recess starts at 11:35. It lasts 1 hour. What time does it end?



Task card 23 Elapsed Time

A movie starts at 12:00. It lasts 1 hour. What time does it end?



Task card 24 Elapsed Time

A class starts at 12:55. It lasts 3 hours. What time does it end?



Elapsed Time Task Cards

Recording sheet · Grade 3 · Find the end time.

Name: _____ Date: _____

Scan to check your answers

1	2	3	4
5	6	7	8
9	10	11	12
13	14	15	16
17	18	19	20
21	22	23	24

Elapsed Time Task Cards: Answer Key

Grade 3 · Easy

The answers online

1. 6:20	**2.** 10:35	**3.** 4:50
4. 3:55	**5.** 3:35	**6.** 6:00
7. 8:00	**8.** 11:25	**9.** 5:30
10. 9:45	**11.** 1:15	**12.** 12:50
13. 3:30	**14.** 10:35	**15.** 2:50
16. 1:00	**17.** 5:00	**18.** 2:10
19. 11:20	**20.** 11:10	**21.** 7:40
22. 12:35	**23.** 1:00	**24.** 3:55