Elapsed Time · 1

A class starts at 10:15. It lasts 1 hour. What time does it end?



Elapsed Time · 2

A game starts at 10:25. It lasts 2 hours. What time does it end?



Elapsed Time · 3

A game starts at 11:35. It lasts 3 hours. What time does it end?



Elapsed Time · 4

A game starts at 11:05. It lasts 2 hours. What time does it end?



Elapsed Time · 5

A class starts at 3:00. It lasts 1 hour. What time does it end?



Elapsed Time · 6

A movie starts at 1:05. It lasts 1 hour. What time does it end?



Elapsed Time · 7

A game starts at 9:00. It lasts 2 hours. What time does it end?



Elapsed Time · 8

A class starts at 8:15. It lasts 3 hours. What time does it end?



Elapsed Time · 2

ANSWER

12:25

Elapsed Time · 1

ANSWER

11:15

Elapsed Time · 4

ANSWER

1:05

Elapsed Time · 3

ANSWER

2:35

Elapsed Time · 6

ANSWER

2:05

Elapsed Time · 5

ANSWER

4:00

Elapsed Time · 8

ANSWER

11:15

Elapsed Time · 7

ANSWER

11:00

Elapsed Time · 9

A movie starts at 9:30. It lasts 3 hours and 10 minutes. What time does it end?



Elapsed Time · 10

A game starts at 2:05. It lasts 3 hours and 30 minutes. What time does it end?



Elapsed Time · 11

A game starts at 8:25. It lasts 2 hours and 55 minutes. What time does it end?



Elapsed Time · 12

A class starts at 5:35. It lasts 1 hour and 25 minutes. What time does it end?



Elapsed Time · 13

A game starts at 7:50. It lasts 1 hour and 20 minutes. What time does it end?



Elapsed Time · 14

A recess starts at 2:40. It lasts 1 hour and 30 minutes. What time does it end?



Elapsed Time · 15

A recess starts at 12:10. It lasts 1 hour and 30 minutes. What time does it end?



Elapsed Time · 16

A movie starts at 1:25. It lasts 1 hour and 30 minutes. What time does it end?



Elapsed Time · 10

ANSWER

5:35

Elapsed Time · 9

ANSWER

12:40

Elapsed Time · 12

ANSWER

7:00

Elapsed Time · 11

ANSWER

11:20

Elapsed Time · 14

ANSWER

4:10

Elapsed Time · 13

ANSWER

9:10

Elapsed Time · 16

ANSWER

2:55

Elapsed Time · 15

ANSWER

1:40

Elapsed Time · 17

A recess starts at 5:20. It lasts 3 hours and 10 minutes. What time does it end?



Elapsed Time · 18

A game starts at 12:35. It lasts 3 hours and 5 minutes. What time does it end?



Elapsed Time · 19

A movie starts at 3:45. It lasts 1 hour and 30 minutes. What time does it end?



Elapsed Time · 20

A movie starts at 8:20. It lasts 2 hours and 20 minutes. What time does it end?



Elapsed Time · 21

A recess starts at 2:55. It lasts 3 hours and 40 minutes. What time does it end?



Elapsed Time · 22

A class starts at 6:05. It lasts 3 hours and 45 minutes. What time does it end?



Elapsed Time · 23

A recess starts at 11:30. It lasts 3 hours and 35 minutes. What time does it end?



Elapsed Time · 24

A movie starts at 1:35. It lasts 3 hours and 35 minutes. What time does it end?



Elapsed Time · 18

ANSWER

3:40

Elapsed Time · 17

ANSWER

8:30

Elapsed Time · 20

ANSWER

10:40

Elapsed Time · 19

ANSWER

5:15

Elapsed Time · 22

ANSWER

9:50

Elapsed Time · 21

ANSWER

6:35

Elapsed Time · 24

ANSWER

5:10

Elapsed Time · 23

ANSWER

3:05