Elapsed Time · 1

A recess starts at 4:20. It lasts 2 hours. What time does it end?



Elapsed Time · 2

A game starts at 9:35. It lasts 1 hour. What time does it end?



Elapsed Time · 3

A class starts at 3:50. It lasts 1 hour. What time does it end?



Elapsed Time · 4

A game starts at 12:55. It lasts 3 hours. What time does it end?



Elapsed Time · 5

A game starts at 1:35. It lasts 2 hours. What time does it end?



Elapsed Time · 6

A game starts at 4:00. It lasts 2 hours. What time does it end?



Elapsed Time · 7

A recess starts at 6:00. It lasts 2 hours. What time does it end?



Elapsed Time · 8

A movie starts at 9:25. It lasts 2 hours. What time does it end?



Elapsed Time · 2

ANSWER

10:35

Elapsed Time · 1

ANSWER

6:20

Elapsed Time · 4

ANSWER

3:55

Elapsed Time · 3

ANSWER

4:50

Elapsed Time · 6

ANSWER

6:00

Elapsed Time · 5

ANSWER

3:35

Elapsed Time · 8

ANSWER

11:25

Elapsed Time · 7

ANSWER

8:00

Elapsed Time · 9

A movie starts at 4:30. It lasts 1 hour. What time does it end?



Elapsed Time · 10

A game starts at 6:45. It lasts 3 hours. What time does it end?



Elapsed Time · 11

A movie starts at 11:15. It lasts 2 hours. What time does it end?



Elapsed Time · 12

A recess starts at 10:50. It lasts 2 hours. What time does it end?



Elapsed Time · 13

A movie starts at 12:30. It lasts 3 hours. What time does it end?



Elapsed Time · 14

A movie starts at 7:35. It lasts 3 hours. What time does it end?



Elapsed Time · 15

A class starts at 1:50. It lasts 1 hour. What time does it end?



Elapsed Time · 16

A game starts at 10:00. It lasts 3 hours. What time does it end?



Elapsed Time · 10

ANSWER

9:45

Elapsed Time · 9

ANSWER

5:30

Elapsed Time · 12

ANSWER

12:50

Elapsed Time · 11

ANSWER

1:15

Elapsed Time · 14

ANSWER

10:35

Elapsed Time · 13

ANSWER

3:30

Elapsed Time · 16

ANSWER

1:00

Elapsed Time · 15

ANSWER

2:50

Elapsed Time · 17

A class starts at 4:00. It lasts 1 hour. What time does it end?



Elapsed Time · 18

A recess starts at 1:10. It lasts 1 hour. What time does it end?



Elapsed Time · 19

A class starts at 8:20. It lasts 3 hours. What time does it end?



Elapsed Time · 20

A movie starts at 10:10. It lasts 1 hour. What time does it end?



Elapsed Time · 21

A recess starts at 4:40. It lasts 3 hours. What time does it end?



Elapsed Time · 22

A recess starts at 11:35. It lasts 1 hour. What time does it end?



Elapsed Time · 23

A movie starts at 12:00. It lasts 1 hour. What time does it end?



Elapsed Time · 24

A class starts at 12:55. It lasts 3 hours. What time does it end?



Elapsed Time · 18

ANSWER

2:10

Elapsed Time · 17

ANSWER

5:00

Elapsed Time · 20

ANSWER

11:10

Elapsed Time · 19

ANSWER

11:20

Elapsed Time · 22

ANSWER

12:35

Elapsed Time · 21

ANSWER

7:40

Elapsed Time · 24

ANSWER

3:55

Elapsed Time · 23

ANSWER

1:00