Task card 1 Easter Math

Mia shares 16 carrot muffins equally among 8 friends. How many carrot muffins does each friend get?

Task card 2 Easter Math

At the Easter brunch there are 8 tables. 6 people sit at each table. How many people are there?

Task card 3 Easter Math

The spring picnic starts at 12:00. It lasts 3 hours. What time does the picnic end?



Task card 4 Easter Math

A carrot cake is cut into 6 equal slices. The family eats 1 slice. What fraction of the carrot cake did they eat?

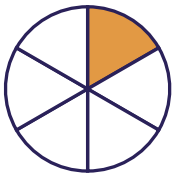

Task card 5 Easter Math

At the Easter brunch there are 7 tables. 5 people sit at each table. How many people are there?

Task card 6 Easter Math

A carrot cake is cut into 8 equal slices. The family eats 7 slices. What fraction of the carrot cake did they eat?

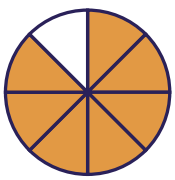

Task card 7 Easter Math

The spring picnic starts at 1:30. It lasts 5 hours. What time does the picnic end?



Task card 8 Easter Math

Zoe shares 20 bunny cookies equally among 2 friends. How many bunny cookies does each friend get?

Task card 9 Easter Math

A carrot cake is cut into 10 equal slices. The family eats 9 slices. What fraction of the carrot cake did they eat?

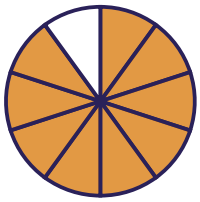

Task card 10 Easter Math

At the Easter brunch there are 3 tables. 2 people sit at each table. How many people are there?

Task card 11 Easter Math

The spring picnic starts at 11:00. It lasts 4 hours. What time does the picnic end?



Task card 12 Easter Math

Leo shares 90 carrot muffins equally among 9 friends. How many carrot muffins does each friend get?

Task card 13 Easter Math

At the Easter brunch there are 9 tables. 4 people sit at each table. How many people are there?

Task card 14 Easter Math

The spring picnic starts at 10:30. It lasts 5 hours. What time does the picnic end?



Task card 15 Easter Math

Zoe shares 24 bunny cookies equally among 4 friends. How many bunny cookies does each friend get?

Task card 16 Easter Math

A carrot cake is cut into 12 equal slices. The family eats 11 slices. What fraction of the carrot cake did they eat?

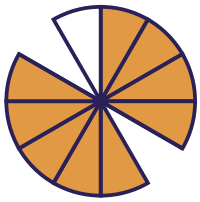

Task card 17 Easter Math

At the Easter brunch there are 2 tables. 4 people sit at each table. How many people are there?

Task card 18 Easter Math

A carrot cake is cut into 12 equal slices. The family eats 7 slices. What fraction of the carrot cake did they eat?

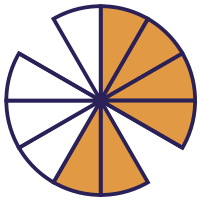

Task card 19 Easter Math

At the Easter brunch there are 7 tables. 9 people sit at each table. How many people are there?

Task card 20 Easter Math

The spring picnic starts at 1:30. It lasts 2 hours. What time does the picnic end?



Task card 21 Easter Math

A carrot cake is cut into 8 equal slices. The family eats 3 slices. What fraction of the carrot cake did they eat?

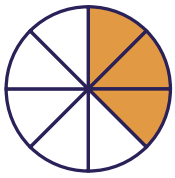

Task card 22 Easter Math

Leo shares 15 hot cross buns equally among 5 friends. How many hot cross buns does each friend get?

Task card 23 Easter Math

Mia shares 14 bunny cookies equally among 7 friends. How many bunny cookies does each friend get?

Task card 24 Easter Math

Mia shares 10 bunny cookies equally among 2 friends. How many bunny cookies does each friend get?

Easter Math Task Cards

Recording sheet · Grade 3 · Read each story and solve. Write times like 3:00 and fractions like 3/8.

Name: _____ Date: _____

Scan to check your answers

1	2	3	4
5	6	7	8
9	10	11	12
13	14	15	16
17	18	19	20
21	22	23	24

Easter Math Task Cards: Answer Key

Grade 3 · Hard

The answers online

1. 2	**2.** 48	**3.** 3:00
4. $\frac{1}{6}$	**5.** 35	**6.** $\frac{7}{8}$
7. 6:30	**8.** 10	**9.** $\frac{9}{10}$
10. 6	**11.** 3:00	**12.** 10
13. 36	**14.** 3:30	**15.** 6
16. $\frac{11}{12}$	**17.** 8	**18.** $\frac{7}{12}$
19. 63	**20.** 3:30	**21.** $\frac{3}{8}$
22. 3	**23.** 2	**24.** 5