Easter Math · 1

Mia shares 16 carrot muffins equally among 8 friends. How many carrot muffins does each friend get?

Easter Math · 2

At the Easter brunch there are 8 tables. 6 people sit at each table. How many people are there?

Easter Math · 3

The spring picnic starts at 12:00. It lasts 3 hours. What time does the picnic end?



Easter Math · 4

A carrot cake is cut into 6 equal slices. The family eats 1 slice. What fraction of the carrot cake did they eat?

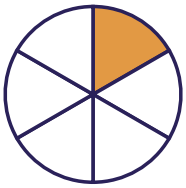

Easter Math · 5

At the Easter brunch there are 7 tables. 5 people sit at each table. How many people are there?

Easter Math · 6

A carrot cake is cut into 8 equal slices. The family eats 7 slices. What fraction of the carrot cake did they eat?

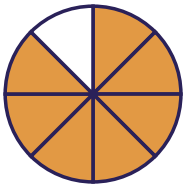

Easter Math · 7

The spring picnic starts at 1:30. It lasts 5 hours. What time does the picnic end?



Easter Math · 8

Zoe shares 20 bunny cookies equally among 2 friends. How many bunny cookies does each friend get?

Easter Math · 2

ANSWER

48

Easter Math · 1

ANSWER

2

Easter Math · 4

ANSWER

$\frac{1}{6}$

Easter Math · 3

ANSWER

3:00

Easter Math · 6

ANSWER

$\frac{7}{8}$

Easter Math · 5

ANSWER

35

Easter Math · 8

ANSWER

10

Easter Math · 7

ANSWER

6:30

Easter Math · 9

A carrot cake is cut into 10 equal slices. The family eats 9 slices. What fraction of the carrot cake did they eat?

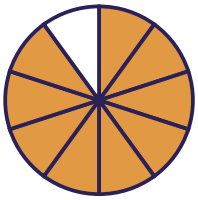

Easter Math · 10

At the Easter brunch there are 3 tables. 2 people sit at each table. How many people are there?

Easter Math · 11

The spring picnic starts at 11:00. It lasts 4 hours. What time does the picnic end?



Easter Math · 12

Leo shares 90 carrot muffins equally among 9 friends. How many carrot muffins does each friend get?

Easter Math · 13

At the Easter brunch there are 9 tables. 4 people sit at each table. How many people are there?

Easter Math · 14

The spring picnic starts at 10:30. It lasts 5 hours. What time does the picnic end?



Easter Math · 15

Zoe shares 24 bunny cookies equally among 4 friends. How many bunny cookies does each friend get?

Easter Math · 16

A carrot cake is cut into 12 equal slices. The family eats 11 slices. What fraction of the carrot cake did they eat?

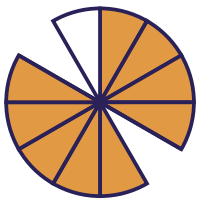

Easter Math · 10

ANSWER

6

Easter Math · 9

ANSWER

$\frac{9}{10}$

Easter Math · 12

ANSWER

10

Easter Math · 11

ANSWER

$3:00$

Easter Math · 14

ANSWER

$3:30$

Easter Math · 13

ANSWER

36

Easter Math · 16

ANSWER

$\frac{11}{12}$

Easter Math · 15

ANSWER

6

Easter Math · 17

At the Easter brunch there are 2 tables. 4 people sit at each table. How many people are there?

Easter Math · 18

A carrot cake is cut into 12 equal slices. The family eats 7 slices. What fraction of the carrot cake did they eat?



Easter Math · 19

At the Easter brunch there are 7 tables. 9 people sit at each table. How many people are there?

Easter Math · 20

The spring picnic starts at 1:30. It lasts 2 hours. What time does the picnic end?



Easter Math · 21

A carrot cake is cut into 8 equal slices. The family eats 3 slices. What fraction of the carrot cake did they eat?

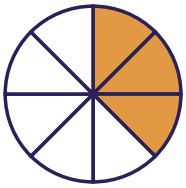

Easter Math · 22

Leo shares 15 hot cross buns equally among 5 friends. How many hot cross buns does each friend get?

Easter Math · 23

Mia shares 14 bunny cookies equally among 7 friends. How many bunny cookies does each friend get?

Easter Math · 24

Mia shares 10 bunny cookies equally among 2 friends. How many bunny cookies does each friend get?

Easter Math · 18

ANSWER

$\frac{7}{12}$

Easter Math · 17

ANSWER

8

Easter Math · 20

ANSWER

3:30

Easter Math · 19

ANSWER

63

Easter Math · 22

ANSWER

3

Easter Math · 21

ANSWER

$\frac{3}{8}$

Easter Math · 24

ANSWER

5

Easter Math · 23

ANSWER

2