Easter Math · 1

At the Easter brunch there are 7 tables. 4 people sit at each table. How many people are there?

Easter Math · 2

A carrot cake is cut into 12 equal slices. The family eats 7 slices. What fraction of the carrot cake did they eat?



Easter Math · 3

The spring picnic starts at 10:00. It lasts 4 hours. What time does the picnic end?



Easter Math · 4

The spring picnic starts at 11:00. It lasts 4 hours. What time does the picnic end?



Easter Math · 5

Ava shares 18 bunny cookies equally among 9 friends. How many bunny cookies does each friend get?

Easter Math · 6

At the Easter brunch there are 2 tables. 6 people sit at each table. How many people are there?

Easter Math · 7

A carrot cake is cut into 10 equal slices. The family eats 1 slice. What fraction of the carrot cake did they eat?



Easter Math · 8

Zoe shares 28 hot cross buns equally among 4 friends. How many hot cross buns does each friend get?

Easter Math · 2

ANSWER

$\frac{7}{12}$

Easter Math · 1

ANSWER

28

Easter Math · 4

ANSWER

3:00

Easter Math · 3

ANSWER

2:00

Easter Math · 6

ANSWER

12

Easter Math · 5

ANSWER

2

Easter Math · 8

ANSWER

7

Easter Math · 7

ANSWER

$\frac{1}{10}$

Easter Math · 9

A carrot cake is cut into 10 equal slices. The family eats 7 slices. What fraction of the carrot cake did they eat?

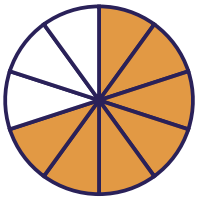

Easter Math · 10

Ben shares 16 bunny cookies equally among 8 friends. How many bunny cookies does each friend get?

Easter Math · 11

At the Easter brunch there are 7 tables. 2 people sit at each table. How many people are there?

Easter Math · 12

Lily shares 12 hot cross buns equally among 3 friends. How many hot cross buns does each friend get?

Easter Math · 13

The spring picnic starts at 12:30. It lasts 3 hours. What time does the picnic end?



Easter Math · 14

At the Easter brunch there are 6 tables. 3 people sit at each table. How many people are there?

Easter Math · 15

A carrot cake is cut into 6 equal slices. The family eats 5 slices. What fraction of the carrot cake did they eat?

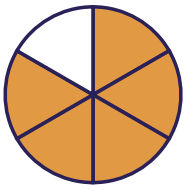

Easter Math · 16

Mia shares 56 bunny cookies equally among 7 friends. How many bunny cookies does each friend get?

Easter Math · 10

ANSWER

2

Easter Math · 9

ANSWER

$$\frac{7}{10}$$

Easter Math · 12

ANSWER

4

Easter Math · 11

ANSWER

14

Easter Math · 14

ANSWER

18

Easter Math · 13

ANSWER

3:30

Easter Math · 16

ANSWER

8

Easter Math · 15

ANSWER

$$\frac{5}{6}$$

Easter Math · 17

At the Easter brunch there are 8 tables. 7 people sit at each table. How many people are there?

Easter Math · 18

Ben shares 28 carrot muffins equally among 7 friends. How many carrot muffins does each friend get?

Easter Math · 19

The spring picnic starts at 1:00. It lasts 3 hours. What time does the picnic end?



Easter Math · 20

A carrot cake is cut into 12 equal slices. The family eats 11 slices. What fraction of the carrot cake did they eat?

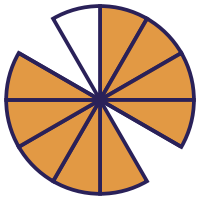

Easter Math · 21

The spring picnic starts at 10:00. It lasts 3 hours. What time does the picnic end?



Easter Math · 22

At the Easter brunch there are 4 tables. 5 people sit at each table. How many people are there?

Easter Math · 23

Noah shares 24 carrot muffins equally among 6 friends. How many carrot muffins does each friend get?

Easter Math · 24

At the Easter brunch there are 7 tables. 6 people sit at each table. How many people are there?

Easter Math · 18

ANSWER

4

Easter Math · 17

ANSWER

56

Easter Math · 20

ANSWER

$$\frac{11}{12}$$

Easter Math · 19

ANSWER

4:00

Easter Math · 22

ANSWER

20

Easter Math · 21

ANSWER

1:00

Easter Math · 24

ANSWER

42

Easter Math · 23

ANSWER

4