Easter Math · 1

At the Easter brunch there are 6 tables. 5 people sit at each table. How many people are there?

Easter Math · 2

A carrot cake is cut into 6 equal slices. The family eats 1 slice. What fraction of the carrot cake did they eat?

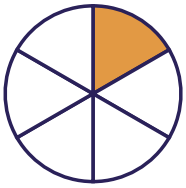

Easter Math · 3

A carrot cake is cut into 4 equal slices. The family eats 3 slices. What fraction of the carrot cake did they eat?



Easter Math · 4

At the Easter brunch there are 7 tables. 2 people sit at each table. How many people are there?

Easter Math · 5

The spring picnic starts at 1:00. It lasts 3 hours. What time does the picnic end?



Easter Math · 6

Sam shares 45 bunny cookies equally among 9 friends. How many bunny cookies does each friend get?

Easter Math · 7

The spring picnic starts at 12:00. It lasts 5 hours. What time does the picnic end?



Easter Math · 8

Ben shares 18 hot cross buns equally among 9 friends. How many hot cross buns does each friend get?

Easter Math · 2

ANSWER

$\frac{1}{6}$

Easter Math · 1

ANSWER

30

Easter Math · 4

ANSWER

14

Easter Math · 3

ANSWER

$\frac{3}{4}$

Easter Math · 6

ANSWER

5

Easter Math · 5

ANSWER

4:00

Easter Math · 8

ANSWER

2

Easter Math · 7

ANSWER

5:00

Easter Math · 9

A carrot cake is cut into 4 equal slices. The family eats 1 slice. What fraction of the carrot cake did they eat?



Easter Math · 10

Mia shares 12 hot cross buns equally among 6 friends. How many hot cross buns does each friend get?

Easter Math · 11

A carrot cake is cut into 6 equal slices. The family eats 5 slices. What fraction of the carrot cake did they eat?

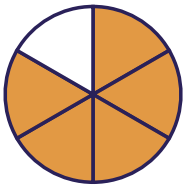

Easter Math · 12

The spring picnic starts at 10:00. It lasts 5 hours. What time does the picnic end?



Easter Math · 13

Zoe shares 18 bunny cookies equally among 3 friends. How many bunny cookies does each friend get?

Easter Math · 14

The spring picnic starts at 11:00. It lasts 4 hours. What time does the picnic end?



Easter Math · 15

At the Easter brunch there are 2 tables. 2 people sit at each table. How many people are there?

Easter Math · 16

Leo shares 15 carrot muffins equally among 3 friends. How many carrot muffins does each friend get?

Easter Math · 10

ANSWER

2

Easter Math · 9

ANSWER

$\frac{1}{4}$

Easter Math · 12

ANSWER

3:00

Easter Math · 11

ANSWER

$\frac{5}{6}$

Easter Math · 14

ANSWER

3:00

Easter Math · 13

ANSWER

6

Easter Math · 16

ANSWER

5

Easter Math · 15

ANSWER

4

Easter Math · 17

At the Easter brunch there are 3 tables. 3 people sit at each table. How many people are there?

Easter Math · 18

The spring picnic starts at 11:00. It lasts 2 hours. What time does the picnic end?



Easter Math · 19

A carrot cake is cut into 8 equal slices. The family eats 3 slices. What fraction of the carrot cake did they eat?

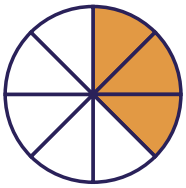

Easter Math · 20

Leo shares 8 bunny cookies equally among 4 friends. How many bunny cookies does each friend get?

Easter Math · 21

At the Easter brunch there are 5 tables. 4 people sit at each table. How many people are there?

Easter Math · 22

The spring picnic starts at 1:00. It lasts 5 hours. What time does the picnic end?



Easter Math · 23

A carrot cake is cut into 8 equal slices. The family eats 7 slices. What fraction of the carrot cake did they eat?

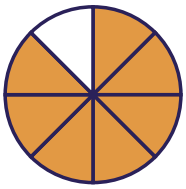

Easter Math · 24

Omar shares 6 carrot muffins equally among 2 friends. How many carrot muffins does each friend get?

Easter Math · 18

ANSWER

1:00

Easter Math · 17

ANSWER

9

Easter Math · 20

ANSWER

2

Easter Math · 19

ANSWER

$$\frac{3}{8}$$

Easter Math · 22

ANSWER

6:00

Easter Math · 21

ANSWER

20

Easter Math · 24

ANSWER

3

Easter Math · 23

ANSWER

$$\frac{7}{8}$$