Division Facts (Mixed Divisors) · 1

$32 \div 4 = ___$

Division Facts (Mixed Divisors) · 2

$50 \div 5 = ___$

Division Facts (Mixed Divisors) · 3

$6 \div 3 = ___$

Division Facts (Mixed Divisors) · 4

10 stars are in 5 equal rows. How many stars are in each row?



Division Facts (Mixed Divisors) · 5

Jumps of 2 from 0 land on 8. How many jumps is that?



Division Facts (Mixed Divisors) · 6

$20 - 4 - 4 - 4 - 4 - 4 = 0$. How many 4s were taken away? $20 \div 4 = ___$

Division Facts (Mixed Divisors) · 7

$___ \div 3 = 8$

Division Facts (Mixed Divisors) · 8

$24 \div ___ = 8$

Division Facts (Mixed Divisors) · 2

ANSWER

10

Division Facts (Mixed Divisors) · 1

ANSWER

8

Division Facts (Mixed Divisors) · 4

ANSWER

2

Division Facts (Mixed Divisors) · 3

ANSWER

2

Division Facts (Mixed Divisors) · 6

ANSWER

5

Division Facts (Mixed Divisors) · 5

ANSWER

4

Division Facts (Mixed Divisors) · 8

ANSWER

3

Division Facts (Mixed Divisors) · 7

ANSWER

24

Division Facts (Mixed Divisors) · 9

63 stickers are shared equally among 9 packs. How many stickers are in each pack?

Division Facts (Mixed Divisors) · 10

99 ÷ 11 = 9. One more group of 11 makes 110, so 110 ÷ 11 = ___

Division Facts (Mixed Divisors) · 11

12 ÷ 6 = ___

Division Facts (Mixed Divisors) · 12

80 ÷ 10 = ___

Division Facts (Mixed Divisors) · 13

72 stars are in 6 equal rows. How many stars are in each row?



Division Facts (Mixed Divisors) · 14

Jumps of 6 from 0 land on 12. How many jumps is that?

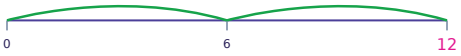

Division Facts (Mixed Divisors) · 15

10 − 5 − 5 = 0. How many 5s were taken away? 10 ÷ 5 = ___

Division Facts (Mixed Divisors) · 16

___ ÷ 6 = 3

Division Facts (Mixed Divisors) · 10

ANSWER

10

Division Facts (Mixed Divisors) · 9

ANSWER

7

Division Facts (Mixed Divisors) · 12

ANSWER

8

Division Facts (Mixed Divisors) · 11

ANSWER

2

Division Facts (Mixed Divisors) · 14

ANSWER

2

Division Facts (Mixed Divisors) · 13

ANSWER

12

Division Facts (Mixed Divisors) · 16

ANSWER

18

Division Facts (Mixed Divisors) · 15

ANSWER

2

Division Facts (Mixed Divisors) · 17

$50 \div ___ = 10$

Division Facts (Mixed Divisors) · 18

30 players are shared equally among 10 teams. How many players are on each team?

Division Facts (Mixed Divisors) · 19

55 ÷ 5 = 11. One more group of 5 makes 60, so 60 ÷ 5 = ___

Division Facts (Mixed Divisors) · 20

$40 \div 4 = ___$

Division Facts (Mixed Divisors) · 21

$24 \div 3 = ___$

Division Facts (Mixed Divisors) · 22

$40 \div 8 = ___$

Division Facts (Mixed Divisors) · 23

36 stars are in rows of 9. How many rows are there?



Division Facts (Mixed Divisors) · 24

Jumps of 7 from 0 land on 35. How many jumps is that?



Division Facts (Mixed Divisors) · 18

ANSWER

3

Division Facts (Mixed Divisors) · 17

ANSWER

5

Division Facts (Mixed Divisors) · 20

ANSWER

10

Division Facts (Mixed Divisors) · 19

ANSWER

12

Division Facts (Mixed Divisors) · 22

ANSWER

5

Division Facts (Mixed Divisors) · 21

ANSWER

8

Division Facts (Mixed Divisors) · 24

ANSWER

5

Division Facts (Mixed Divisors) · 23

ANSWER

4