Task card 1 Division: Sharing & Grouping

Share 24 hearts equally among 4 plates. How many hearts does each get?



Task card 2 Division: Sharing & Grouping

There are 18 stickers. They are put into cups with 6 in each. How many cups are filled?



Task card 3 Division: Sharing & Grouping

This array shows 14 stars in 2 equal rows. 14 ÷ 2 = ___



Task card 4 Division: Sharing & Grouping

12 ÷ 3 = ___

Task card 5 Division: Sharing & Grouping

Share 21 marbles equally among 7 kids. How many marbles does each get?



Task card 6 Division: Sharing & Grouping

There are 10 hearts. They are put into bags with 5 in each. How many bags are filled?



Task card 7 Division: Sharing & Grouping

This array shows 8 stars in 4 equal rows. 8 ÷ 4 = ___



Task card 8 Division: Sharing & Grouping

How many groups of 6 are in 42?

Task card 9 Division: Sharing & Grouping

Share 40 apples equally among 8 kids. How many apples does each get?



Task card 10 Division: Sharing & Grouping

There are 28 marbles. They are put into boxes with 7 in each. How many boxes are filled?



Task card 11 Division: Sharing & Grouping

This array shows 9 stars in 3 equal rows. 9 ÷ 3 = ___



Task card 12 Division: Sharing & Grouping

How many groups of 3 are in 21?

Task card 13 Division: Sharing & Grouping

Share 15 stickers equally among 3 kids. How many stickers does each get?



Task card 14 Division: Sharing & Grouping

There are 36 balloons. They are put into boxes with 6 in each. How many boxes are filled?



Task card 15 Division: Sharing & Grouping

$9 \div 3 = ___$

Task card 16 Division: Sharing & Grouping

Share 12 balloons equally among 2 kids. How many balloons does each get?

Task card 17 Division: Sharing & Grouping

There are 42 apples. They are put into boxes with 7 in each. How many boxes are filled?

Task card 18 Division: Sharing & Grouping

This array shows 6 stars in 3 equal rows. 6 ÷ 3 = ___



Task card 19 Division: Sharing & Grouping

$18 \div 3 = ___$

Task card 20 Division: Sharing & Grouping

Share 35 stickers equally among 5 kids. How many stickers does each get?

Task card 21 Division: Sharing & Grouping

There are 14 apples. They are put into cups with 2 in each. How many cups are filled?

Task card 22 Division: Sharing & Grouping

$35 \div 5 = ___$

Task card 23 Division: Sharing & Grouping

Share 6 marbles equally among 2 kids. How many marbles does each get?



Task card 24 Division: Sharing & Grouping

There are 30 hearts. They are put into bowls with 5 in each. How many bowls are filled?



Division: Sharing & Grouping Task Cards

Recording sheet · Grade 3 · Share or group the objects equally to find each answer.

Name: _____ Date: _____

Scan to check your answers

1	2	3	4
5	6	7	8
9	10	11	12
13	14	15	16
17	18	19	20
21	22	23	24

Division: Sharing & Grouping Task Cards: Answer Key

Grade 3 · Medium

The answers online

1. 6	**2.** 3	**3.** 7
4. 4	**5.** 3	**6.** 2
7. 2	**8.** 7	**9.** 5
10. 4	**11.** 3	**12.** 7
13. 5	**14.** 6	**15.** 3
16. 6	**17.** 6	**18.** 2
19. 6	**20.** 7	**21.** 7
22. 7	**23.** 3	**24.** 6