Division: Sharing & Grouping · 1

Share 6 stickers equally among 3 baskets. How many stickers does each get?



Division: Sharing & Grouping · 2

There are 8 stickers. They are put into bowls with 2 in each. How many bowls are filled?



Division: Sharing & Grouping · 3

This array shows 12 stars in 3 equal rows. 12 ÷ 3 = ___



Division: Sharing & Grouping · 4

How many groups of 2 are in 8?

Division: Sharing & Grouping · 5

Share 8 balloons equally among 4 plates. How many balloons does each get?



Division: Sharing & Grouping · 6

There are 12 hearts. They are put into boxes with 3 in each. How many boxes are filled?



Division: Sharing & Grouping · 7

This array shows 8 stars in 4 equal rows. 8 ÷ 4 = ___



Division: Sharing & Grouping · 8

8 ÷ 2 = ___

Division: Sharing & Grouping · 2

ANSWER

4

Division: Sharing & Grouping · 1

ANSWER

2

Division: Sharing & Grouping · 4

ANSWER

4

Division: Sharing & Grouping · 3

ANSWER

4

Division: Sharing & Grouping · 6

ANSWER

4

Division: Sharing & Grouping · 5

ANSWER

2

Division: Sharing & Grouping · 8

ANSWER

4

Division: Sharing & Grouping · 7

ANSWER

2

Division: Sharing & Grouping · 9

Share 8 hearts equally among 2 tables. How many hearts does each get?



Division: Sharing & Grouping · 10

There are 10 balloons. They are put into bags with 2 in each. How many bags are filled?



Division: Sharing & Grouping · 11

This array shows 10 stars in 5 equal rows. 10 ÷ 5 = ___



Division: Sharing & Grouping · 12

How many groups of 4 are in 12?

Division: Sharing & Grouping · 13

Share 6 apples equally among 3 friends. How many apples does each get?



Division: Sharing & Grouping · 14

There are 12 apples. They are put into boxes with 3 in each. How many boxes are filled?



Division: Sharing & Grouping · 15

6 ÷ 3 = ___

Division: Sharing & Grouping · 16

Share 9 marbles equally among 3 plates. How many marbles does each get?



Division: Sharing & Grouping · 10

ANSWER

5

Division: Sharing & Grouping · 9

ANSWER

4

Division: Sharing & Grouping · 12

ANSWER

3

Division: Sharing & Grouping · 11

ANSWER

2

Division: Sharing & Grouping · 14

ANSWER

4

Division: Sharing & Grouping · 13

ANSWER

2

Division: Sharing & Grouping · 16

ANSWER

3

Division: Sharing & Grouping · 15

ANSWER

2

Division: Sharing & Grouping · 17

There are 18 stickers. They are put into boxes with 3 in each. How many boxes are filled?



Division: Sharing & Grouping · 18

This array shows 25 stars in 5 equal rows. 25 ÷ 5 = ___



Division: Sharing & Grouping · 19

How many groups of 5 are in 30?

Division: Sharing & Grouping · 20

Share 10 stickers equally among 5 plates. How many stickers does each get?



Division: Sharing & Grouping · 21

There are 24 marbles. They are put into bags with 6 in each. How many bags are filled?



Division: Sharing & Grouping · 22

This array shows 9 stars in 3 equal rows. 9 ÷ 3 = ___



Division: Sharing & Grouping · 23

30 ÷ 5 = ___

Division: Sharing & Grouping · 24

There are 12 stickers. They are put into boxes with 4 in each. How many boxes are filled?



Division: Sharing & Grouping · 18

ANSWER

5

Division: Sharing & Grouping · 17

ANSWER

6

Division: Sharing & Grouping · 20

ANSWER

2

Division: Sharing & Grouping · 19

ANSWER

6

Division: Sharing & Grouping · 22

ANSWER

3

Division: Sharing & Grouping · 21

ANSWER

4

Division: Sharing & Grouping · 24

ANSWER

3

Division: Sharing & Grouping · 23

ANSWER

6