Task card 1 Data & Graphing

Use the bar graph. What is the difference between spring and summer?

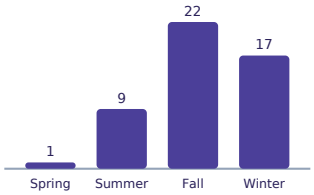

Task card 2 Data & Graphing

Use the bar graph. What is the difference between yellow and red?

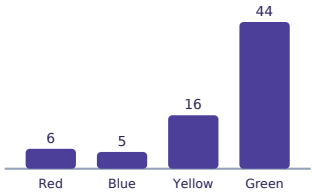

Task card 3 Data & Graphing

Use the bar graph. Which category has the greatest amount?

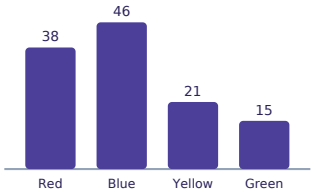

Task card 4 Data & Graphing

Use the bar graph. What is the total?

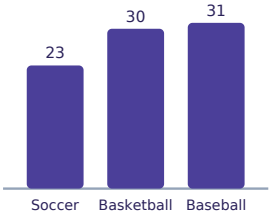

Task card 5 Data & Graphing

Use the bar graph. What is the total?

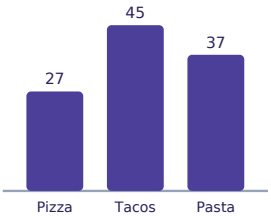

Task card 6 Data & Graphing

Use the bar graph. What is the total?

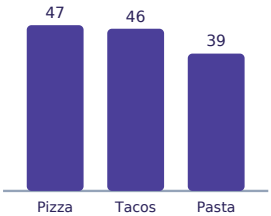

Task card 7 Data & Graphing

Use the bar graph. Which category has the least amount?

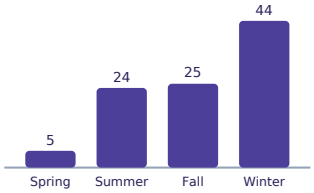

Task card 8 Data & Graphing

Use the bar graph. What is the total?

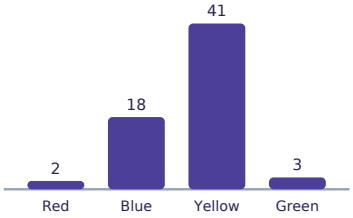

Task card 9 Data & Graphing

Use the bar graph. What is the total?

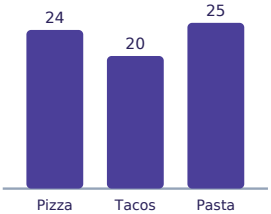

Task card 10 Data & Graphing

Use the bar graph. What is the difference between red and blue?

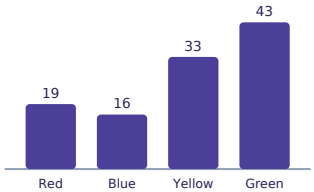

Task card 11 Data & Graphing

Use the bar graph. What is the total?

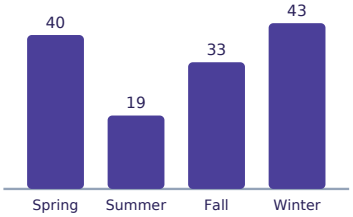

Task card 12 Data & Graphing

Use the bar graph. Which category has the least amount?

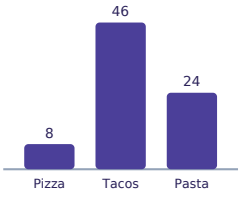

Task card 13 Data & Graphing

Use the bar graph. What is the total?

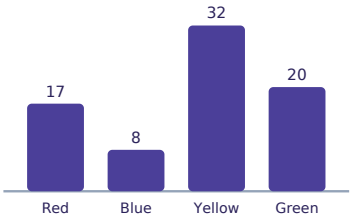

Task card 14 Data & Graphing

Use the bar graph. What is the difference between tacos and pasta?

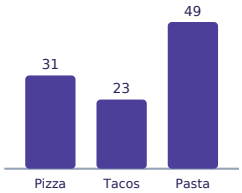

Task card 15 Data & Graphing

Use the bar graph. What is the total?

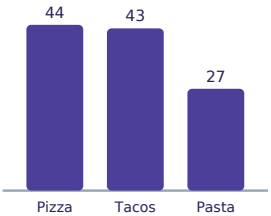

Task card 16 Data & Graphing

Use the bar graph. What is the total?

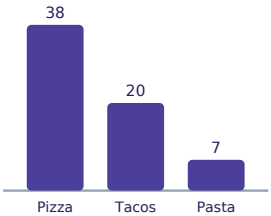

Task card 17 Data & Graphing

Use the bar graph. What is the total?

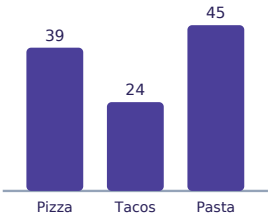

Task card 18 Data & Graphing

Use the bar graph. What is the total?

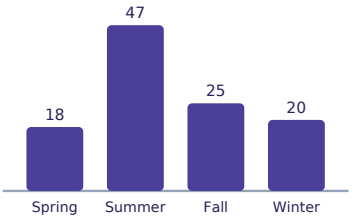

Task card 19 Data & Graphing

Use the bar graph. What is the difference between pizza and pasta?

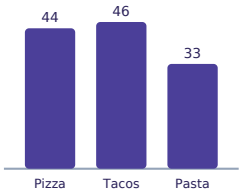

Task card 20 Data & Graphing

Use the bar graph. Which category has the greatest amount?

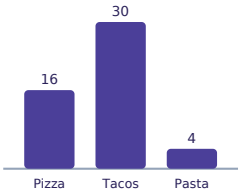

Task card 21 Data & Graphing

Use the bar graph. What is the total?

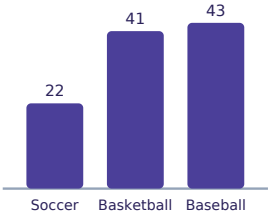

Task card 22 Data & Graphing

Use the bar graph. What is the difference between red and yellow?

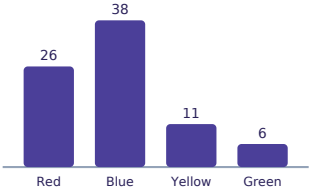

Task card 23 Data & Graphing

Use the bar graph. What is the total?

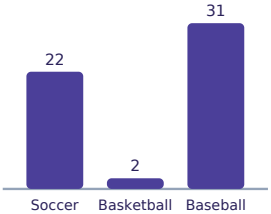

Task card 24 Data & Graphing

Use the bar graph. Which category has the greatest amount?

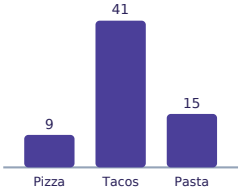

Data & Graphing Task Cards

Recording sheet · Grade 3 · Answer each question about the data.

Name: _____ Date: _____

Scan to check your answers

1	2	3	4
5	6	7	8
9	10	11	12
13	14	15	16
17	18	19	20
21	22	23	24

Data & Graphing Task Cards: Answer Key

Grade 3 · Hard

The answers online

1. 8	**2.** 10	**3.** blue
4. 84	**5.** 109	**6.** 132
7. spring	**8.** 64	**9.** 69
10. 3	**11.** 135	**12.** pizza
13. 77	**14.** 26	**15.** 114
16. 65	**17.** 108	**18.** 110
19. 11	**20.** tacos	**21.** 106
22. 15	**23.** 55	**24.** tacos