Task card 1 Data & Graphing

Use the bar graph. What is the total?

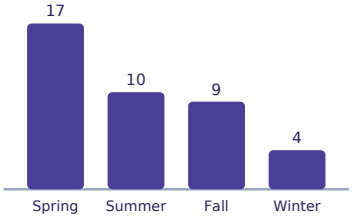

Task card 2 Data & Graphing

Use the bar graph. What is the total?

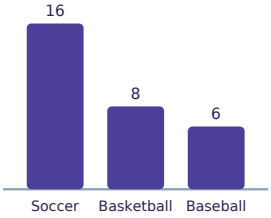

Task card 3 Data & Graphing

Use the bar graph. What is the difference between tacos and pizza?



Task card 4 Data & Graphing

Use the bar graph. What is the difference between basketball and soccer?

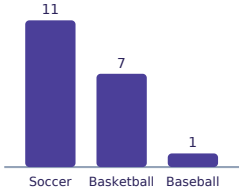

Task card 5 Data & Graphing

Use the bar graph. What is the total?

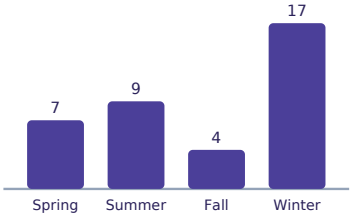

Task card 6 Data & Graphing

Use the bar graph. What is the difference between pizza and pasta?



Task card 7 Data & Graphing

Use the bar graph. Which category has the greatest amount?

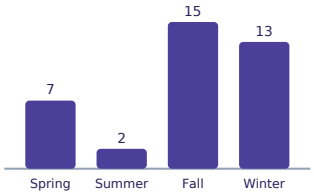

Task card 8 Data & Graphing

Use the bar graph. Which category has the least amount?



Task card 9 Data & Graphing

Use the bar graph. What is the difference between pizza and pasta?

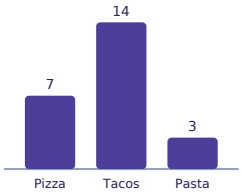

Task card 10 Data & Graphing

Use the bar graph. Which category has the greatest amount?

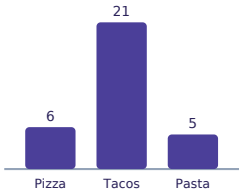

Task card 11 Data & Graphing

Use the bar graph. What is the total?

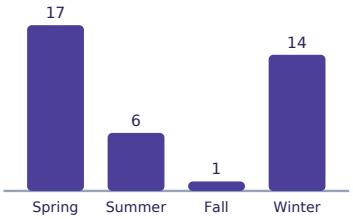

Task card 12 Data & Graphing

Use the bar graph. What is the total?

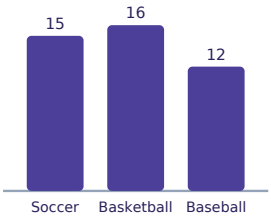

Task card 13 Data & Graphing

Use the bar graph. Which category has the least amount?

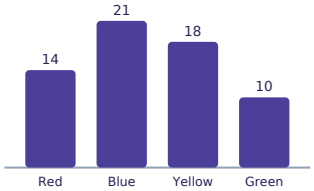

Task card 14 Data & Graphing

Use the bar graph. What is the difference between green and yellow?

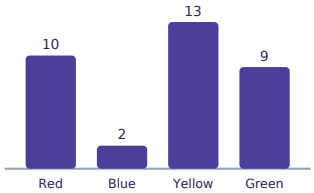

Task card 15 Data & Graphing

Use the bar graph. Which category has the greatest amount?

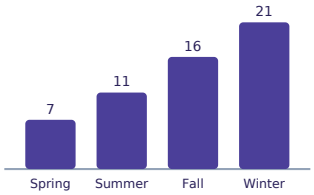

Task card 16 Data & Graphing

Use the bar graph. What is the difference between fall and spring?

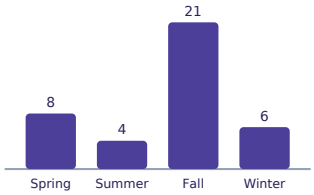

Task card 17 Data & Graphing

Use the bar graph. Which category has the greatest amount?

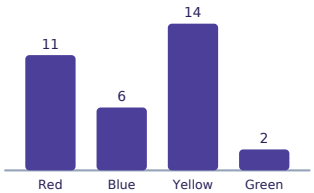

Task card 18 Data & Graphing

Use the bar graph. Which category has the least amount?

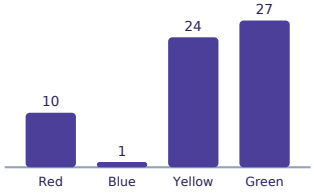

Task card 19 Data & Graphing

Use the bar graph. Which category has the greatest amount?

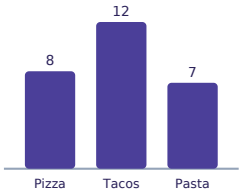

Task card 20 Data & Graphing

Use the bar graph. What is the total?

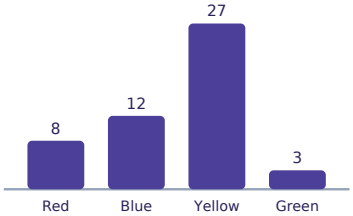

Task card 21 Data & Graphing

Use the bar graph. What is the difference between baseball and basketball?

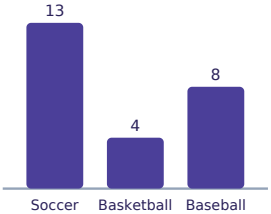

Task card 22 Data & Graphing

Use the bar graph. What is the total?

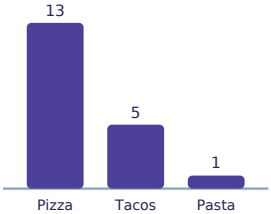

Task card 23 Data & Graphing

Use the bar graph. Which category has the least amount?

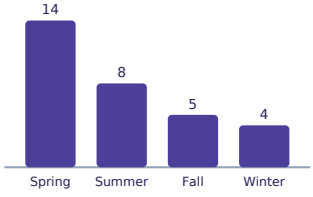

Task card 24 Data & Graphing

Use the bar graph. What is the difference between basketball and baseball?

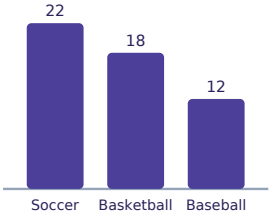

Data & Graphing Task Cards

Recording sheet · Grade 3 · Answer each question about the data.

Name: _____ Date: _____

Scan to check your answers

1	2	3	4
5	6	7	8
9	10	11	12
13	14	15	16
17	18	19	20
21	22	23	24

Data & Graphing Task Cards: Answer Key

Grade 3 · Easy

The answers online

1. 40	**2.** 30	**3.** 4
4. 4	**5.** 37	**6.** 6
7. fall	**8.** pizza	**9.** 4
10. tacos	**11.** 38	**12.** 43
13. green	**14.** 4	**15.** winter
16. 13	**17.** yellow	**18.** blue
19. tacos	**20.** 50	**21.** 4
22. 19	**23.** winter	**24.** 6