Data & Graphing · 1

Use the bar graph. Which category has the greatest amount?

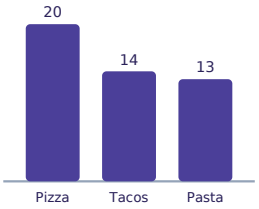

Data & Graphing · 2

Use the bar graph. What is the difference between summer and spring?

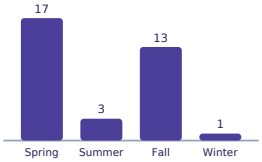

Data & Graphing · 3

Use the bar graph. Which category has the least amount?

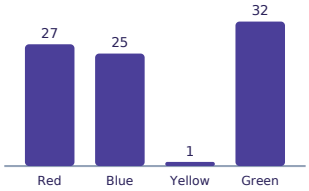

Data & Graphing · 4

Use the bar graph. What is the total?

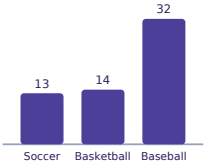

Data & Graphing · 5

Use the bar graph. What is the total?

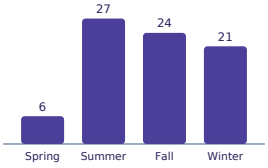

Data & Graphing · 6

Use the bar graph. What is the total?

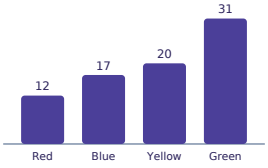

Data & Graphing · 7

Use the bar graph. Which category has the least amount?

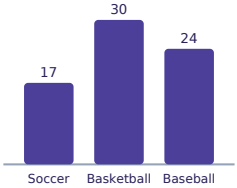

Data & Graphing · 8

Use the bar graph. What is the total?

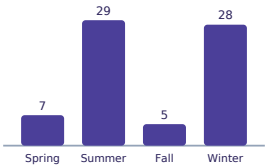

Data & Graphing · 2

ANSWER

14

Data & Graphing · 1

ANSWER

pizza

Data & Graphing · 4

ANSWER

59

Data & Graphing · 3

ANSWER

yellow

Data & Graphing · 6

ANSWER

80

Data & Graphing · 5

ANSWER

78

Data & Graphing · 8

ANSWER

69

Data & Graphing · 7

ANSWER

soccer

Data & Graphing · 9

Use the bar graph. Which category has the greatest amount?

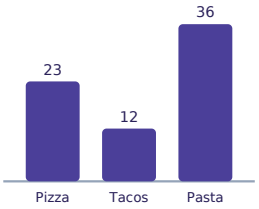

Data & Graphing · 10

Use the bar graph. Which category has the greatest amount?

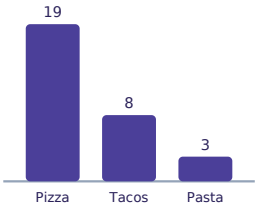

Data & Graphing · 11

Use the bar graph. Which category has the greatest amount?

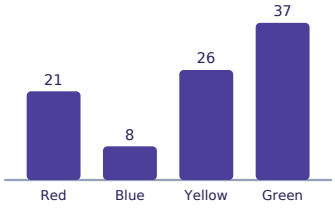

Data & Graphing · 12

Use the bar graph. Which category has the least amount?

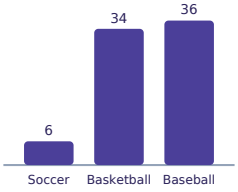

Data & Graphing · 13

Use the bar graph. Which category has the least amount?

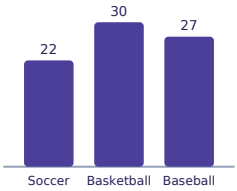

Data & Graphing · 14

Use the bar graph. What is the total?

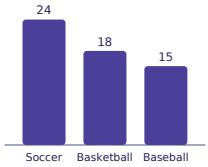

Data & Graphing · 15

Use the bar graph. Which category has the greatest amount?

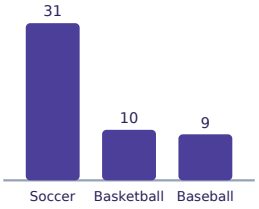

Data & Graphing · 16

Use the bar graph. What is the total?

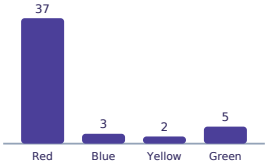

Data & Graphing · 10

ANSWER

pizza

Data & Graphing · 9

ANSWER

pasta

Data & Graphing · 12

ANSWER

soccer

Data & Graphing · 11

ANSWER

green

Data & Graphing · 14

ANSWER

57

Data & Graphing · 13

ANSWER

soccer

Data & Graphing · 16

ANSWER

47

Data & Graphing · 15

ANSWER

soccer

Data & Graphing · 17

Use the bar graph. What is the difference between soccer and basketball?

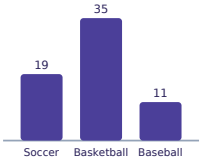

Data & Graphing · 18

Use the bar graph. Which category has the greatest amount?

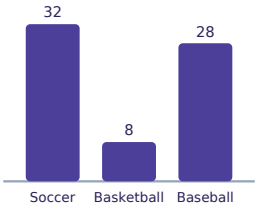

Data & Graphing · 19

Use the bar graph. What is the difference between spring and winter?

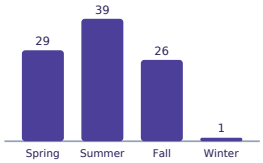

Data & Graphing · 20

Use the bar graph. Which category has the least amount?

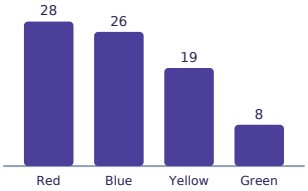

Data & Graphing · 21

Use the bar graph. What is the total?

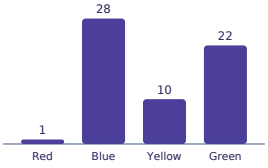

Data & Graphing · 22

Use the bar graph. Which category has the greatest amount?

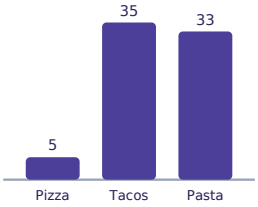

Data & Graphing · 23

Use the bar graph. What is the difference between yellow and green?

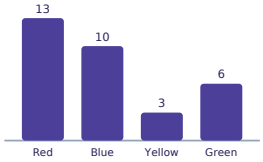

Data & Graphing · 24

Use the bar graph. What is the total?

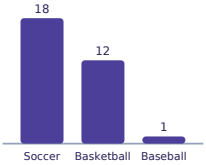

Data & Graphing · 18

ANSWER

soccer

Data & Graphing · 17

ANSWER

16

Data & Graphing · 20

ANSWER

green

Data & Graphing · 19

ANSWER

28

Data & Graphing · 22

ANSWER

tacos

Data & Graphing · 21

ANSWER

61

Data & Graphing · 24

ANSWER

31

Data & Graphing · 23

ANSWER

3