Data & Graphing · 1

## Use the bar graph. What is the total?

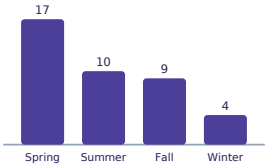


Data & Graphing · 2

## Use the bar graph. What is the total?

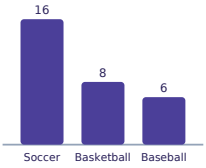


Data & Graphing · 3

Use the bar graph. What is the difference between tacos and pizza?




Data & Graphing · 4

Use the bar graph. What is the difference between basketball and soccer?

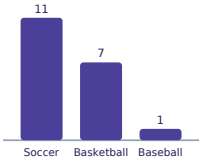


Data & Graphing · 5

## Use the bar graph. What is the total?

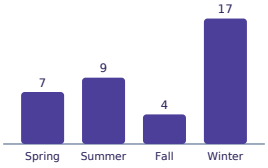


Data & Graphing · 6

Use the bar graph. What is the difference between pizza and pasta?




Data & Graphing · 7

Use the bar graph. Which category has the greatest amount?

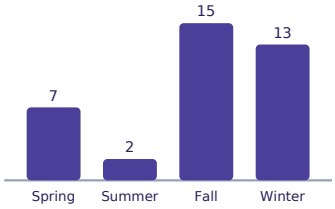


Data & Graphing · 8

Use the bar graph. Which category has the least amount?

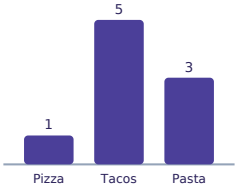

Data & Graphing · 2

**ANSWER**

# 30

Data & Graphing · 1

**ANSWER**

# 40

Data & Graphing · 4

**ANSWER**

# 4

Data & Graphing · 3

**ANSWER**

# 4

Data & Graphing · 6

**ANSWER**

# 6

Data & Graphing · 5

**ANSWER**

# 37

Data & Graphing · 8

**ANSWER**

# pizza

Data & Graphing · 7

**ANSWER**

# fall

Data & Graphing · 9

Use the bar graph. What is the difference between pizza and pasta?

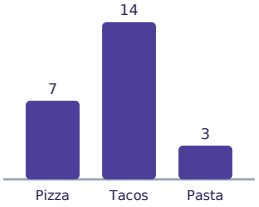


Data & Graphing · 10

Use the bar graph. Which category has the greatest amount?

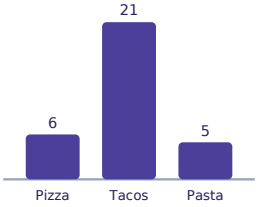


Data & Graphing · 11

Use the bar graph. What is the total?

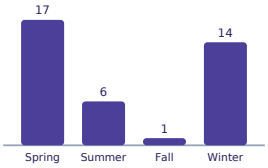


Data & Graphing · 12

Use the bar graph. What is the total?

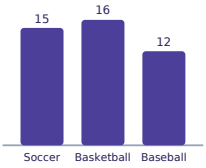


Data & Graphing · 13

Use the bar graph. Which category has the least amount?

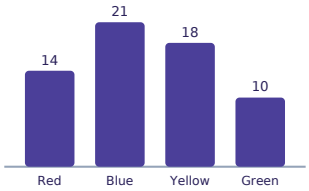


Data & Graphing · 14

Use the bar graph. What is the difference between green and yellow?

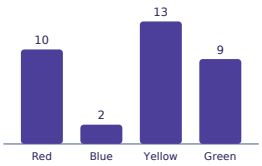


Data & Graphing · 15

Use the bar graph. Which category has the greatest amount?

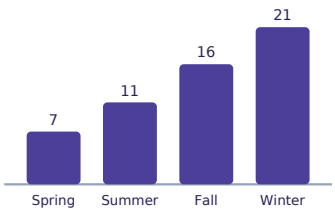


Data & Graphing · 16

Use the bar graph. What is the difference between fall and spring?

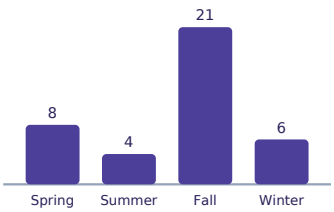

Data & Graphing · 10

**ANSWER**

**tacos**

Data & Graphing · 9

**ANSWER**

**4**

Data & Graphing · 12

**ANSWER**

**43**

Data & Graphing · 11

**ANSWER**

**38**

Data & Graphing · 14

**ANSWER**

**4**

Data & Graphing · 13

**ANSWER**

**green**

Data & Graphing · 16

**ANSWER**

**13**

Data & Graphing · 15

**ANSWER**

**winter**

Data & Graphing · 17

Use the bar graph. Which category has the greatest amount?

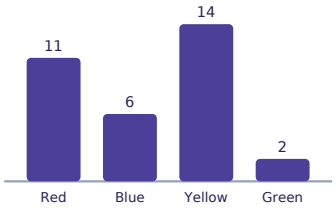


Data & Graphing · 18

Use the bar graph. Which category has the least amount?

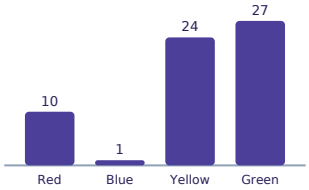


Data & Graphing · 19

Use the bar graph. Which category has the greatest amount?

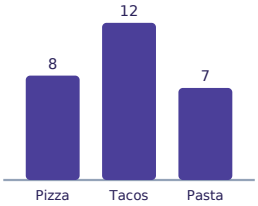


Data & Graphing · 20

Use the bar graph. What is the total?

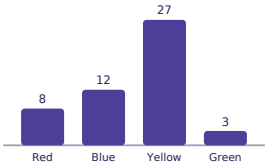


Data & Graphing · 21

Use the bar graph. What is the difference between baseball and basketball?

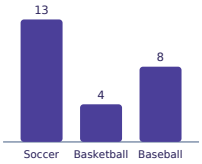


Data & Graphing · 22

Use the bar graph. What is the total?

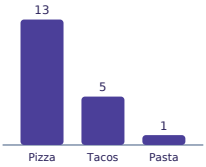


Data & Graphing · 23

Use the bar graph. Which category has the least amount?

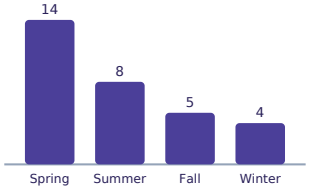


Data & Graphing · 24

Use the bar graph. What is the difference between basketball and baseball?

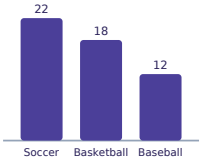

Data & Graphing · 18

**ANSWER**

# blue

Data & Graphing · 17

**ANSWER**

# yellow

Data & Graphing · 20

**ANSWER**

# 50

Data & Graphing · 19

**ANSWER**

# tacos

Data & Graphing · 22

**ANSWER**

# 19

Data & Graphing · 21

**ANSWER**

# 4

Data & Graphing · 24

**ANSWER**

# 6

Data & Graphing · 23

**ANSWER**

# winter