Comparing Fractions with the Same Numerator · 1

$\frac{1}{5}$ ___ $\frac{1}{2}$

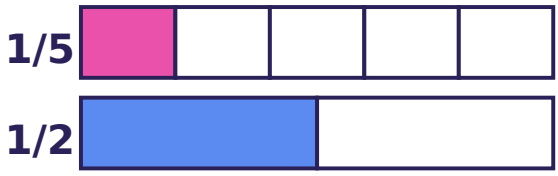

Comparing Fractions with the Same Numerator · 2

$\frac{1}{6}$ ___ $\frac{1}{4}$

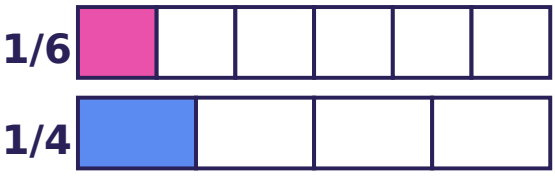

Comparing Fractions with the Same Numerator · 3

$\frac{1}{4}$ ___ $\frac{1}{5}$

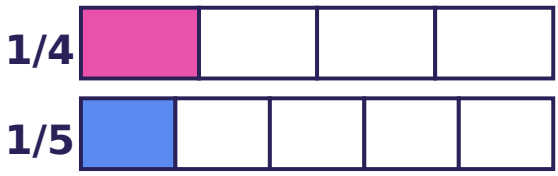

Comparing Fractions with the Same Numerator · 4

Each bar shows a fraction. Write the fraction that is greater.

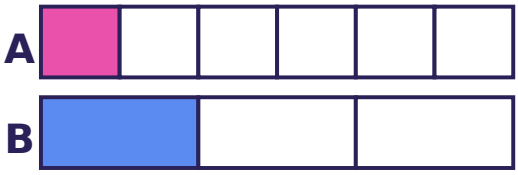

Comparing Fractions with the Same Numerator · 5

Which fraction is greater: $\frac{1}{6}$ or $\frac{1}{3}$?

Comparing Fractions with the Same Numerator · 6

Is $\frac{1}{5}$ greater than $\frac{1}{3}$? Write yes or no.

Comparing Fractions with the Same Numerator · 7

Rope A is $\frac{1}{5}$ m long and rope B is $\frac{1}{2}$ m long. How many meters long is the longer rope?

Comparing Fractions with the Same Numerator · 8

$\frac{1}{6} < \frac{1}{__} < \frac{1}{4}$. What number goes in the blank?

Comparing Fractions with the Same Numerator · 2

ANSWER

<

Comparing Fractions with the Same Numerator · 1

ANSWER

<

Comparing Fractions with the Same Numerator · 4

ANSWER

$\frac{1}{3}$

Comparing Fractions with the Same Numerator · 3

ANSWER

>

Comparing Fractions with the Same Numerator · 6

ANSWER

no

Comparing Fractions with the Same Numerator · 5

ANSWER

$\frac{1}{3}$

Comparing Fractions with the Same Numerator · 8

ANSWER

5

Comparing Fractions with the Same Numerator · 7

ANSWER

$\frac{1}{2}$

Comparing Fractions with the Same Numerator · 9

$\frac{1}{4}$ ___ $\frac{1}{6}$

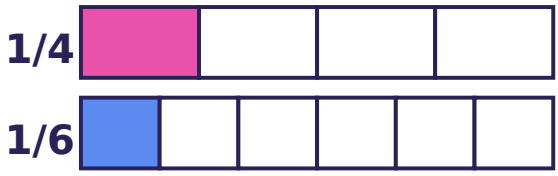

Comparing Fractions with the Same Numerator · 10

$\frac{1}{5}$ ___ $\frac{1}{10}$

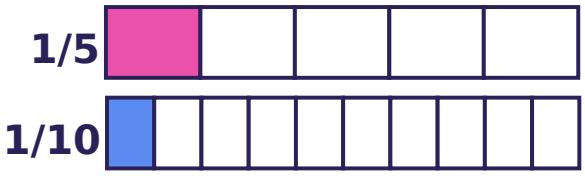

Comparing Fractions with the Same Numerator · 11

$\frac{1}{6}$ ___ $\frac{1}{10}$

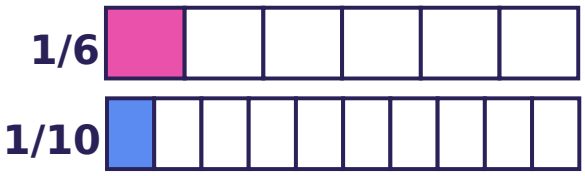

Comparing Fractions with the Same Numerator · 12

Each bar shows a fraction. Write the fraction that is greater.

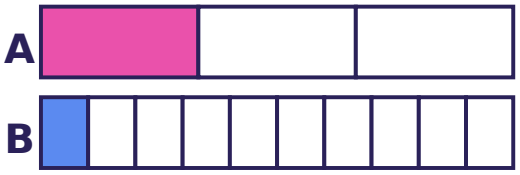

Comparing Fractions with the Same Numerator · 13

Which fraction is greater: $\frac{1}{2}$ or $\frac{1}{10}$?

Comparing Fractions with the Same Numerator · 14

Is $\frac{1}{6}$ greater than $\frac{1}{10}$? Write yes or no.

Comparing Fractions with the Same Numerator · 15

Rope A is $\frac{1}{6}$ m long and rope B is $\frac{1}{2}$ m long. How many meters long is the shorter rope?

Comparing Fractions with the Same Numerator · 16

$\frac{1}{4} < \frac{1}{__} < \frac{1}{2}$. What number goes in the blank?

Comparing Fractions with the Same Numerator · 10

ANSWER

$>$

Comparing Fractions with the Same Numerator · 9

ANSWER

$>$

Comparing Fractions with the Same Numerator · 12

ANSWER

$\frac{1}{3}$

Comparing Fractions with the Same Numerator · 11

ANSWER

$>$

Comparing Fractions with the Same Numerator · 14

ANSWER

yes

Comparing Fractions with the Same Numerator · 13

ANSWER

$\frac{1}{2}$

Comparing Fractions with the Same Numerator · 16

ANSWER

3

Comparing Fractions with the Same Numerator · 15

ANSWER

$\frac{1}{6}$

Comparing Fractions with the Same Numerator · 17

$\frac{2}{3}$ ___ $\frac{2}{4}$

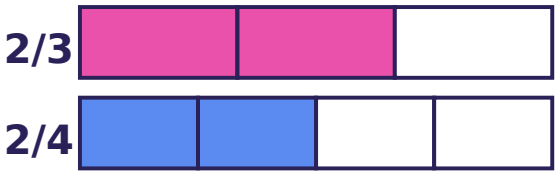

Comparing Fractions with the Same Numerator · 18

$\frac{2}{4}$ ___ $\frac{2}{8}$

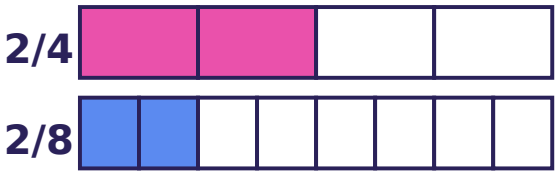

Comparing Fractions with the Same Numerator · 19

$\frac{2}{8}$ ___ $\frac{2}{5}$

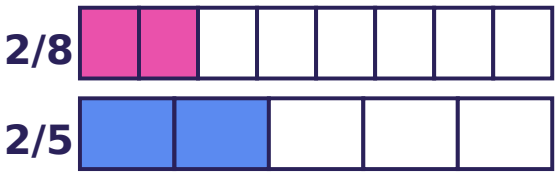

Comparing Fractions with the Same Numerator · 20

Each bar shows a fraction. Write the fraction that is greater.

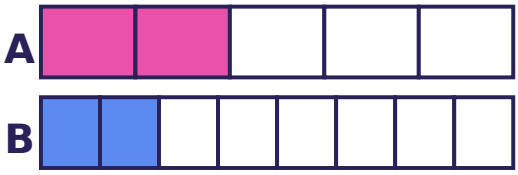

Comparing Fractions with the Same Numerator · 21

Which fraction is greater: $\frac{3}{4}$ or $\frac{3}{8}$?

Comparing Fractions with the Same Numerator · 22

Is $\frac{3}{4}$ greater than $\frac{3}{6}$? Write yes or no.

Comparing Fractions with the Same Numerator · 23

Rope A is $\frac{2}{6}$ m long and rope B is $\frac{2}{3}$ m long. How many meters long is the longer rope?

Comparing Fractions with the Same Numerator · 24

$\frac{2}{5} < \frac{2}{__} < \frac{2}{3}$. What number goes in the blank?

Comparing Fractions with the Same Numerator · 18

ANSWER

$>$

Comparing Fractions with the Same Numerator · 17

ANSWER

$>$

Comparing Fractions with the Same Numerator · 20

ANSWER

$\frac{2}{5}$

Comparing Fractions with the Same Numerator · 19

ANSWER

$<$

Comparing Fractions with the Same Numerator · 22

ANSWER

yes

Comparing Fractions with the Same Numerator · 21

ANSWER

$\frac{3}{4}$

Comparing Fractions with the Same Numerator · 24

ANSWER

4

Comparing Fractions with the Same Numerator · 23

ANSWER

$\frac{2}{3}$