Task card 1 Comparing Fractions with the Same...

$\frac{2}{8}$ ___ $\frac{2}{8}$

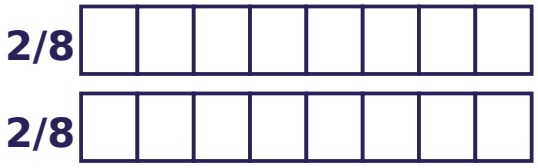

Task card 2 Comparing Fractions with the Same...

$\frac{3}{10}$ ___ $\frac{6}{10}$

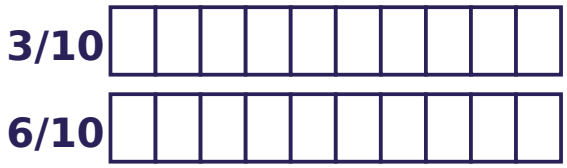

Task card 3 Comparing Fractions with the Same...

$\frac{9}{10}$ ___ $\frac{4}{10}$

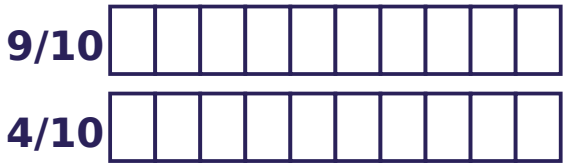

Task card 4 Comparing Fractions with the Same...

Each bar shows a fraction. Write the fraction that is greater.

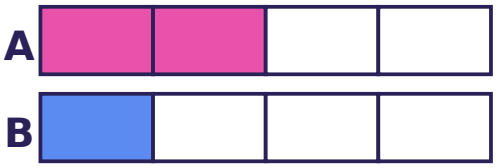

Task card 5 Comparing Fractions with the Same...

Which fraction is greater: $\frac{1}{4}$ or $\frac{3}{4}$?

Task card 6 Comparing Fractions with the Same...

Is $\frac{1}{6}$ less than $\frac{5}{6}$? Write yes or no.

Task card 7 Comparing Fractions with the Same...

Rope A is $\frac{2}{4}$ m long and rope B is $\frac{3}{4}$ m long. How many meters long is the longer rope?

Task card 8 Comparing Fractions with the Same...

$\frac{6}{10} < \frac{__}{10} < \frac{8}{10}$. What number goes in the blank?

Task card 9 Comparing Fractions with the Same...

$\frac{3}{8} ___ \frac{3}{8}$

Task card 10 Comparing Fractions with the Same...

$\frac{1}{10} ___ \frac{5}{10}$

Task card 11 Comparing Fractions with the Same...

$\frac{4}{6} ___ \frac{1}{6}$

Task card 12 Comparing Fractions with the Same...

Which fraction is the greatest: $\frac{1}{5}$, $\frac{4}{5}$ or $\frac{3}{5}$?

Task card 13 Comparing Fractions with the Same...

Which fraction is greater: $\frac{5}{6}$ or $\frac{3}{6}$?

Task card 14 Comparing Fractions with the Same...

Is $\frac{4}{9}$ less than $\frac{8}{9}$? Write yes or no.

Task card 15 Comparing Fractions with the Same...

Rope A is $\frac{5}{7}$ m long and rope B is $\frac{2}{7}$ m long. How many meters long is the shorter rope?

Task card 16 Comparing Fractions with the Same...

$\frac{2}{7} < \frac{__}{7} < \frac{4}{7}$. What number goes in the blank?

Task card 17 Comparing Fractions with the Same...

$\frac{7}{8} ___ \frac{2}{8}$

Task card 18 Comparing Fractions with the Same...

$\frac{1}{12} ___ \frac{11}{12}$

Task card 19 Comparing Fractions with the Same...

$\frac{9}{12}$ ___ $\frac{4}{12}$

Task card 20 Comparing Fractions with the Same...

Which fraction is the greatest: $\frac{4}{6}$, $\frac{3}{6}$ or $\frac{5}{6}$?

Task card 21 Comparing Fractions with the Same...

Which fraction is greater: $\frac{4}{4}$ or $\frac{1}{4}$?

Task card 22 Comparing Fractions with the Same...

Is $\frac{1}{4}$ greater than $\frac{3}{4}$? Write yes or no.

Task card 23 Comparing Fractions with the Same...

Rope A is $\frac{2}{4}$ m long and rope B is $\frac{1}{4}$ m long. How many meters long is the longer rope?

Task card 24 Comparing Fractions with the Same...

$\frac{1}{3} < \frac{__}{3} < \frac{3}{3}$. What number goes in the blank?

Comparing Fractions with the Same Denominator Task Cards

Recording sheet · Grade 3 · Compare the fractions. Write <, > or =, or answer the question.

Scan to check your answers

Name: _____ Date: _____

1	2	3	4
5	6	7	8
9	10	11	12
13	14	15	16
17	18	19	20
21	22	23	24

Comparing Fractions with the Same Denominator Task Cards: Answer Key

Grade 3 · Medium

The answers online

1. =	**2.** <	**3.** >
4. $\frac{2}{4}$	**5.** $\frac{3}{4}$	**6.** yes
7. $\frac{3}{4}$	**8.** 7	**9.** =
10. <	**11.** >	**12.** $\frac{4}{5}$
13. $\frac{5}{6}$	**14.** yes	**15.** $\frac{2}{7}$
16. 3	**17.** >	**18.** <
19. >	**20.** $\frac{5}{6}$	**21.** $\frac{4}{4}$
22. no	**23.** $\frac{2}{4}$	**24.** 2