Task card 1 Comparing Fractions with the Same...

$\frac{2}{5}$ ___ $\frac{4}{5}$

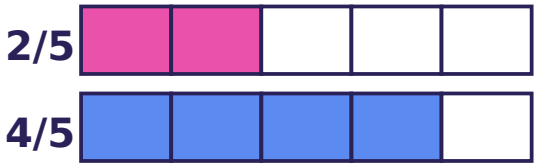

Task card 2 Comparing Fractions with the Same...

$\frac{2}{3}$ ___ $\frac{1}{3}$

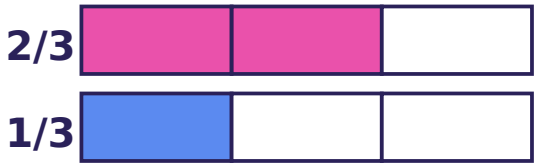

Task card 3 Comparing Fractions with the Same...

$\frac{2}{4}$ ___ $\frac{3}{4}$

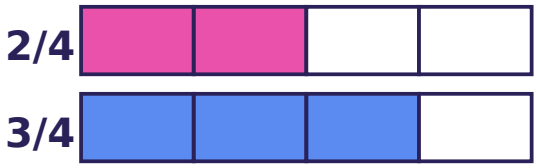

Task card 4 Comparing Fractions with the Same...

Each bar shows a fraction. Write the fraction that is greater.

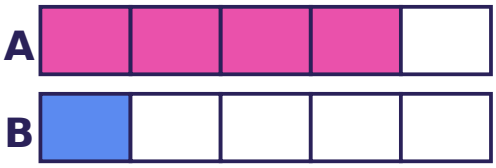

Task card 5 Comparing Fractions with the Same...

Which fraction is greater: $\frac{3}{4}$ or $\frac{1}{4}$?

Task card 6 Comparing Fractions with the Same...

Is $\frac{1}{5}$ less than $\frac{3}{5}$? Write yes or no.

Task card 7 Comparing Fractions with the Same...

Rope A is $\frac{2}{4}$ m long and rope B is $\frac{3}{4}$ m long. How many meters long is the shorter rope?

Task card 8 Comparing Fractions with the Same...

$\frac{1}{5} < \frac{__}{5} < \frac{3}{5}$. What number goes in the blank?

Task card 9 Comparing Fractions with the Same...

$\frac{4}{5} ___ \frac{1}{5}$

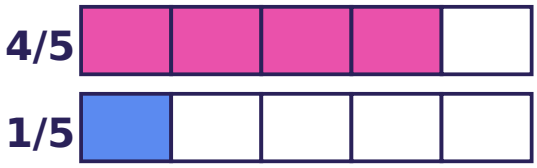

Task card 10 Comparing Fractions with the Same...

$\frac{1}{4} ___ \frac{2}{4}$

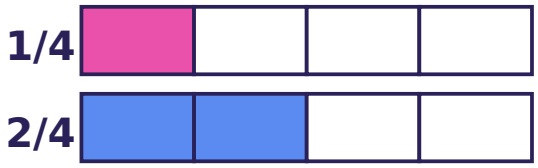

Task card 11 Comparing Fractions with the Same...

$\frac{3}{4} ___ \frac{1}{4}$

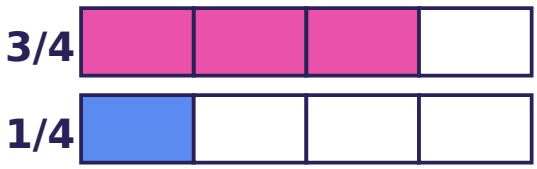

Task card 12 Comparing Fractions with the Same...

Each bar shows a fraction. Write the fraction that is greater.

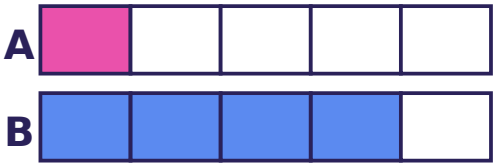

Task card 13 Comparing Fractions with the Same...

Which fraction is less: $\frac{3}{5}$ or $\frac{2}{5}$?

Task card 14 Comparing Fractions with the Same...

Is $\frac{3}{4}$ greater than $\frac{1}{4}$? Write yes or no.

Task card 15 Comparing Fractions with the Same...

Rope A is $\frac{4}{6}$ m long and rope B is $\frac{5}{6}$ m long. How many meters long is the shorter rope?

Task card 16 Comparing Fractions with the Same...

$\frac{2}{5} < \frac{__}{5} < \frac{4}{5}$. What number goes in the blank?

Task card 17 Comparing Fractions with the Same...

$\frac{3}{6}$ ___ $\frac{4}{6}$

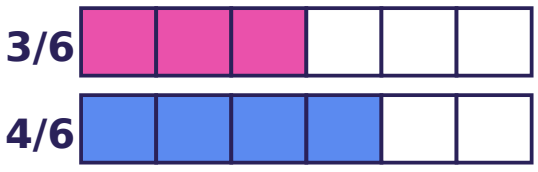

Task card 18 Comparing Fractions with the Same...

$\frac{2}{5}$ ___ $\frac{2}{5}$

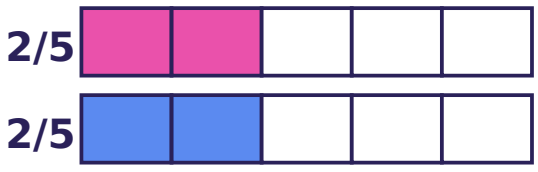

Task card 19 Comparing Fractions with the Same...

$\frac{5}{6}$ ___ $\frac{1}{6}$

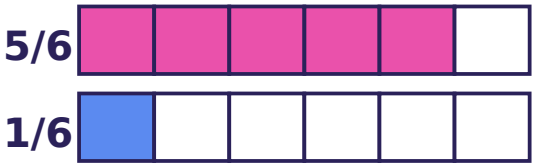

Task card 20 Comparing Fractions with the Same...

Each bar shows a fraction. Write the fraction that is greater.

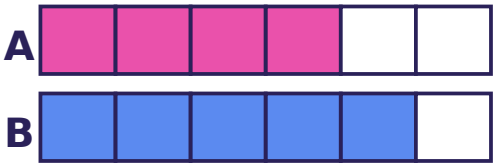

Task card 21 Comparing Fractions with the Same...

Which fraction is less: $\frac{5}{8}$ or $\frac{3}{8}$?

Task card 22 Comparing Fractions with the Same...

Is $\frac{2}{5}$ greater than $\frac{4}{5}$? Write yes or no.

Task card 23 Comparing Fractions with the Same...

Rope A is $\frac{7}{8}$ m long and rope B is $\frac{3}{8}$ m long. How many meters long is the longer rope?

Task card 24 Comparing Fractions with the Same...

$\frac{1}{5}$ ___ $\frac{4}{5}$



Comparing Fractions with the Same Denominator Task Cards

Recording sheet · Grade 3 · Compare the fractions. Write <, > or =, or answer the question.

Scan to check your answers

Name: _____ Date: _____

1	2	3	4
5	6	7	8
9	10	11	12
13	14	15	16
17	18	19	20
21	22	23	24

Comparing Fractions with the Same Denominator Task Cards: Answer Key

Grade 3 · Easy

The answers online

1. <	**2.** >	**3.** <
4. $\frac{4}{5}$	**5.** $\frac{3}{4}$	**6.** yes
7. $\frac{2}{4}$	**8.** 2	**9.** >
10. <	**11.** >	**12.** $\frac{4}{5}$
13. $\frac{2}{5}$	**14.** yes	**15.** $\frac{4}{6}$
16. 3	**17.** <	**18.** =
19. >	**20.** $\frac{5}{6}$	**21.** $\frac{3}{8}$
22. no	**23.** $\frac{7}{8}$	**24.** <