Comparing Fractions with the Same Denominator · 1

$\frac{2}{8}$ ___ $\frac{2}{8}$

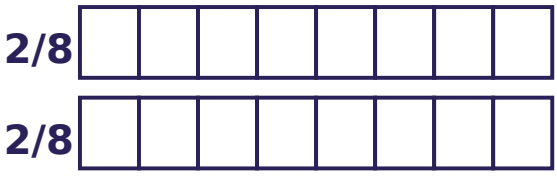

Comparing Fractions with the Same Denominator · 2

$\frac{3}{10}$ ___ $\frac{6}{10}$

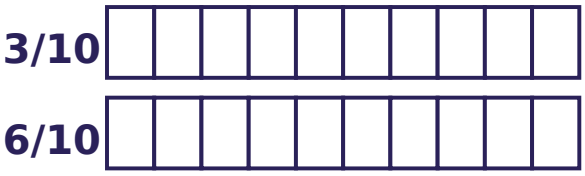

Comparing Fractions with the Same Denominator · 3

$\frac{9}{10}$ ___ $\frac{4}{10}$

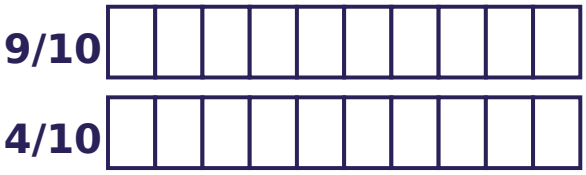

Comparing Fractions with the Same Denominator · 4

Each bar shows a fraction. Write the fraction that is greater.

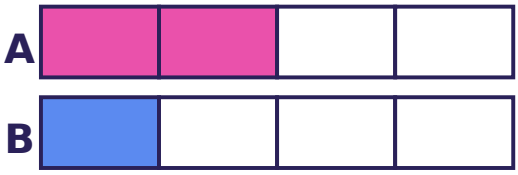

Comparing Fractions with the Same Denominator · 5

Which fraction is greater: $\frac{1}{4}$ or $\frac{3}{4}$?

Comparing Fractions with the Same Denominator · 6

Is $\frac{1}{6}$ less than $\frac{5}{6}$? Write yes or no.

Comparing Fractions with the Same Denominator · 7

Rope A is $\frac{2}{4}$ m long and rope B is $\frac{3}{4}$ m long. How many meters long is the longer rope?

Comparing Fractions with the Same Denominator · 8

$\frac{6}{10} < \frac{__}{10} < \frac{8}{10}$. What number goes in the blank?

Comparing Fractions with the Same Denominator · 2

ANSWER

<

Comparing Fractions with the Same Denominator · 1

ANSWER

=

Comparing Fractions with the Same Denominator · 4

ANSWER

$\frac{2}{4}$

Comparing Fractions with the Same Denominator · 3

ANSWER

>

Comparing Fractions with the Same Denominator · 6

ANSWER

yes

Comparing Fractions with the Same Denominator · 5

ANSWER

$\frac{3}{4}$

Comparing Fractions with the Same Denominator · 8

ANSWER

7

Comparing Fractions with the Same Denominator · 7

ANSWER

$\frac{3}{4}$

$\frac{3}{8}$ ___ $\frac{3}{8}$

$\frac{1}{10}$ ___ $\frac{5}{10}$

$\frac{4}{6}$ ___ $\frac{1}{6}$

Which fraction is the greatest: $\frac{1}{5}$, $\frac{4}{5}$ or $\frac{3}{5}$?

Which fraction is greater: $\frac{5}{6}$ or $\frac{3}{6}$?

Is $\frac{4}{9}$ less than $\frac{8}{9}$? Write yes or no.

Rope A is $\frac{5}{7}$ m long and rope B is $\frac{2}{7}$ m long. How many meters long is the shorter rope?

$\frac{2}{7} < \frac{__}{7} < \frac{4}{7}$. What number goes in the blank?

Comparing Fractions with the Same Denominator · 10

ANSWER

$<$

Comparing Fractions with the Same Denominator · 9

ANSWER

$=$

Comparing Fractions with the Same Denominator · 12

ANSWER

$\frac{4}{5}$

Comparing Fractions with the Same Denominator · 11

ANSWER

$>$

Comparing Fractions with the Same Denominator · 14

ANSWER

yes

Comparing Fractions with the Same Denominator · 13

ANSWER

$\frac{5}{6}$

Comparing Fractions with the Same Denominator · 16

ANSWER

3

Comparing Fractions with the Same Denominator · 15

ANSWER

$\frac{2}{7}$

$\frac{7}{8}$ ___ $\frac{2}{8}$

$\frac{1}{12}$ ___ $\frac{11}{12}$

$\frac{9}{12}$ ___ $\frac{4}{12}$

Which fraction is the greatest: $\frac{4}{6}$, $\frac{3}{6}$ or $\frac{5}{6}$?

Which fraction is greater: $\frac{4}{4}$ or $\frac{1}{4}$?

Is $\frac{1}{4}$ greater than $\frac{3}{4}$? Write yes or no.

Rope A is $\frac{2}{4}$ m long and rope B is $\frac{1}{4}$ m long. How many meters long is the longer rope?

$\frac{1}{3} < \frac{__}{3} < \frac{3}{3}$. What number goes in the blank?

Comparing Fractions with the Same Denominator · 18

ANSWER

$<$

Comparing Fractions with the Same Denominator · 17

ANSWER

$>$

Comparing Fractions with the Same Denominator · 20

ANSWER

$\frac{5}{6}$

Comparing Fractions with the Same Denominator · 19

ANSWER

$>$

Comparing Fractions with the Same Denominator · 22

ANSWER

no

Comparing Fractions with the Same Denominator · 21

ANSWER

$\frac{4}{4}$

Comparing Fractions with the Same Denominator · 24

ANSWER

2

Comparing Fractions with the Same Denominator · 23

ANSWER

$\frac{2}{4}$