Comparing Fractions with the Same Denominator · 1

$\frac{2}{5}$ ___ $\frac{4}{5}$

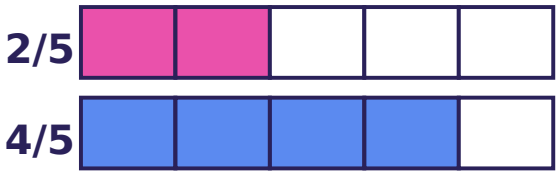

Comparing Fractions with the Same Denominator · 2

$\frac{2}{3}$ ___ $\frac{1}{3}$

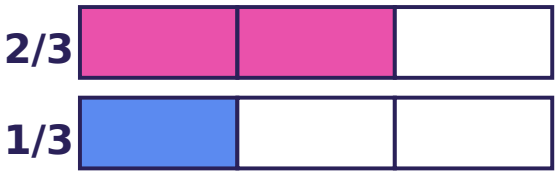

Comparing Fractions with the Same Denominator · 3

$\frac{2}{4}$ ___ $\frac{3}{4}$

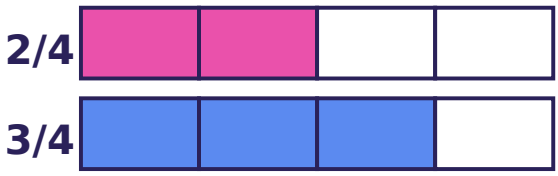

Comparing Fractions with the Same Denominator · 4

Each bar shows a fraction. Write the fraction that is greater.

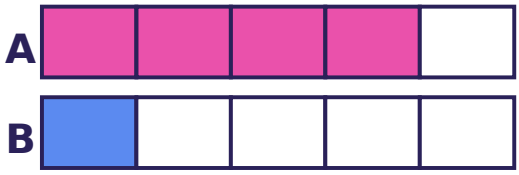

Comparing Fractions with the Same Denominator · 5

Which fraction is greater: $\frac{3}{4}$ or $\frac{1}{4}$?

Comparing Fractions with the Same Denominator · 6

Is $\frac{1}{5}$ less than $\frac{3}{5}$? Write yes or no.

Comparing Fractions with the Same Denominator · 7

Rope A is $\frac{2}{4}$ m long and rope B is $\frac{3}{4}$ m long. How many meters long is the shorter rope?

Comparing Fractions with the Same Denominator · 8

$\frac{1}{5} < \frac{__}{5} < \frac{3}{5}$. What number goes in the blank?

Comparing Fractions with the Same Denominator · 2

ANSWER

>

Comparing Fractions with the Same Denominator · 1

ANSWER

<

Comparing Fractions with the Same Denominator · 4

ANSWER

$$\frac{4}{5}$$

Comparing Fractions with the Same Denominator · 3

ANSWER

<

Comparing Fractions with the Same Denominator · 6

ANSWER

yes

Comparing Fractions with the Same Denominator · 5

ANSWER

$$\frac{3}{4}$$

Comparing Fractions with the Same Denominator · 8

ANSWER

2

Comparing Fractions with the Same Denominator · 7

ANSWER

$$\frac{2}{4}$$

Comparing Fractions with the Same Denominator · 9

$\frac{4}{5}$ ___ $\frac{1}{5}$

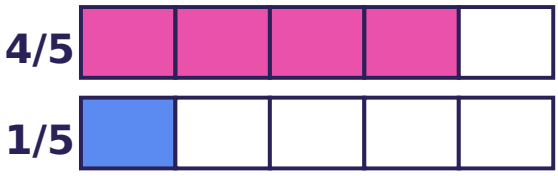

Comparing Fractions with the Same Denominator · 10

$\frac{1}{4}$ ___ $\frac{2}{4}$

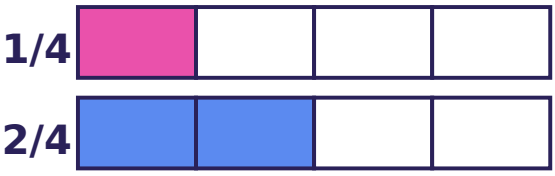

Comparing Fractions with the Same Denominator · 11

$\frac{3}{4}$ ___ $\frac{1}{4}$

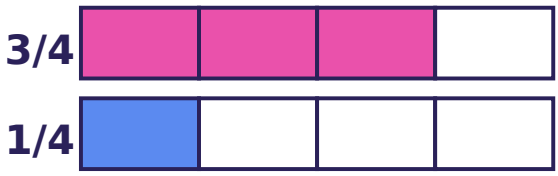

Comparing Fractions with the Same Denominator · 12

Each bar shows a fraction. Write the fraction that is greater.

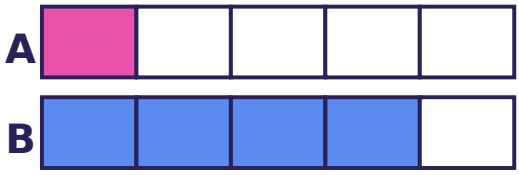

Comparing Fractions with the Same Denominator · 13

Which fraction is less: $\frac{3}{5}$ or $\frac{2}{5}$?

Comparing Fractions with the Same Denominator · 14

Is $\frac{3}{4}$ greater than $\frac{1}{4}$? Write yes or no.

Comparing Fractions with the Same Denominator · 15

Rope A is $\frac{4}{6}$ m long and rope B is $\frac{5}{6}$ m long. How many meters long is the shorter rope?

Comparing Fractions with the Same Denominator · 16

$\frac{2}{5} < \frac{__}{5} < \frac{4}{5}$. What number goes in the blank?

Comparing Fractions with the Same Denominator · 10

ANSWER

$<$

Comparing Fractions with the Same Denominator · 9

ANSWER

$>$

Comparing Fractions with the Same Denominator · 12

ANSWER

$\frac{4}{5}$

Comparing Fractions with the Same Denominator · 11

ANSWER

$>$

Comparing Fractions with the Same Denominator · 14

ANSWER

yes

Comparing Fractions with the Same Denominator · 13

ANSWER

$\frac{2}{5}$

Comparing Fractions with the Same Denominator · 16

ANSWER

3

Comparing Fractions with the Same Denominator · 15

ANSWER

$\frac{4}{6}$

Comparing Fractions with the Same Denominator · 17

$\frac{3}{6}$ ___ $\frac{4}{6}$

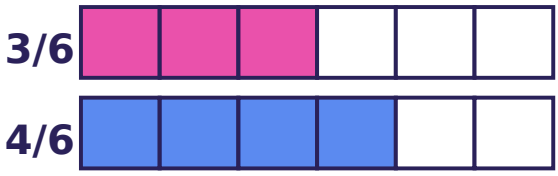

Comparing Fractions with the Same Denominator · 18

$\frac{2}{5}$ ___ $\frac{2}{5}$

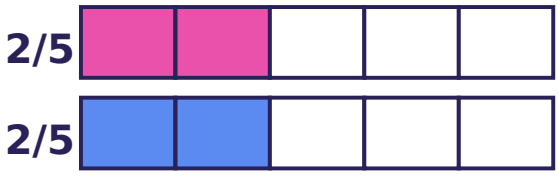

Comparing Fractions with the Same Denominator · 19

$\frac{5}{6}$ ___ $\frac{1}{6}$

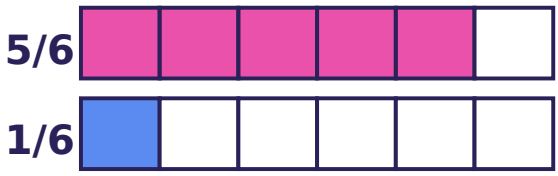

Comparing Fractions with the Same Denominator · 20

Each bar shows a fraction. Write the fraction that is greater.

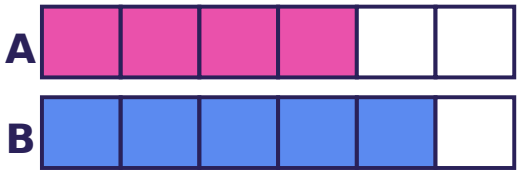

Comparing Fractions with the Same Denominator · 21

Which fraction is less: $\frac{5}{8}$ or $\frac{3}{8}$?

Comparing Fractions with the Same Denominator · 22

Is $\frac{2}{5}$ greater than $\frac{4}{5}$? Write yes or no.

Comparing Fractions with the Same Denominator · 23

Rope A is $\frac{7}{8}$ m long and rope B is $\frac{3}{8}$ m long. How many meters long is the longer rope?

Comparing Fractions with the Same Denominator · 24

$\frac{1}{5}$ ___ $\frac{4}{5}$



Comparing Fractions with the Same Denominator · 18

ANSWER

=

Comparing Fractions with the Same Denominator · 17

ANSWER

<

Comparing Fractions with the Same Denominator · 20

ANSWER

$\frac{5}{6}$

Comparing Fractions with the Same Denominator · 19

ANSWER

>

Comparing Fractions with the Same Denominator · 22

ANSWER

no

Comparing Fractions with the Same Denominator · 21

ANSWER

$\frac{3}{8}$

Comparing Fractions with the Same Denominator · 24

ANSWER

<

Comparing Fractions with the Same Denominator · 23

ANSWER

$\frac{7}{8}$