Task card 1 Comparing Fractions (Mixed Review)

Compare: $\frac{2}{8}$ ___ $\frac{3}{8}$. Write >, <, or =.

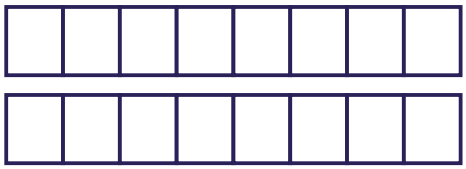

Task card 2 Comparing Fractions (Mixed Review)

Compare: $\frac{5}{6}$ ___ $\frac{5}{8}$. Write >, <, or =.

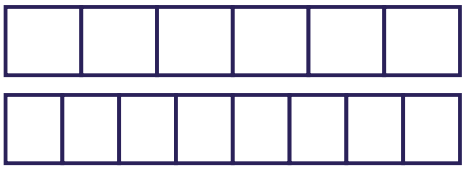

Task card 3 Comparing Fractions (Mixed Review)

Compare: $\frac{1}{3}$ ___ $\frac{2}{3}$. Write >, <, or =.

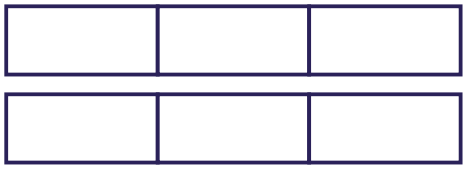

Task card 4 Comparing Fractions (Mixed Review)

Compare: $\frac{1}{6}$ ___ $\frac{1}{3}$. Write >, <, or =.

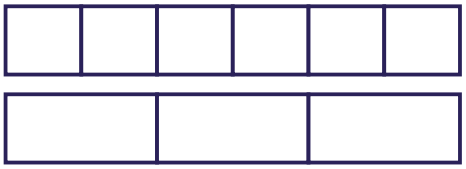

Task card 5 Comparing Fractions (Mixed Review)

Mia ate $\frac{1}{6}$ of a pie. Omar ate $\frac{2}{6}$ of a same-size pie. Who ate more? Write Mia or Omar.

Task card 6 Comparing Fractions (Mixed Review)

Compare: $\frac{3}{4}$ ___ $\frac{3}{8}$. Write >, <, or =.

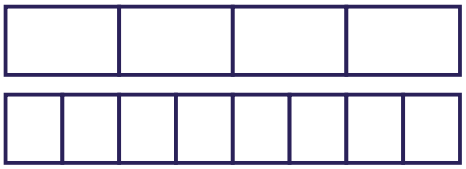

Task card 7 Comparing Fractions (Mixed Review)

Compare: $\frac{6}{8}$ ___ $\frac{5}{8}$. Write >, <, or =.

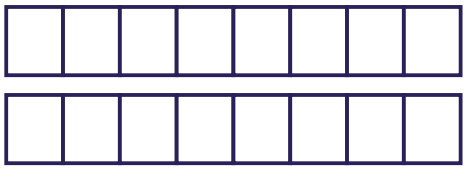

Task card 8 Comparing Fractions (Mixed Review)

Max ate $\frac{1}{3}$ of a pie. Leo ate $\frac{1}{2}$ of a same-size pie. Who ate more? Write Max or Leo.

Task card 9 Comparing Fractions (Mixed Review)

Compare: $\frac{4}{4}$ ___ $\frac{3}{4}$. Write >, <, or =.

Task card 10 Comparing Fractions (Mixed Review)

Compare: $\frac{5}{8}$ ___ $\frac{5}{6}$. Write >, <, or =.

Task card 11 Comparing Fractions (Mixed Review)

Compare: $\frac{5}{8}$ ___ $\frac{2}{8}$. Write >, <, or =.

Task card 12 Comparing Fractions (Mixed Review)

Compare: $\frac{1}{6}$ ___ $\frac{1}{4}$. Write >, <, or =.

Task card 13 Comparing Fractions (Mixed Review)

Lily ate $\frac{1}{3}$ of a pan of brownies. Zoe ate $\frac{2}{3}$ of a same-size pan of brownies. Who ate more? Write Lily or Zoe.

Task card 14 Comparing Fractions (Mixed Review)

Compare: $\frac{1}{8}$ ___ $\frac{1}{2}$. Write >, <, or =.

Task card 15 Comparing Fractions (Mixed Review)

Compare: $\frac{1}{4}$ ___ $\frac{4}{4}$. Write >, <, or =.

Task card 16 Comparing Fractions (Mixed Review)

Max ate $\frac{2}{3}$ of a pizza. Ben ate $\frac{1}{3}$ of a same-size pizza. Who ate more? Write Max or Ben.

Task card 17 Comparing Fractions (Mixed Review)

Compare: $\frac{1}{2}$ ___ $\frac{1}{8}$. Write >, <, or =.

Task card 18 Comparing Fractions (Mixed Review)

Compare: $\frac{3}{4}$ ___ $\frac{4}{4}$. Write >, <, or =.

Task card 19 Comparing Fractions (Mixed Review)

Ben ate $\frac{4}{6}$ of a pie. Lily ate $\frac{2}{6}$ of a same-size pie. Who ate more? Write Ben or Lily.

Task card 20 Comparing Fractions (Mixed Review)

Compare: $\frac{2}{3}$ ___ $\frac{3}{6}$. Write >, <, or =.

Task card 21 Comparing Fractions (Mixed Review)

Compare: $\frac{1}{3}$ ___ $\frac{1}{2}$. Write >, <, or =.

Task card 22 Comparing Fractions (Mixed Review)

Compare: $\frac{3}{8}$ ___ $\frac{2}{8}$. Write >, <, or =.

Task card 23 Comparing Fractions (Mixed Review)

Zoe ate $\frac{4}{6}$ of a sandwich. Omar ate $\frac{1}{6}$ of a same-size sandwich. Who ate less? Write Zoe or Omar.

Task card 24 Comparing Fractions (Mixed Review)

Compare: $\frac{2}{6}$ ___ $\frac{2}{8}$. Write >, <, or =.

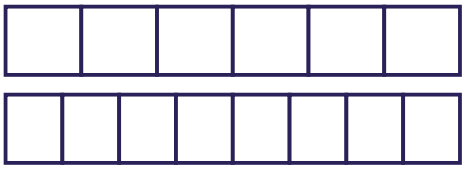

Comparing Fractions (Mixed Review) Task Cards

Recording sheet · Grade 3 · Compare the fractions. Both fractions are parts of the same-size whole.

Scan to check your answers

Name: _____ Date: _____

1	2	3	4
5	6	7	8
9	10	11	12
13	14	15	16
17	18	19	20
21	22	23	24

Comparing Fractions (Mixed Review) Task Cards: Answer Key

Grade 3 · Medium

The answers online

1. <	**2.** >	**3.** <
4. <	**5.** Omar	**6.** >
7. >	**8.** Leo	**9.** >
10. <	**11.** >	**12.** <
13. Zoe	**14.** <	**15.** <
16. Max	**17.** >	**18.** <
19. Ben	**20.** >	**21.** <
22. >	**23.** Omar	**24.** >