Task card 1 Comparing Fractions (Mixed Review)

Compare: $\frac{4}{4}$ ___ $\frac{1}{4}$. Write >, <, or =.

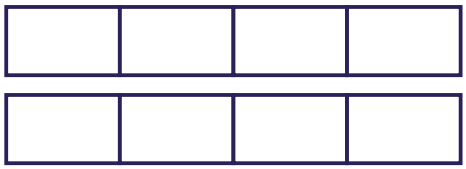

Task card 2 Comparing Fractions (Mixed Review)

Compare: $\frac{2}{6}$ ___ $\frac{2}{4}$. Write >, <, or =.

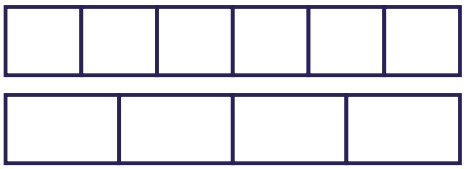

Task card 3 Comparing Fractions (Mixed Review)

Compare: $\frac{3}{3}$ ___ $\frac{2}{3}$. Write >, <, or =.



Task card 4 Comparing Fractions (Mixed Review)

Compare: $\frac{1}{4}$ ___ $\frac{1}{2}$. Write >, <, or =.

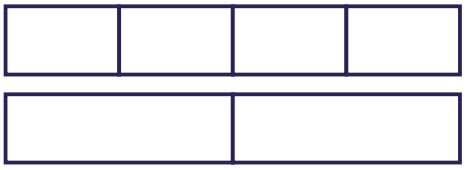

Task card 5 Comparing Fractions (Mixed Review)

Ava ate $\frac{3}{4}$ of a pie. Zoe ate $\frac{2}{4}$ of a same-size pie. Who ate less? Write Ava or Zoe.

Task card 6 Comparing Fractions (Mixed Review)

Compare: $\frac{1}{3}$ ___ $\frac{1}{4}$. Write >, <, or =.

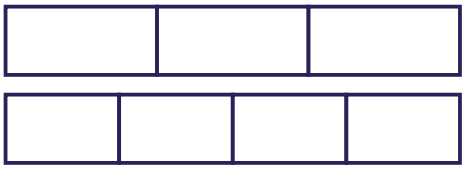

Task card 7 Comparing Fractions (Mixed Review)

Compare: $\frac{2}{4}$ ___ $\frac{3}{4}$. Write >, <, or =.

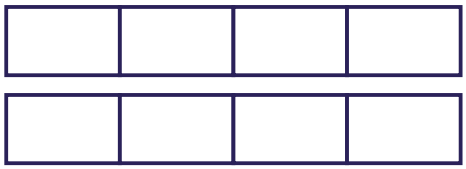

Task card 8 Comparing Fractions (Mixed Review)

Omar ate $\frac{1}{4}$ of a pan of brownies. Mia ate $\frac{1}{6}$ of a same-size pan of brownies. Who ate more? Write Omar or Mia.

Task card 9 Comparing Fractions (Mixed Review)

Compare: $\frac{6}{6}$ ___ $\frac{5}{6}$. Write >, <, or =.

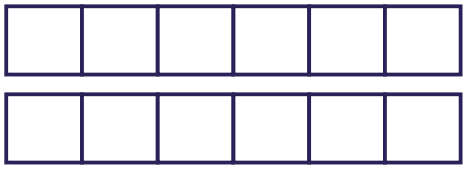

Task card 10 Comparing Fractions (Mixed Review)

Compare: $\frac{1}{3}$ ___ $\frac{1}{2}$. Write >, <, or =.

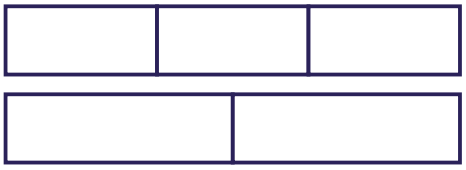

Task card 11 Comparing Fractions (Mixed Review)

Compare: $\frac{4}{4}$ ___ $\frac{2}{4}$. Write >, <, or =.

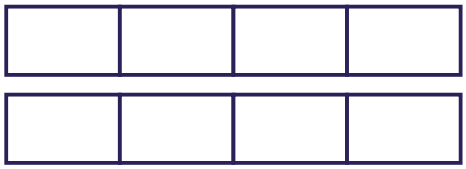

Task card 12 Comparing Fractions (Mixed Review)

Lily ate $\frac{4}{6}$ of a granola bar. Mia ate $\frac{5}{6}$ of a same-size granola bar. Who ate less? Write Lily or Mia.

Task card 13 Comparing Fractions (Mixed Review)

Compare: $\frac{1}{6}$ ___ $\frac{1}{3}$. Write >, <, or =.

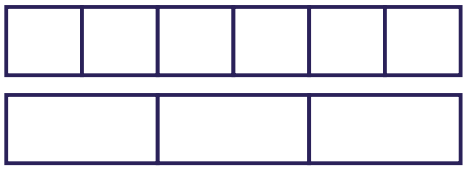

Task card 14 Comparing Fractions (Mixed Review)

Compare: $\frac{6}{6}$ ___ $\frac{1}{6}$. Write >, <, or =.

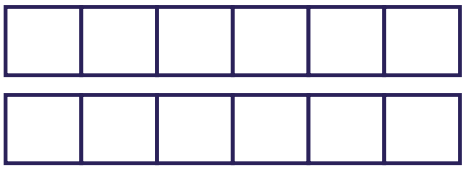

Task card 15 Comparing Fractions (Mixed Review)

Mia ate $\frac{3}{4}$ of a sandwich. Ava ate $\frac{2}{4}$ of a same-size sandwich. Who ate more? Write Mia or Ava.

Task card 16 Comparing Fractions (Mixed Review)

Compare: $\frac{2}{4}$ ___ $\frac{2}{6}$. Write >, <, or =.

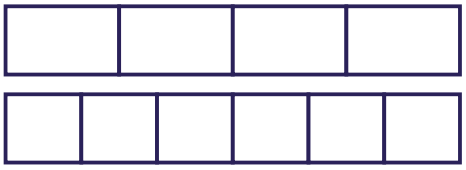

Task card 17 Comparing Fractions (Mixed Review)

Compare: $\frac{3}{4}$ ___ $\frac{2}{4}$. Write >, <, or =.

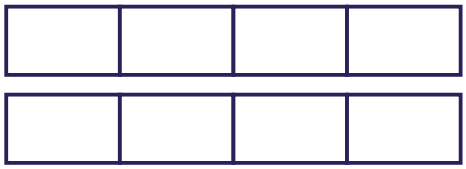

Task card 18 Comparing Fractions (Mixed Review)

Compare: $\frac{2}{6}$ ___ $\frac{2}{3}$. Write >, <, or =.

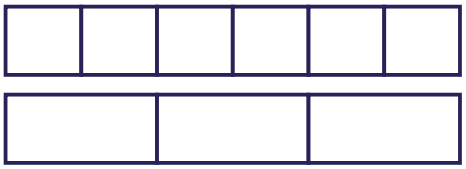

Task card 19 Comparing Fractions (Mixed Review)

Leo ate $\frac{1}{3}$ of a pie. Max ate $\frac{2}{3}$ of a same-size pie. Who ate more? Write Leo or Max.

Task card 20 Comparing Fractions (Mixed Review)

Compare: $\frac{1}{6}$ ___ $\frac{1}{4}$. Write >, <, or =.

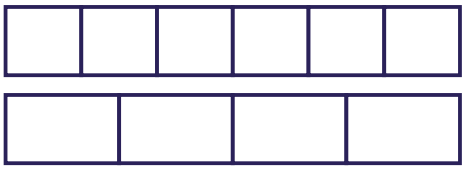

Task card 21 Comparing Fractions (Mixed Review)

Compare: $\frac{3}{6}$ ___ $\frac{4}{6}$. Write >, <, or =.

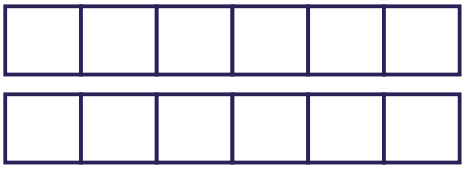

Task card 22 Comparing Fractions (Mixed Review)

Max ate $\frac{1}{4}$ of a granola bar. Omar ate $\frac{2}{4}$ of a same-size granola bar. Who ate less? Write Max or Omar.

Task card 23 Comparing Fractions (Mixed Review)

Compare: $\frac{1}{4}$ ___ $\frac{1}{3}$. Write >, <, or =.

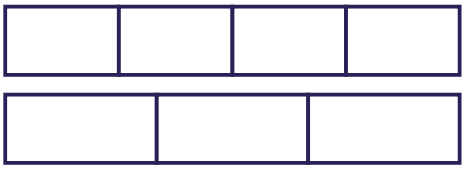

Task card 24 Comparing Fractions (Mixed Review)

Compare: $\frac{3}{3}$ ___ $\frac{1}{3}$. Write >, <, or =.

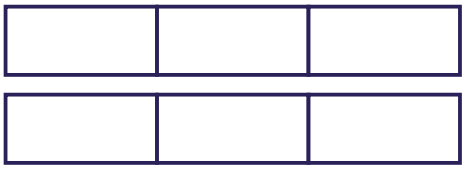

Comparing Fractions (Mixed Review) Task Cards

Recording sheet · Grade 3 · Compare the fractions. Both fractions are parts of the same-size whole.

Scan to check your answers

Name: _____ Date: _____

1	2	3	4
5	6	7	8
9	10	11	12
13	14	15	16
17	18	19	20
21	22	23	24

Comparing Fractions (Mixed Review) Task Cards: Answer Key

Grade 3 · Easy

The answers online

1. >	**2.** <	**3.** >
4. <	**5.** Zoe	**6.** >
7. <	**8.** Omar	**9.** >
10. <	**11.** >	**12.** Lily
13. <	**14.** >	**15.** Mia
16. >	**17.** >	**18.** <
19. Max	**20.** <	**21.** <
22. Max	**23.** <	**24.** >