Task card 1 Christmas Math

A Christmas cake is cut into 10 equal slices. The family eats 7 slices. What fraction of the Christmas cake did they eat?

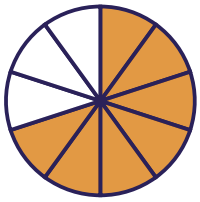

Task card 2 Christmas Math

A Christmas cake is cut into 12 equal slices. The family eats 7 slices. What fraction of the Christmas cake did they eat?

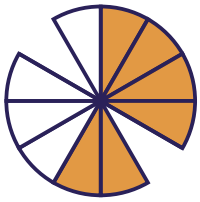

Task card 3 Christmas Math

Sam shares 54 candy canes equally among 6 friends. How many candy canes does each friend get?

Task card 4 Christmas Math

Mia shares 28 candy canes equally among 4 friends. How many candy canes does each friend get?

Task card 5 Christmas Math

The Christmas party starts at 2:30. It lasts 2 hours. What time does the party end?



Task card 6 Christmas Math

At the Christmas party there are 5 tables. 4 people sit at each table. How many people are there?

Task card 7 Christmas Math

At the Christmas party there are 6 tables. 3 people sit at each table. How many people are there?

Task card 8 Christmas Math

The Christmas party starts at 2:00. It lasts 3 hours. What time does the party end?



Task card 9 Christmas Math

At the Christmas party there are 4 tables. 3 people sit at each table. How many people are there?

Task card 10 Christmas Math

The Christmas party starts at 1:00. It lasts 4 hours. What time does the party end?



Task card 11 Christmas Math

The Christmas party starts at 4:30. It lasts 3 hours. What time does the party end?



Task card 12 Christmas Math

At the Christmas party there are 7 tables. 9 people sit at each table. How many people are there?

Task card 13 Christmas Math

A Christmas cake is cut into 12 equal slices. The family eats 5 slices. What fraction of the Christmas cake did they eat?

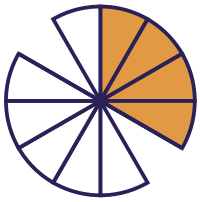

Task card 14 Christmas Math

A Christmas cake is cut into 10 equal slices. The family eats 9 slices. What fraction of the Christmas cake did they eat?

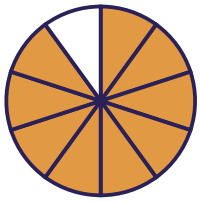

Task card 15 Christmas Math

Noah shares 20 candy canes equally among 4 friends. How many candy canes does each friend get?

Task card 16 Christmas Math

Sam shares 28 candy canes equally among 7 friends. How many candy canes does each friend get?

Task card 17 Christmas Math

At the Christmas party there are 3 tables. 10 people sit at each table. How many people are there?

Task card 18 Christmas Math

Ella shares 9 cookies equally among 3 friends. How many cookies does each friend get?

Task card 19 Christmas Math

The Christmas party starts at 1:30. It lasts 2 hours. What time does the party end?



Task card 20 Christmas Math

At the Christmas party there are 9 tables. 5 people sit at each table. How many people are there?

Task card 21 Christmas Math

A Christmas cake is cut into 8 equal slices. The family eats 1 slice. What fraction of the Christmas cake did they eat?

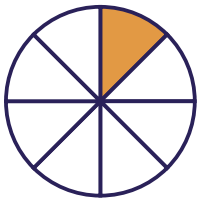

Task card 22 Christmas Math

Lily shares 64 gingerbread men equally among 8 friends. How many gingerbread men does each friend get?

Task card 23 Christmas Math

The Christmas party starts at 3:00. It lasts 4 hours. What time does the party end?



Task card 24 Christmas Math

At the Christmas party there are 8 tables. 3 people sit at each table. How many people are there?

Christmas Math Task Cards

Recording sheet · Grade 3 · Read each story and solve. Write times like 3:00 and fractions like 3/8.

Name: _____ Date: _____

Scan to check your answers

1	2	3	4
5	6	7	8
9	10	11	12
13	14	15	16
17	18	19	20
21	22	23	24

Christmas Math Task Cards: Answer Key

Grade 3 · Hard

The answers online

1. $\frac{7}{10}$	**2.** $\frac{7}{12}$	**3.** 9
4. 7	**5.** 4:30	**6.** 20
7. 18	**8.** 5:00	**9.** 12
10. 5:00	**11.** 7:30	**12.** 63
13. $\frac{5}{12}$	**14.** $\frac{9}{10}$	**15.** 5
16. 4	**17.** 30	**18.** 3
19. 3:30	**20.** 45	**21.** $\frac{1}{8}$
22. 8	**23.** 7:00	**24.** 24