Task card 1 Christmas Math

The Christmas party starts at 3:00. It lasts 5 hours. What time does the party end?



Task card 2 Christmas Math

The Christmas party starts at 4:00. It lasts 5 hours. What time does the party end?



Task card 3 Christmas Math

At the Christmas party there are 9 tables. 7 people sit at each table. How many people are there?

Task card 4 Christmas Math

A Christmas cake is cut into 6 equal slices. The family eats 5 slices. What fraction of the Christmas cake did they eat?

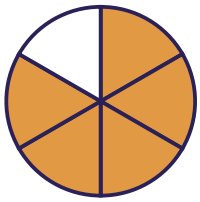

Task card 5 Christmas Math

Ben shares 32 candy canes equally among 8 friends. How many candy canes does each friend get?

Task card 6 Christmas Math

At the Christmas party there are 6 tables. 4 people sit at each table. How many people are there?

Task card 7 Christmas Math

Leo shares 35 gingerbread men equally among 7 friends. How many gingerbread men does each friend get?

Task card 8 Christmas Math

A Christmas cake is cut into 12 equal slices. The family eats 5 slices. What fraction of the Christmas cake did they eat?

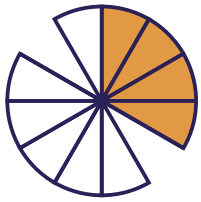

Task card 9 Christmas Math

Sam shares 40 gingerbread men equally among 5 friends. How many gingerbread men does each friend get?

Task card 10 Christmas Math

A Christmas cake is cut into 12 equal slices. The family eats 7 slices. What fraction of the Christmas cake did they eat?

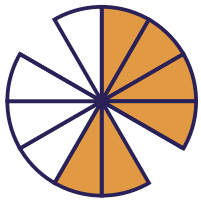

Task card 11 Christmas Math

The Christmas party starts at 1:00. It lasts 2 hours. What time does the party end?



Task card 12 Christmas Math

At the Christmas party there are 5 tables. 4 people sit at each table. How many people are there?

Task card 13 Christmas Math

At the Christmas party there are 7 tables. 8 people sit at each table. How many people are there?

Task card 14 Christmas Math

The Christmas party starts at 5:30. It lasts 5 hours. What time does the party end?



Task card 15 Christmas Math

Omar shares 24 candy canes equally among 8 friends. How many candy canes does each friend get?

Task card 16 Christmas Math

The Christmas party starts at 3:30. It lasts 5 hours. What time does the party end?



Task card 17 Christmas Math

Omar shares 24 cookies equally among 6 friends. How many cookies does each friend get?

Task card 18 Christmas Math

Mia shares 24 cookies equally among 3 friends. How many cookies does each friend get?

Task card 19 Christmas Math

At the Christmas party there are 7 tables. 5 people sit at each table. How many people are there?

Task card 20 Christmas Math

A Christmas cake is cut into 10 equal slices. The family eats 7 slices. What fraction of the Christmas cake did they eat?

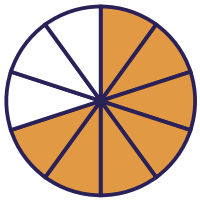

Task card 21 Christmas Math

At the Christmas party there are 6 tables. 8 people sit at each table. How many people are there?

Task card 22 Christmas Math

The Christmas party starts at 5:00. It lasts 5 hours. What time does the party end?



Task card 23 Christmas Math

At the Christmas party there are 5 tables. 5 people sit at each table. How many people are there?

Task card 24 Christmas Math

Ben shares 24 cookies equally among 8 friends. How many cookies does each friend get?

Christmas Math Task Cards

Recording sheet · Grade 3 · Read each story and solve. Write times like 3:00 and fractions like 3/8.

Name: _____ Date: _____

Scan to check your answers

1	2	3	4
5	6	7	8
9	10	11	12
13	14	15	16
17	18	19	20
21	22	23	24

Christmas Math Task Cards: Answer Key

Grade 3 · Medium

The answers online

1. 8:00	**2.** 9:00	**3.** 63
4. $\frac{5}{6}$	**5.** 4	**6.** 24
7. 5	**8.** $\frac{5}{12}$	**9.** 8
10. $\frac{7}{12}$	**11.** 3:00	**12.** 20
13. 56	**14.** 10:30	**15.** 3
16. 8:30	**17.** 4	**18.** 8
19. 35	**20.** $\frac{7}{10}$	**21.** 48
22. 10:00	**23.** 25	**24.** 3