Task card 1 Christmas Math

At the Christmas party there are 7 tables. 2 people sit at each table. How many people are there?

Task card 2 Christmas Math

Ava shares 30 cookies equally among 6 friends. How many cookies does each friend get?

Task card 3 Christmas Math

A Christmas cake is cut into 6 equal slices. The family eats 5 slices. What fraction of the Christmas cake did they eat?

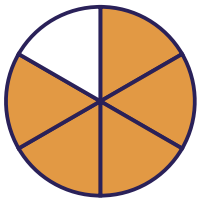

Task card 4 Christmas Math

Lily shares 45 candy canes equally among 9 friends. How many candy canes does each friend get?

Task card 5 Christmas Math

The Christmas party starts at 3:00. It lasts 3 hours. What time does the party end?



Task card 6 Christmas Math

A Christmas cake is cut into 6 equal slices. The family eats 1 slice. What fraction of the Christmas cake did they eat?

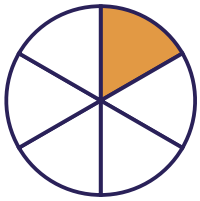

Task card 7 Christmas Math

The Christmas party starts at 2:00. It lasts 3 hours. What time does the party end?



Task card 8 Christmas Math

At the Christmas party there are 6 tables. 4 people sit at each table. How many people are there?

Task card 9 Christmas Math

Sam shares 40 gingerbread men equally among 8 friends. How many gingerbread men does each friend get?

Task card 10 Christmas Math

A Christmas cake is cut into 4 equal slices. The family eats 1 slice. What fraction of the Christmas cake did they eat?



Task card 11 Christmas Math

Ben shares 36 candy canes equally among 6 friends. How many candy canes does each friend get?

Task card 12 Christmas Math

The Christmas party starts at 4:00. It lasts 2 hours. What time does the party end?



Task card 13 Christmas Math

At the Christmas party there are 3 tables. 2 people sit at each table. How many people are there?

Task card 14 Christmas Math

At the Christmas party there are 9 tables. 4 people sit at each table. How many people are there?

Task card 15 Christmas Math

A Christmas cake is cut into 8 equal slices. The family eats 1 slice. What fraction of the Christmas cake did they eat?

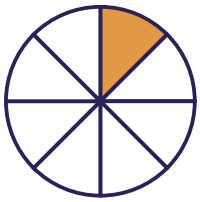

Task card 16 Christmas Math

The Christmas party starts at 5:00. It lasts 3 hours. What time does the party end?



Task card 17 Christmas Math

The Christmas party starts at 1:00. It lasts 4 hours. What time does the party end?



Task card 18 Christmas Math

A Christmas cake is cut into 4 equal slices. The family eats 3 slices. What fraction of the Christmas cake did they eat?



Task card 19 Christmas Math

A Christmas cake is cut into 8 equal slices. The family eats 5 slices. What fraction of the Christmas cake did they eat?

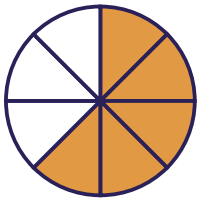

Task card 20 Christmas Math

At the Christmas party there are 4 tables. 2 people sit at each table. How many people are there?

Task card 21 Christmas Math

Lily shares 21 candy canes equally among 3 friends. How many candy canes does each friend get?

Task card 22 Christmas Math

The Christmas party starts at 3:00. It lasts 5 hours. What time does the party end?



Task card 23 Christmas Math

Ben shares 15 cookies equally among 3 friends. How many cookies does each friend get?

Task card 24 Christmas Math

The Christmas party starts at 1:00. It lasts 2 hours. What time does the party end?



Christmas Math Task Cards

Recording sheet · Grade 3 · Read each story and solve. Write times like 3:00 and fractions like 3/8.

Name: _____ Date: _____

Scan to check your answers

1	2	3	4
5	6	7	8
9	10	11	12
13	14	15	16
17	18	19	20
21	22	23	24

Christmas Math Task Cards: Answer Key

Grade 3 · Easy

The answers online

1. 14	**2.** 5	**3.** $\frac{5}{6}$
4. 5	**5.** 6:00	**6.** $\frac{1}{6}$
7. 5:00	**8.** 24	**9.** 5
10. $\frac{1}{4}$	**11.** 6	**12.** 6:00
13. 6	**14.** 36	**15.** $\frac{1}{8}$
16. 8:00	**17.** 5:00	**18.** $\frac{3}{4}$
19. $\frac{5}{8}$	**20.** 8	**21.** 7
22. 8:00	**23.** 5	**24.** 3:00