Christmas Math · 1

A Christmas cake is cut into 10 equal slices. The family eats 7 slices. What fraction of the Christmas cake did they eat?

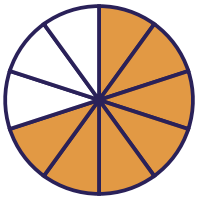

Christmas Math · 2

A Christmas cake is cut into 12 equal slices. The family eats 7 slices. What fraction of the Christmas cake did they eat?



Christmas Math · 3

Sam shares 54 candy canes equally among 6 friends. How many candy canes does each friend get?

Christmas Math · 4

Mia shares 28 candy canes equally among 4 friends. How many candy canes does each friend get?

Christmas Math · 5

The Christmas party starts at 2:30. It lasts 2 hours. What time does the party end?



Christmas Math · 6

At the Christmas party there are 5 tables. 4 people sit at each table. How many people are there?

Christmas Math · 7

At the Christmas party there are 6 tables. 3 people sit at each table. How many people are there?

Christmas Math · 8

The Christmas party starts at 2:00. It lasts 3 hours. What time does the party end?



Christmas Math · 2

ANSWER

$\frac{7}{12}$

Christmas Math · 1

ANSWER

$\frac{7}{10}$

Christmas Math · 4

ANSWER

7

Christmas Math · 3

ANSWER

9

Christmas Math · 6

ANSWER

20

Christmas Math · 5

ANSWER

4:30

Christmas Math · 8

ANSWER

5:00

Christmas Math · 7

ANSWER

18

Christmas Math · 9

At the Christmas party there are 4 tables. 3 people sit at each table. How many people are there?

Christmas Math · 10

The Christmas party starts at 1:00. It lasts 4 hours. What time does the party end?



Christmas Math · 11

The Christmas party starts at 4:30. It lasts 3 hours. What time does the party end?



Christmas Math · 12

At the Christmas party there are 7 tables. 9 people sit at each table. How many people are there?

Christmas Math · 13

A Christmas cake is cut into 12 equal slices. The family eats 5 slices. What fraction of the Christmas cake did they eat?

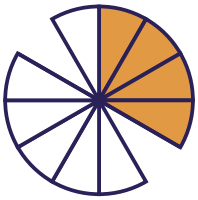

Christmas Math · 14

A Christmas cake is cut into 10 equal slices. The family eats 9 slices. What fraction of the Christmas cake did they eat?

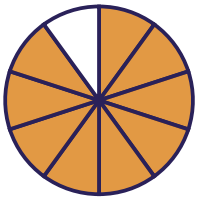

Christmas Math · 15

Noah shares 20 candy canes equally among 4 friends. How many candy canes does each friend get?

Christmas Math · 16

Sam shares 28 candy canes equally among 7 friends. How many candy canes does each friend get?

Christmas Math · 10

ANSWER

5:00

Christmas Math · 9

ANSWER

12

Christmas Math · 12

ANSWER

63

Christmas Math · 11

ANSWER

7:30

Christmas Math · 14

ANSWER

$$\frac{9}{10}$$

Christmas Math · 13

ANSWER

$$\frac{5}{12}$$

Christmas Math · 16

ANSWER

4

Christmas Math · 15

ANSWER

5

Christmas Math · 17

At the Christmas party there are 3 tables. 10 people sit at each table. How many people are there?

Christmas Math · 18

Ella shares 9 cookies equally among 3 friends. How many cookies does each friend get?

Christmas Math · 19

The Christmas party starts at 1:30. It lasts 2 hours. What time does the party end?



Christmas Math · 20

At the Christmas party there are 9 tables. 5 people sit at each table. How many people are there?

Christmas Math · 21

A Christmas cake is cut into 8 equal slices. The family eats 1 slice. What fraction of the Christmas cake did they eat?

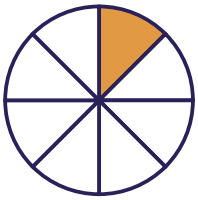

Christmas Math · 22

Lily shares 64 gingerbread men equally among 8 friends. How many gingerbread men does each friend get?

Christmas Math · 23

The Christmas party starts at 3:00. It lasts 4 hours. What time does the party end?



Christmas Math · 24

At the Christmas party there are 8 tables. 3 people sit at each table. How many people are there?

Christmas Math · 18

ANSWER

3

Christmas Math · 17

ANSWER

30

Christmas Math · 20

ANSWER

45

Christmas Math · 19

ANSWER

3:30

Christmas Math · 22

ANSWER

8

Christmas Math · 21

ANSWER

$$\frac{1}{8}$$

Christmas Math · 24

ANSWER

24

Christmas Math · 23

ANSWER

7:00