Christmas Math · 1

The Christmas party starts at 3:00. It lasts 5 hours. What time does the party end?



Christmas Math · 2

The Christmas party starts at 4:00. It lasts 5 hours. What time does the party end?



Christmas Math · 3

At the Christmas party there are 9 tables. 7 people sit at each table. How many people are there?

Christmas Math · 4

A Christmas cake is cut into 6 equal slices. The family eats 5 slices. What fraction of the Christmas cake did they eat?

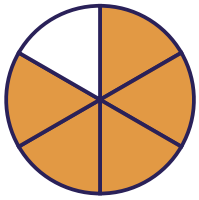

Christmas Math · 5

Ben shares 32 candy canes equally among 8 friends. How many candy canes does each friend get?

Christmas Math · 6

At the Christmas party there are 6 tables. 4 people sit at each table. How many people are there?

Christmas Math · 7

Leo shares 35 gingerbread men equally among 7 friends. How many gingerbread men does each friend get?

Christmas Math · 8

A Christmas cake is cut into 12 equal slices. The family eats 5 slices. What fraction of the Christmas cake did they eat?

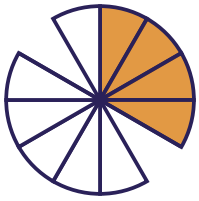

Christmas Math · 2

ANSWER

9:00

Christmas Math · 1

ANSWER

8:00

Christmas Math · 4

ANSWER

$$\frac{5}{6}$$

Christmas Math · 3

ANSWER

63

Christmas Math · 6

ANSWER

24

Christmas Math · 5

ANSWER

4

Christmas Math · 8

ANSWER

$$\frac{5}{12}$$

Christmas Math · 7

ANSWER

5

Christmas Math · 9

Sam shares 40 gingerbread men equally among 5 friends. How many gingerbread men does each friend get?

Christmas Math · 10

A Christmas cake is cut into 12 equal slices. The family eats 7 slices. What fraction of the Christmas cake did they eat?



Christmas Math · 11

The Christmas party starts at 1:00. It lasts 2 hours. What time does the party end?



Christmas Math · 12

At the Christmas party there are 5 tables. 4 people sit at each table. How many people are there?

Christmas Math · 13

At the Christmas party there are 7 tables. 8 people sit at each table. How many people are there?

Christmas Math · 14

The Christmas party starts at 5:30. It lasts 5 hours. What time does the party end?



Christmas Math · 15

Omar shares 24 candy canes equally among 8 friends. How many candy canes does each friend get?

Christmas Math · 16

The Christmas party starts at 3:30. It lasts 5 hours. What time does the party end?



Christmas Math · 10

ANSWER

$\frac{7}{12}$

Christmas Math · 9

ANSWER

8

Christmas Math · 12

ANSWER

20

Christmas Math · 11

ANSWER

3:00

Christmas Math · 14

ANSWER

10:30

Christmas Math · 13

ANSWER

56

Christmas Math · 16

ANSWER

8:30

Christmas Math · 15

ANSWER

3

Christmas Math · 17

Omar shares 24 cookies equally among 6 friends. How many cookies does each friend get?

Christmas Math · 18

Mia shares 24 cookies equally among 3 friends. How many cookies does each friend get?

Christmas Math · 19

At the Christmas party there are 7 tables. 5 people sit at each table. How many people are there?

Christmas Math · 20

A Christmas cake is cut into 10 equal slices. The family eats 7 slices. What fraction of the Christmas cake did they eat?

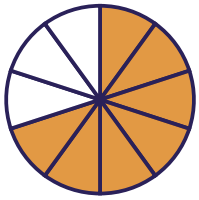

Christmas Math · 21

At the Christmas party there are 6 tables. 8 people sit at each table. How many people are there?

Christmas Math · 22

The Christmas party starts at 5:00. It lasts 5 hours. What time does the party end?



Christmas Math · 23

At the Christmas party there are 5 tables. 5 people sit at each table. How many people are there?

Christmas Math · 24

Ben shares 24 cookies equally among 8 friends. How many cookies does each friend get?

Christmas Math · 18

ANSWER

8

Christmas Math · 17

ANSWER

4

Christmas Math · 20

ANSWER

$$\frac{7}{10}$$

Christmas Math · 19

ANSWER

35

Christmas Math · 22

ANSWER

10:00

Christmas Math · 21

ANSWER

48

Christmas Math · 24

ANSWER

3

Christmas Math · 23

ANSWER

25