Christmas Math · 1

At the Christmas party there are 7 tables. 2 people sit at each table. How many people are there?

Christmas Math · 2

Ava shares 30 cookies equally among 6 friends. How many cookies does each friend get?

Christmas Math · 3

A Christmas cake is cut into 6 equal slices. The family eats 5 slices. What fraction of the Christmas cake did they eat?

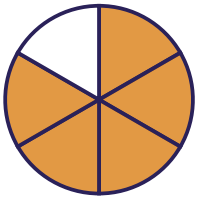

Christmas Math · 4

Lily shares 45 candy canes equally among 9 friends. How many candy canes does each friend get?

Christmas Math · 5

The Christmas party starts at 3:00. It lasts 3 hours. What time does the party end?



Christmas Math · 6

A Christmas cake is cut into 6 equal slices. The family eats 1 slice. What fraction of the Christmas cake did they eat?

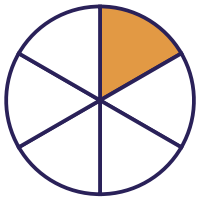

Christmas Math · 7

The Christmas party starts at 2:00. It lasts 3 hours. What time does the party end?



Christmas Math · 8

At the Christmas party there are 6 tables. 4 people sit at each table. How many people are there?

Christmas Math · 2

ANSWER

5

Christmas Math · 1

ANSWER

14

Christmas Math · 4

ANSWER

5

Christmas Math · 3

ANSWER

$$\frac{5}{6}$$

Christmas Math · 6

ANSWER

$$\frac{1}{6}$$

Christmas Math · 5

ANSWER

6:00

Christmas Math · 8

ANSWER

24

Christmas Math · 7

ANSWER

5:00

Christmas Math · 9

Sam shares 40 gingerbread men equally among 8 friends. How many gingerbread men does each friend get?

Christmas Math · 10

A Christmas cake is cut into 4 equal slices. The family eats 1 slice. What fraction of the Christmas cake did they eat?



Christmas Math · 11

Ben shares 36 candy canes equally among 6 friends. How many candy canes does each friend get?

Christmas Math · 12

The Christmas party starts at 4:00. It lasts 2 hours. What time does the party end?



Christmas Math · 13

At the Christmas party there are 3 tables. 2 people sit at each table. How many people are there?

Christmas Math · 14

At the Christmas party there are 9 tables. 4 people sit at each table. How many people are there?

Christmas Math · 15

A Christmas cake is cut into 8 equal slices. The family eats 1 slice. What fraction of the Christmas cake did they eat?

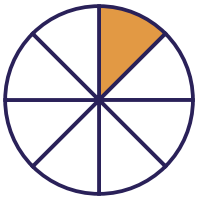

Christmas Math · 16

The Christmas party starts at 5:00. It lasts 3 hours. What time does the party end?



Christmas Math · 10

ANSWER

$\frac{1}{4}$

Christmas Math · 9

ANSWER

5

Christmas Math · 12

ANSWER

6:00

Christmas Math · 11

ANSWER

6

Christmas Math · 14

ANSWER

36

Christmas Math · 13

ANSWER

6

Christmas Math · 16

ANSWER

8:00

Christmas Math · 15

ANSWER

$\frac{1}{8}$

Christmas Math · 17

The Christmas party starts at 1:00. It lasts 4 hours. What time does the party end?



Christmas Math · 18

A Christmas cake is cut into 4 equal slices. The family eats 3 slices. What fraction of the Christmas cake did they eat?



Christmas Math · 19

A Christmas cake is cut into 8 equal slices. The family eats 5 slices. What fraction of the Christmas cake did they eat?

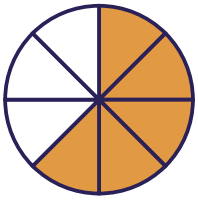

Christmas Math · 20

At the Christmas party there are 4 tables. 2 people sit at each table. How many people are there?

Christmas Math · 21

Lily shares 21 candy canes equally among 3 friends. How many candy canes does each friend get?

Christmas Math · 22

The Christmas party starts at 3:00. It lasts 5 hours. What time does the party end?



Christmas Math · 23

Ben shares 15 cookies equally among 3 friends. How many cookies does each friend get?

Christmas Math · 24

The Christmas party starts at 1:00. It lasts 2 hours. What time does the party end?



Christmas Math · 18

ANSWER

$\frac{3}{4}$

Christmas Math · 17

ANSWER

5:00

Christmas Math · 20

ANSWER

8

Christmas Math · 19

ANSWER

$\frac{5}{8}$

Christmas Math · 22

ANSWER

8:00

Christmas Math · 21

ANSWER

7

Christmas Math · 24

ANSWER

3:00

Christmas Math · 23

ANSWER

5