Task card 1 Back to School Math

Noah shares 40 muffins equally among 8 friends. How many muffins does each friend get?

Task card 2 Back to School Math

School starts at 9:00. Ben stays at school for 2 hours. What time does Ben leave?



Task card 3 Back to School Math

At the back-to-school picnic there are 9 tables. 2 people sit at each table. How many people are there?

Task card 4 Back to School Math

School starts at 8:00. Sam stays at school for 3 hours. What time does Sam leave?



Task card 5 Back to School Math

A pizza is cut into 12 equal slices. The family eats 7 slices. What fraction of the pizza did they eat?

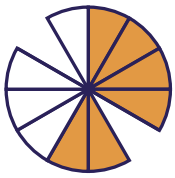

Task card 6 Back to School Math

At the back-to-school picnic there are 9 tables. 7 people sit at each table. How many people are there?

Task card 7 Back to School Math

Zoe shares 24 muffins equally among 8 friends. How many muffins does each friend get?

Task card 8 Back to School Math

A pizza is cut into 8 equal slices. The family eats 1 slice. What fraction of the pizza did they eat?



Task card 9 Back to School Math

At the back-to-school picnic there are 7 tables. 8 people sit at each table. How many people are there?

Task card 10 Back to School Math

A pizza is cut into 6 equal slices. The family eats 5 slices. What fraction of the pizza did they eat?

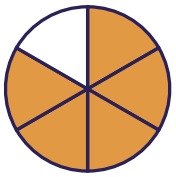

Task card 11 Back to School Math

School starts at 9:30. Ella stays at school for 5 hours. What time does Ella leave?



Task card 12 Back to School Math

Zoe shares 63 granola bars equally among 7 friends. How many granola bars does each friend get?

Task card 13 Back to School Math

Lily shares 12 oatmeal cookies equally among 6 friends. How many oatmeal cookies does each friend get?

Task card 14 Back to School Math

School starts at 9:30. Ben stays at school for 3 hours. What time does Ben leave?



Task card 15 Back to School Math

At the back-to-school picnic there are 4 tables. 2 people sit at each table. How many people are there?

Task card 16 Back to School Math

A pizza is cut into 12 equal slices. The family eats 1 slice. What fraction of the pizza did they eat?



Task card 17 Back to School Math

At the back-to-school picnic there are 4 tables. 5 people sit at each table. How many people are there?

Task card 18 Back to School Math

At the back-to-school picnic there are 2 tables. 2 people sit at each table. How many people are there?

Task card 19 Back to School Math

Lily shares 28 granola bars equally among 4 friends. How many granola bars does each friend get?

Task card 20 Back to School Math

A pizza is cut into 8 equal slices. The family eats 3 slices. What fraction of the pizza did they eat?

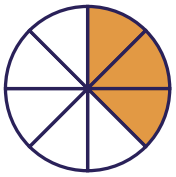

Task card 21 Back to School Math

Noah shares 40 muffins equally among 4 friends. How many muffins does each friend get?

Task card 22 Back to School Math

School starts at 9:30. Noah stays at school for 5 hours. What time does Noah leave?



Task card 23 Back to School Math

School starts at 8:00. Sam stays at school for 5 hours. What time does Sam leave?



Task card 24 Back to School Math

At the back-to-school picnic there are 8 tables. 6 people sit at each table. How many people are there?

Back to School Math Task Cards

Recording sheet · Grade 3 · Read each story and solve. Write times like 3:00 and fractions like 3/8.

Name: _____ Date: _____

Scan to check your answers

1	2	3	4
5	6	7	8
9	10	11	12
13	14	15	16
17	18	19	20
21	22	23	24

Back to School Math Task Cards: Answer Key

Grade 3 · Medium

The answers online

1. 5	**2.** 11:00	**3.** 18
4. 11:00	**5.** $\frac{7}{12}$	**6.** 63
7. 3	**8.** $\frac{1}{8}$	**9.** 56
10. $\frac{5}{6}$	**11.** 2:30	**12.** 9
13. 2	**14.** 12:30	**15.** 8
16. $\frac{1}{12}$	**17.** 20	**18.** 4
19. 7	**20.** $\frac{3}{8}$	**21.** 10
22. 2:30	**23.** 1:00	**24.** 48