Task card 1 Back to School Math

Omar shares 16 granola bars equally among 2 friends. How many granola bars does each friend get?

Task card 2 Back to School Math

School starts at 8:30. Sam stays at school for 2 hours. What time does Sam leave?



Task card 3 Back to School Math

At the back-to-school picnic there are 7 tables. 7 people sit at each table. How many people are there?

Task card 4 Back to School Math

A pizza is cut into 10 equal slices. The family eats 3 slices. What fraction of the pizza did they eat?

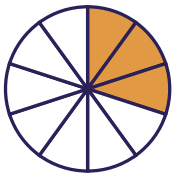

Task card 5 Back to School Math

A pizza is cut into 6 equal slices. The family eats 1 slice. What fraction of the pizza did they eat?

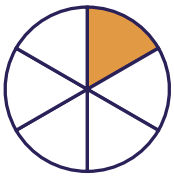

Task card 6 Back to School Math

Zoe shares 9 granola bars equally among 3 friends. How many granola bars does each friend get?

Task card 7 Back to School Math

School starts at 8:00. Ava stays at school for 5 hours. What time does Ava leave?



Task card 8 Back to School Math

At the back-to-school picnic there are 8 tables. 4 people sit at each table. How many people are there?

Task card 9 Back to School Math

School starts at 8:00. Noah stays at school for 2 hours. What time does Noah leave?



Task card 10 Back to School Math

At the back-to-school picnic there are 5 tables. 2 people sit at each table. How many people are there?

Task card 11 Back to School Math

School starts at 8:00. Ella stays at school for 2 hours. What time does Ella leave?



Task card 12 Back to School Math

Leo shares 36 granola bars equally among 9 friends. How many granola bars does each friend get?

Task card 13 Back to School Math

A pizza is cut into 6 equal slices. The family eats 5 slices. What fraction of the pizza did they eat?

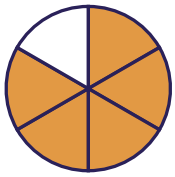

Task card 14 Back to School Math

A pizza is cut into 12 equal slices. The family eats 7 slices. What fraction of the pizza did they eat?



Task card 15 Back to School Math

At the back-to-school picnic there are 9 tables. 3 people sit at each table. How many people are there?

Task card 16 Back to School Math

Omar shares 24 granola bars equally among 3 friends. How many granola bars does each friend get?

Task card 17 Back to School Math

A pizza is cut into 8 equal slices. The family eats 5 slices. What fraction of the pizza did they eat?

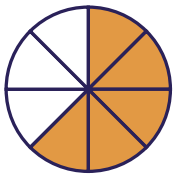

Task card 18 Back to School Math

Zoe shares 50 muffins equally among 5 friends. How many muffins does each friend get?

Task card 19 Back to School Math

School starts at 8:30. Ella stays at school for 4 hours. What time does Ella leave?



Task card 20 Back to School Math

School starts at 9:00. Sam stays at school for 4 hours. What time does Sam leave?



Task card 21 Back to School Math

Sam shares 63 oatmeal cookies equally among 9 friends. How many oatmeal cookies does each friend get?

Task card 22 Back to School Math

At the back-to-school picnic there are 4 tables. 10 people sit at each table. How many people are there?

Task card 23 Back to School Math

A pizza is cut into 12 equal slices. The family eats 11 slices. What fraction of the pizza did they eat?

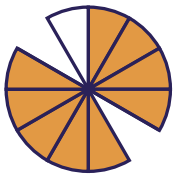

Task card 24 Back to School Math

At the back-to-school picnic there are 2 tables. 3 people sit at each table. How many people are there?

Back to School Math Task Cards

Recording sheet · Grade 3 · Read each story and solve. Write times like 3:00 and fractions like 3/8.

Name: _____ Date: _____

Scan to check your answers

1	2	3	4
5	6	7	8
9	10	11	12
13	14	15	16
17	18	19	20
21	22	23	24

Back to School Math Task Cards: Answer Key

Grade 3 · Hard

The answers online

1. 8	**2.** 10:30	**3.** 49
4. $\frac{3}{10}$	**5.** $\frac{1}{6}$	**6.** 3
7. 1:00	**8.** 32	**9.** 10:00
10. 10	**11.** 10:00	**12.** 4
13. $\frac{5}{6}$	**14.** $\frac{7}{12}$	**15.** 27
16. 8	**17.** $\frac{5}{8}$	**18.** 10
19. 12:30	**20.** 1:00	**21.** 7
22. 40	**23.** $\frac{11}{12}$	**24.** 6