Back to School Math · 1

Noah shares 40 muffins equally among 8 friends. How many muffins does each friend get?

Back to School Math · 2

School starts at 9:00. Ben stays at school for 2 hours. What time does Ben leave?



Back to School Math · 3

At the back-to-school picnic there are 9 tables. 2 people sit at each table. How many people are there?

Back to School Math · 4

School starts at 8:00. Sam stays at school for 3 hours. What time does Sam leave?



Back to School Math · 5

A pizza is cut into 12 equal slices. The family eats 7 slices. What fraction of the pizza did they eat?

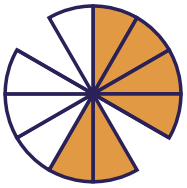

Back to School Math · 6

At the back-to-school picnic there are 9 tables. 7 people sit at each table. How many people are there?

Back to School Math · 7

Zoe shares 24 muffins equally among 8 friends. How many muffins does each friend get?

Back to School Math · 8

A pizza is cut into 8 equal slices. The family eats 1 slice. What fraction of the pizza did they eat?

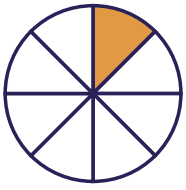

Back to School Math · 2

ANSWER

11:00

Back to School Math · 1

ANSWER

5

Back to School Math · 4

ANSWER

11:00

Back to School Math · 3

ANSWER

18

Back to School Math · 6

ANSWER

63

Back to School Math · 5

ANSWER

$$\frac{7}{12}$$

Back to School Math · 8

ANSWER

$$\frac{1}{8}$$

Back to School Math · 7

ANSWER

3

Back to School Math · 9

At the back-to-school picnic there are 7 tables. 8 people sit at each table. How many people are there?

Back to School Math · 10

A pizza is cut into 6 equal slices. The family eats 5 slices. What fraction of the pizza did they eat?

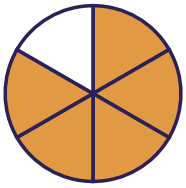

Back to School Math · 11

School starts at 9:30. Ella stays at school for 5 hours. What time does Ella leave?



Back to School Math · 12

Zoe shares 63 granola bars equally among 7 friends. How many granola bars does each friend get?

Back to School Math · 13

Lily shares 12 oatmeal cookies equally among 6 friends. How many oatmeal cookies does each friend get?

Back to School Math · 14

School starts at 9:30. Ben stays at school for 3 hours. What time does Ben leave?



Back to School Math · 15

At the back-to-school picnic there are 4 tables. 2 people sit at each table. How many people are there?

Back to School Math · 16

A pizza is cut into 12 equal slices. The family eats 1 slice. What fraction of the pizza did they eat?



Back to School Math · 10

ANSWER

$\frac{5}{6}$

Back to School Math · 9

ANSWER

56

Back to School Math · 12

ANSWER

9

Back to School Math · 11

ANSWER

2:30

Back to School Math · 14

ANSWER

12:30

Back to School Math · 13

ANSWER

2

Back to School Math · 16

ANSWER

$\frac{1}{12}$

Back to School Math · 15

ANSWER

8

Back to School Math · 17

At the back-to-school picnic there are 4 tables. 5 people sit at each table. How many people are there?

Back to School Math · 18

At the back-to-school picnic there are 2 tables. 2 people sit at each table. How many people are there?

Back to School Math · 19

Lily shares 28 granola bars equally among 4 friends. How many granola bars does each friend get?

Back to School Math · 20

A pizza is cut into 8 equal slices. The family eats 3 slices. What fraction of the pizza did they eat?

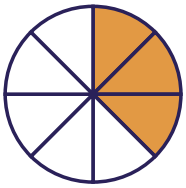

Back to School Math · 21

Noah shares 40 muffins equally among 4 friends. How many muffins does each friend get?

Back to School Math · 22

School starts at 9:30. Noah stays at school for 5 hours. What time does Noah leave?



Back to School Math · 23

School starts at 8:00. Sam stays at school for 5 hours. What time does Sam leave?



Back to School Math · 24

At the back-to-school picnic there are 8 tables. 6 people sit at each table. How many people are there?

Back to School Math · 18

ANSWER

4

Back to School Math · 17

ANSWER

20

Back to School Math · 20

ANSWER

$$\frac{3}{8}$$

Back to School Math · 19

ANSWER

7

Back to School Math · 22

ANSWER

2:30

Back to School Math · 21

ANSWER

10

Back to School Math · 24

ANSWER

48

Back to School Math · 23

ANSWER

1:00