Back to School Math · 1

Omar shares 16 granola bars equally among 2 friends. How many granola bars does each friend get?

Back to School Math · 2

School starts at 8:30. Sam stays at school for 2 hours. What time does Sam leave?



Back to School Math · 3

At the back-to-school picnic there are 7 tables. 7 people sit at each table. How many people are there?

Back to School Math · 4

A pizza is cut into 10 equal slices. The family eats 3 slices. What fraction of the pizza did they eat?

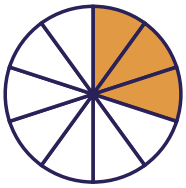

Back to School Math · 5

A pizza is cut into 6 equal slices. The family eats 1 slice. What fraction of the pizza did they eat?

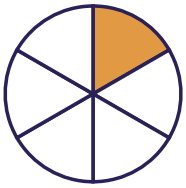

Back to School Math · 6

Zoe shares 9 granola bars equally among 3 friends. How many granola bars does each friend get?

Back to School Math · 7

School starts at 8:00. Ava stays at school for 5 hours. What time does Ava leave?



Back to School Math · 8

At the back-to-school picnic there are 8 tables. 4 people sit at each table. How many people are there?

Back to School Math · 2

ANSWER

10:30

Back to School Math · 1

ANSWER

8

Back to School Math · 4

ANSWER

$$\frac{3}{10}$$

Back to School Math · 3

ANSWER

49

Back to School Math · 6

ANSWER

3

Back to School Math · 5

ANSWER

$$\frac{1}{6}$$

Back to School Math · 8

ANSWER

32

Back to School Math · 7

ANSWER

1:00

Back to School Math · 9

School starts at 8:00. Noah stays at school for 2 hours. What time does Noah leave?



Back to School Math · 10

At the back-to-school picnic there are 5 tables. 2 people sit at each table. How many people are there?

Back to School Math · 11

School starts at 8:00. Ella stays at school for 2 hours. What time does Ella leave?



Back to School Math · 12

Leo shares 36 granola bars equally among 9 friends. How many granola bars does each friend get?

Back to School Math · 13

A pizza is cut into 6 equal slices. The family eats 5 slices. What fraction of the pizza did they eat?

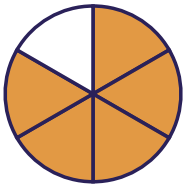

Back to School Math · 14

A pizza is cut into 12 equal slices. The family eats 7 slices. What fraction of the pizza did they eat?

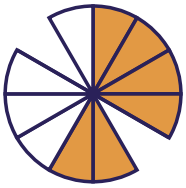

Back to School Math · 15

At the back-to-school picnic there are 9 tables. 3 people sit at each table. How many people are there?

Back to School Math · 16

Omar shares 24 granola bars equally among 3 friends. How many granola bars does each friend get?

Back to School Math · 10

ANSWER

10

Back to School Math · 9

ANSWER

10:00

Back to School Math · 12

ANSWER

4

Back to School Math · 11

ANSWER

10:00

Back to School Math · 14

ANSWER

$$\frac{7}{12}$$

Back to School Math · 13

ANSWER

$$\frac{5}{6}$$

Back to School Math · 16

ANSWER

8

Back to School Math · 15

ANSWER

27

Back to School Math · 17

A pizza is cut into 8 equal slices. The family eats 5 slices. What fraction of the pizza did they eat?

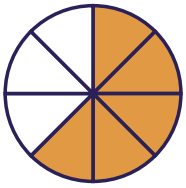

Back to School Math · 18

Zoe shares 50 muffins equally among 5 friends. How many muffins does each friend get?

Back to School Math · 19

School starts at 8:30. Ella stays at school for 4 hours. What time does Ella leave?



Back to School Math · 20

School starts at 9:00. Sam stays at school for 4 hours. What time does Sam leave?



Back to School Math · 21

Sam shares 63 oatmeal cookies equally among 9 friends. How many oatmeal cookies does each friend get?

Back to School Math · 22

At the back-to-school picnic there are 4 tables. 10 people sit at each table. How many people are there?

Back to School Math · 23

A pizza is cut into 12 equal slices. The family eats 11 slices. What fraction of the pizza did they eat?

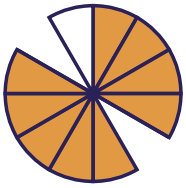

Back to School Math · 24

At the back-to-school picnic there are 2 tables. 3 people sit at each table. How many people are there?

Back to School Math · 18

ANSWER

10

Back to School Math · 17

ANSWER

$$\frac{5}{8}$$

Back to School Math · 20

ANSWER

1:00

Back to School Math · 19

ANSWER

12:30

Back to School Math · 22

ANSWER

40

Back to School Math · 21

ANSWER

7

Back to School Math · 24

ANSWER

6

Back to School Math · 23

ANSWER

$$\frac{11}{12}$$