Back to School Math · 1

A pizza is cut into 4 equal slices. The family eats 3 slices. What fraction of the pizza did they eat?



Back to School Math · 2

At the back-to-school picnic there are 4 tables. 2 people sit at each table. How many people are there?

Back to School Math · 3

A pizza is cut into 8 equal slices. The family eats 7 slices. What fraction of the pizza did they eat?

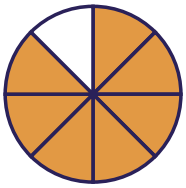

Back to School Math · 4

Leo shares 4 muffins equally among 2 friends. How many muffins does each friend get?

Back to School Math · 5

At the back-to-school picnic there are 7 tables. 3 people sit at each table. How many people are there?

Back to School Math · 6

School starts at 8:00. Leo stays at school for 4 hours. What time does Leo leave?



Back to School Math · 7

School starts at 9:00. Ben stays at school for 2 hours. What time does Ben leave?



Back to School Math · 8

Sam shares 30 granola bars equally among 6 friends. How many granola bars does each friend get?

Back to School Math · 2

ANSWER

8

Back to School Math · 1

ANSWER

$\frac{3}{4}$

Back to School Math · 4

ANSWER

2

Back to School Math · 3

ANSWER

$\frac{7}{8}$

Back to School Math · 6

ANSWER

12:00

Back to School Math · 5

ANSWER

21

Back to School Math · 8

ANSWER

5

Back to School Math · 7

ANSWER

11:00

Back to School Math · 9

Lily shares 12 granola bars equally among 2 friends. How many granola bars does each friend get?

Back to School Math · 10

A pizza is cut into 8 equal slices. The family eats 1 slice. What fraction of the pizza did they eat?

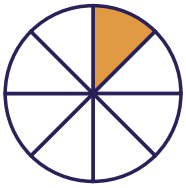

Back to School Math · 11

At the back-to-school picnic there are 6 tables. 2 people sit at each table. How many people are there?

Back to School Math · 12

Sam shares 10 granola bars equally among 5 friends. How many granola bars does each friend get?

Back to School Math · 13

School starts at 9:00. Lily stays at school for 4 hours. What time does Lily leave?



Back to School Math · 14

School starts at 8:00. Noah stays at school for 5 hours. What time does Noah leave?



Back to School Math · 15

Lily shares 12 oatmeal cookies equally among 2 friends. How many oatmeal cookies does each friend get?

Back to School Math · 16

Sam shares 6 muffins equally among 3 friends. How many muffins does each friend get?

Back to School Math · 10

ANSWER

$\frac{1}{8}$

Back to School Math · 9

ANSWER

6

Back to School Math · 12

ANSWER

2

Back to School Math · 11

ANSWER

12

Back to School Math · 14

ANSWER

1:00

Back to School Math · 13

ANSWER

1:00

Back to School Math · 16

ANSWER

2

Back to School Math · 15

ANSWER

6

Back to School Math · 17

A pizza is cut into 6 equal slices. The family eats 5 slices. What fraction of the pizza did they eat?

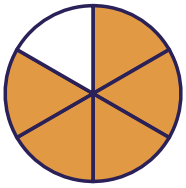

Back to School Math · 18

School starts at 9:00. Leo stays at school for 4 hours. What time does Leo leave?



Back to School Math · 19

At the back-to-school picnic there are 9 tables. 7 people sit at each table. How many people are there?

Back to School Math · 20

At the back-to-school picnic there are 3 tables. 2 people sit at each table. How many people are there?

Back to School Math · 21

School starts at 8:00. Ava stays at school for 3 hours. What time does Ava leave?



Back to School Math · 22

At the back-to-school picnic there are 3 tables. 3 people sit at each table. How many people are there?

Back to School Math · 23

At the back-to-school picnic there are 5 tables. 3 people sit at each table. How many people are there?

Back to School Math · 24

Omar shares 6 muffins equally among 3 friends. How many muffins does each friend get?

Back to School Math · 18

ANSWER

1:00

Back to School Math · 17

ANSWER

$$\frac{5}{6}$$

Back to School Math · 20

ANSWER

6

Back to School Math · 19

ANSWER

63

Back to School Math · 22

ANSWER

9

Back to School Math · 21

ANSWER

11:00

Back to School Math · 24

ANSWER

2

Back to School Math · 23

ANSWER

15