Task card 1 Area: Unit Squares & Multiplying

What is the area of the shape in square units?

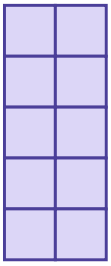

Task card 2 Area: Unit Squares & Multiplying

What is the area of the rectangle in square meters?

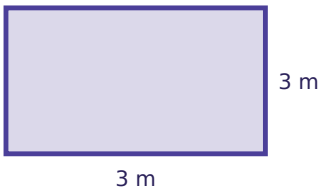

Task card 3 Area: Unit Squares & Multiplying

The area of the rectangle is 90 square inches. How long is the side marked ?

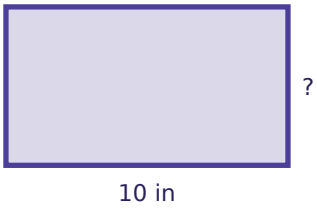

Task card 4 Area: Unit Squares & Multiplying

What is the area of the shape in square units?

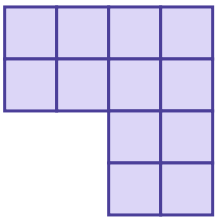

Task card 5 Area: Unit Squares & Multiplying

A patio is 11 inches long and 8 inches wide. What is its area in square inches?

Task card 6 Area: Unit Squares & Multiplying

Unit squares are being laid to cover the whole rectangle. Only some are drawn. What is the area of the whole rectangle in square units?

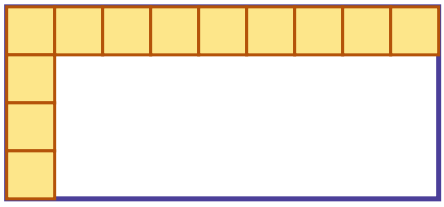

Task card 7 Area: Unit Squares & Multiplying

The area of the rectangle is 18 square meters. How long is the side marked ?

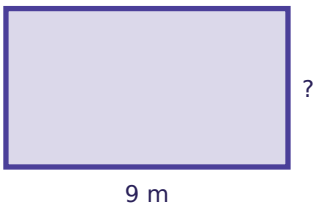

Task card 8 Area: Unit Squares & Multiplying

What is the area of the shape in square units?



Task card 9 Area: Unit Squares & Multiplying

What is the area of the rectangle in square feet?

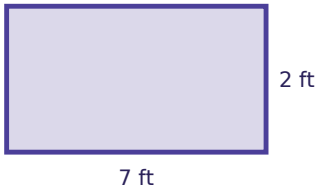

Task card 10 Area: Unit Squares & Multiplying

The area of the rectangle is 24 square feet. How long is the side marked ?

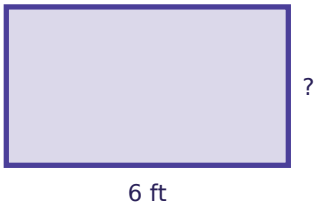

Task card 11 Area: Unit Squares & Multiplying

What is the area of the shape in square units?

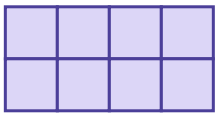

Task card 12 Area: Unit Squares & Multiplying

A playground is 11 meters long and 8 meters wide. What is its area in square meters?

Task card 13 Area: Unit Squares & Multiplying

Unit squares are being laid to cover the whole rectangle. Only some are drawn. What is the area of the whole rectangle in square units?

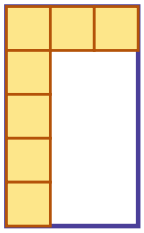

Task card 14 Area: Unit Squares & Multiplying

The area of the rectangle is 32 square feet. How long is the side marked ?



Task card 15 Area: Unit Squares & Multiplying

What is the area of the shape in square units?

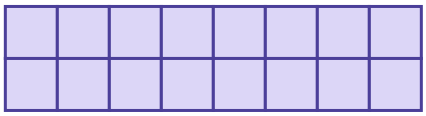

Task card 16 Area: Unit Squares & Multiplying

Unit squares are being laid to cover the whole rectangle. Only some are drawn. What is the area of the whole rectangle in square units?

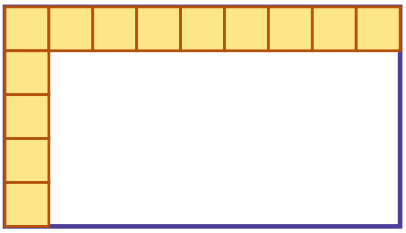

Task card 17 Area: Unit Squares & Multiplying

What is the area of the rectangle in square inches?

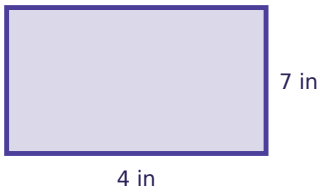

Task card 18 Area: Unit Squares & Multiplying

The area of the rectangle is 15 square meters. How long is the side marked ?



Task card 19 Area: Unit Squares & Multiplying

What is the area of the shape in square units?



Task card 20 Area: Unit Squares & Multiplying

A poster is 7 centimeters long and 9 centimeters wide. What is its area in square centimeters?

Task card 21 Area: Unit Squares & Multiplying

The area of the rectangle is 12 square inches. How long is the side marked ?

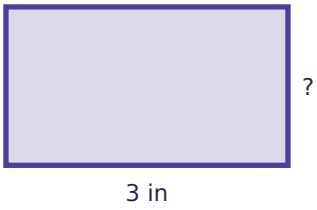

Task card 22 Area: Unit Squares & Multiplying

What is the area of the shape in square units?

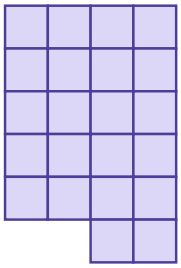

Task card 23 Area: Unit Squares & Multiplying

Unit squares are being laid to cover the whole rectangle. Only some are drawn. What is the area of the whole rectangle in square units?

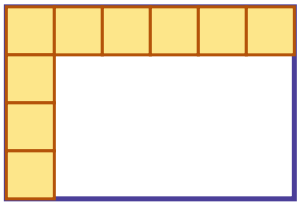

Task card 24 Area: Unit Squares & Multiplying

What is the area of the rectangle in square centimeters?

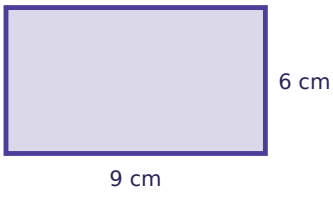

Area: Unit Squares & Multiplying Task Cards

Recording sheet · Grade 3 · Find each area. Each small square is 1 square unit.

Name: _____ Date: _____

Scan to check your answers

1	2	3	4
5	6	7	8
9	10	11	12
13	14	15	16
17	18	19	20
21	22	23	24

Area: Unit Squares & Multiplying Task Cards: Answer Key

Grade 3 · Hard

The answers online

1. 10	**2.** 9	**3.** 9
4. 12	**5.** 88	**6.** 36
7. 2	**8.** 18	**9.** 14
10. 4	**11.** 8	**12.** 88
13. 15	**14.** 8	**15.** 16
16. 45	**17.** 28	**18.** 3
19. 16	**20.** 63	**21.** 4
22. 22	**23.** 24	**24.** 54