Task card 1 Area: Unit Squares & Multiplying

What is the area of the shape in square units?



Task card 2 Area: Unit Squares & Multiplying

Unit squares are being laid to cover the whole rectangle. Only some are drawn. What is the area of the whole rectangle in square units?

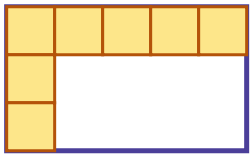

Task card 3 Area: Unit Squares & Multiplying

What is the area of the shape in square units?

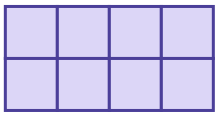

Task card 4 Area: Unit Squares & Multiplying

Unit squares are being laid to cover the whole rectangle. Only some are drawn. What is the area of the whole rectangle in square units?

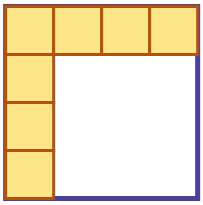

Task card 5 Area: Unit Squares & Multiplying

What is the area of the shape in square units?



Task card 6 Area: Unit Squares & Multiplying

What is the area of the rectangle in square centimeters?

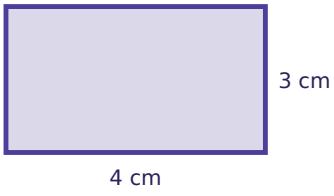

Task card 7 Area: Unit Squares & Multiplying

Unit squares are being laid to cover the whole rectangle. Only some are drawn. What is the area of the whole rectangle in square units?

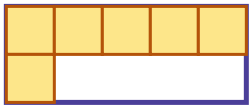

Task card 8 Area: Unit Squares & Multiplying

What is the area of the shape in square units?

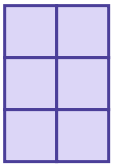

Task card 9 Area: Unit Squares & Multiplying

What is the area of the shape in square units?



Task card 10 Area: Unit Squares & Multiplying

Unit squares are being laid to cover the whole rectangle. Only some are drawn. What is the area of the whole rectangle in square units?

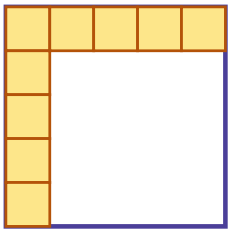

Task card 11 Area: Unit Squares & Multiplying

What is the area of the shape in square units?

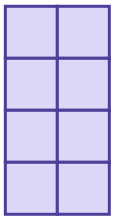

Task card 12 Area: Unit Squares & Multiplying

What is the area of the shape in square units?

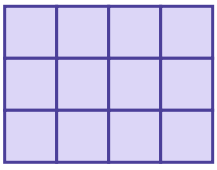

Task card 13 Area: Unit Squares & Multiplying

What is the area of the rectangle in square feet?



Task card 14 Area: Unit Squares & Multiplying

Unit squares are being laid to cover the whole rectangle. Only some are drawn. What is the area of the whole rectangle in square units?

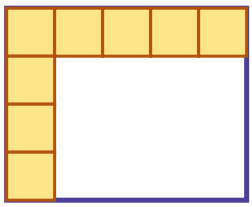

Task card 15 Area: Unit Squares & Multiplying

Unit squares are being laid to cover the whole rectangle. Only some are drawn. What is the area of the whole rectangle in square units?

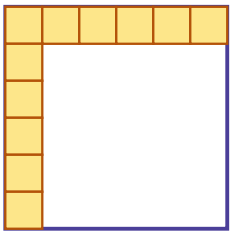

Task card 16 Area: Unit Squares & Multiplying

What is the area of the rectangle in square feet?

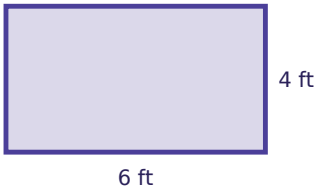

Task card 17 Area: Unit Squares & Multiplying

The area of the rectangle is 18 square meters. How long is the side marked ?

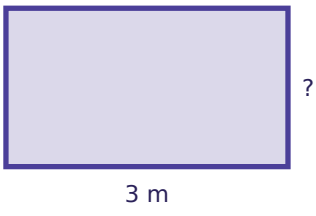

Task card 18 Area: Unit Squares & Multiplying

What is the area of the shape in square units?

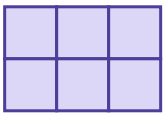

Task card 19 Area: Unit Squares & Multiplying

A rug is 3 inches long and 3 inches wide. What is its area in square inches?

Task card 20 Area: Unit Squares & Multiplying

Unit squares are being laid to cover the whole rectangle. Only some are drawn. What is the area of the whole rectangle in square units?

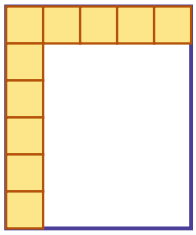

Task card 21 Area: Unit Squares & Multiplying

The area of the rectangle is 18 square inches. How long is the side marked ?

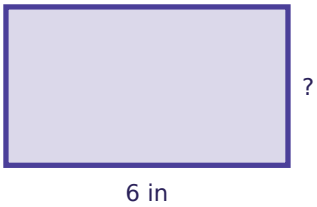

Task card 22 Area: Unit Squares & Multiplying

Unit squares are being laid to cover the whole rectangle. Only some are drawn. What is the area of the whole rectangle in square units?

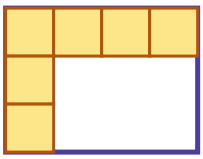

Task card 23 Area: Unit Squares & Multiplying

Unit squares are being laid to cover the whole rectangle. Only some are drawn. What is the area of the whole rectangle in square units?

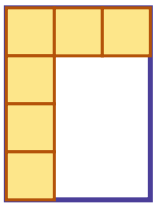

Task card 24 Area: Unit Squares & Multiplying

What is the area of the rectangle in square inches?

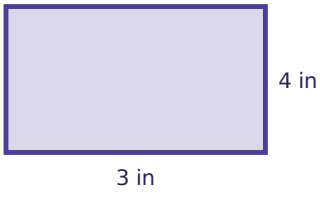

Area: Unit Squares & Multiplying Task Cards

Recording sheet · Grade 3 · Find each area. Each small square is 1 square unit.

Name: _____ Date: _____

Scan to check your answers

1	2	3	4
5	6	7	8
9	10	11	12
13	14	15	16
17	18	19	20
21	22	23	24

Area: Unit Squares & Multiplying Task Cards: Answer Key

Grade 3 · Easy

The answers online

1. 9	**2.** 15	**3.** 8
4. 16	**5.** 4	**6.** 12
7. 10	**8.** 6	**9.** 16
10. 25	**11.** 8	**12.** 12
13. 28	**14.** 20	**15.** 36
16. 24	**17.** 6	**18.** 6
19. 9	**20.** 30	**21.** 3
22. 12	**23.** 12	**24.** 12