Area: Unit Squares & Multiplying · 1

What is the area of the shape in square units?

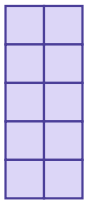

Area: Unit Squares & Multiplying · 2

What is the area of the rectangle in square meters?

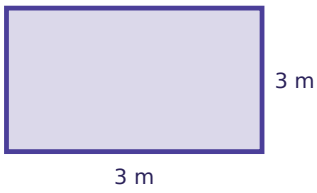

Area: Unit Squares & Multiplying · 3

The area of the rectangle is 90 square inches. How long is the side marked ?

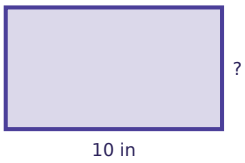

Area: Unit Squares & Multiplying · 4

What is the area of the shape in square units?

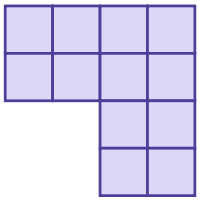

Area: Unit Squares & Multiplying · 5

A patio is 11 inches long and 8 inches wide. What is its area in square inches?

Area: Unit Squares & Multiplying · 6

Unit squares are being laid to cover the whole rectangle. Only some are drawn. What is the area of the whole rectangle in square units?

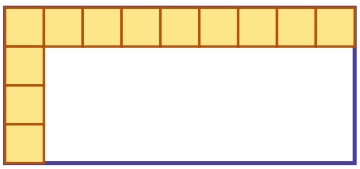

Area: Unit Squares & Multiplying · 7

The area of the rectangle is 18 square meters. How long is the side marked ?



Area: Unit Squares & Multiplying · 8

What is the area of the shape in square units?

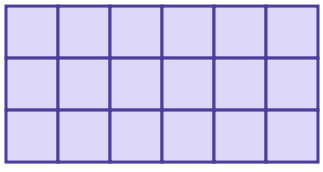

Area: Unit Squares & Multiplying · 2

ANSWER

9

Area: Unit Squares & Multiplying · 1

ANSWER

10

Area: Unit Squares & Multiplying · 4

ANSWER

12

Area: Unit Squares & Multiplying · 3

ANSWER

9

Area: Unit Squares & Multiplying · 6

ANSWER

36

Area: Unit Squares & Multiplying · 5

ANSWER

88

Area: Unit Squares & Multiplying · 8

ANSWER

18

Area: Unit Squares & Multiplying · 7

ANSWER

2

Area: Unit Squares & Multiplying · 9

What is the area of the rectangle in square feet?



Area: Unit Squares & Multiplying · 10

The area of the rectangle is 24 square feet. How long is the side marked ?

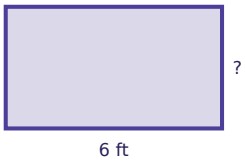

Area: Unit Squares & Multiplying · 11

What is the area of the shape in square units?

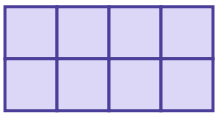

Area: Unit Squares & Multiplying · 12

A playground is 11 meters long and 8 meters wide. What is its area in square meters?

Area: Unit Squares & Multiplying · 13

Unit squares are being laid to cover the whole rectangle. Only some are drawn. What is the area of the whole rectangle in square units?

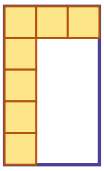

Area: Unit Squares & Multiplying · 14

The area of the rectangle is 32 square feet. How long is the side marked ?

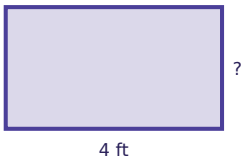

Area: Unit Squares & Multiplying · 15

What is the area of the shape in square units?



Area: Unit Squares & Multiplying · 16

Unit squares are being laid to cover the whole rectangle. Only some are drawn. What is the area of the whole rectangle in square units?

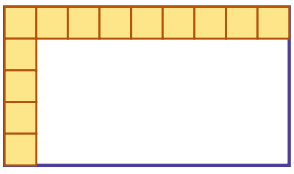

Area: Unit Squares & Multiplying · 10

ANSWER

4

Area: Unit Squares & Multiplying · 9

ANSWER

14

Area: Unit Squares & Multiplying · 12

ANSWER

88

Area: Unit Squares & Multiplying · 11

ANSWER

8

Area: Unit Squares & Multiplying · 14

ANSWER

8

Area: Unit Squares & Multiplying · 13

ANSWER

15

Area: Unit Squares & Multiplying · 16

ANSWER

45

Area: Unit Squares & Multiplying · 15

ANSWER

16

Area: Unit Squares & Multiplying · 17

What is the area of the rectangle in square inches?

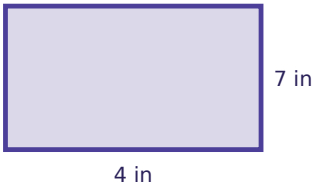

Area: Unit Squares & Multiplying · 18

The area of the rectangle is 15 square meters. How long is the side marked ?

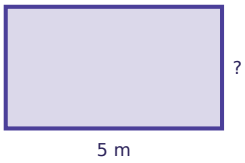

Area: Unit Squares & Multiplying · 19

What is the area of the shape in square units?

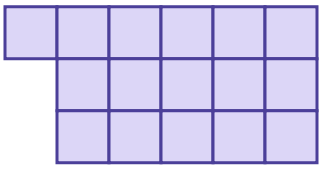

Area: Unit Squares & Multiplying · 20

A poster is 7 centimeters long and 9 centimeters wide. What is its area in square centimeters?

Area: Unit Squares & Multiplying · 21

The area of the rectangle is 12 square inches. How long is the side marked ?

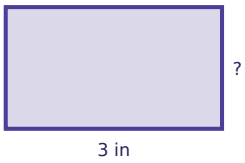

Area: Unit Squares & Multiplying · 22

What is the area of the shape in square units?

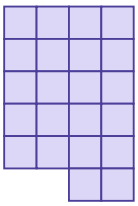

Area: Unit Squares & Multiplying · 23

Unit squares are being laid to cover the whole rectangle. Only some are drawn. What is the area of the whole rectangle in square units?

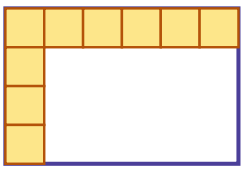

Area: Unit Squares & Multiplying · 24

What is the area of the rectangle in square centimeters?

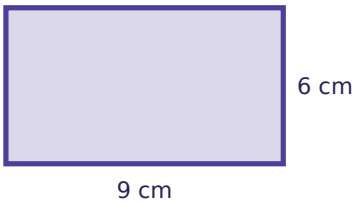

Area: Unit Squares & Multiplying · 18

ANSWER

3

Area: Unit Squares & Multiplying · 17

ANSWER

28

Area: Unit Squares & Multiplying · 20

ANSWER

63

Area: Unit Squares & Multiplying · 19

ANSWER

16

Area: Unit Squares & Multiplying · 22

ANSWER

22

Area: Unit Squares & Multiplying · 21

ANSWER

4

Area: Unit Squares & Multiplying · 24

ANSWER

54

Area: Unit Squares & Multiplying · 23

ANSWER

24