Area: Unit Squares & Multiplying · 1

What is the area of the shape in square units?

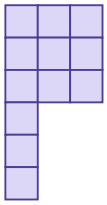

Area: Unit Squares & Multiplying · 2

Unit squares are being laid to cover the whole rectangle. Only some are drawn. What is the area of the whole rectangle in square units?

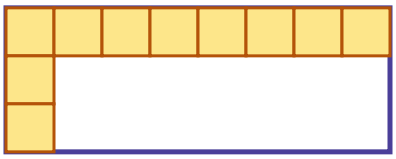

Area: Unit Squares & Multiplying · 3

What is the area of the rectangle in square feet?



Area: Unit Squares & Multiplying · 4

The area of the rectangle is 20 square feet. How long is the side marked ?

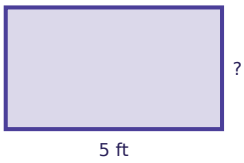

Area: Unit Squares & Multiplying · 5

What is the area of the shape in square units?

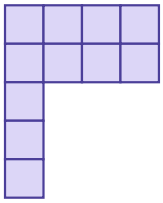

Area: Unit Squares & Multiplying · 6

A poster is 7 inches long and 7 inches wide. What is its area in square inches?

Area: Unit Squares & Multiplying · 7

Unit squares are being laid to cover the whole rectangle. Only some are drawn. What is the area of the whole rectangle in square units?

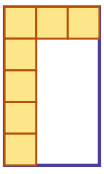

Area: Unit Squares & Multiplying · 8

The area of the rectangle is 32 square meters. How long is the side marked ?

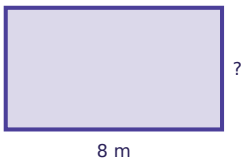

Area: Unit Squares & Multiplying · 2

ANSWER

24

Area: Unit Squares & Multiplying · 1

ANSWER

12

Area: Unit Squares & Multiplying · 4

ANSWER

4

Area: Unit Squares & Multiplying · 3

ANSWER

18

Area: Unit Squares & Multiplying · 6

ANSWER

49

Area: Unit Squares & Multiplying · 5

ANSWER

11

Area: Unit Squares & Multiplying · 8

ANSWER

4

Area: Unit Squares & Multiplying · 7

ANSWER

15

Area: Unit Squares & Multiplying · 9

What is the area of the shape in square units?

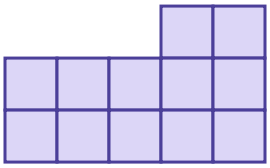

Area: Unit Squares & Multiplying · 10

Unit squares are being laid to cover the whole rectangle. Only some are drawn. What is the area of the whole rectangle in square units?

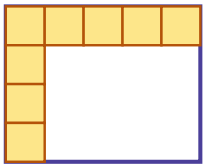

Area: Unit Squares & Multiplying · 11

What is the area of the rectangle in square meters?



Area: Unit Squares & Multiplying · 12

The area of the rectangle is 16 square meters. How long is the side marked ?

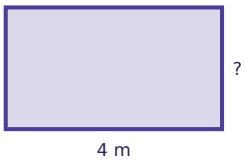

Area: Unit Squares & Multiplying · 13

What is the area of the shape in square units?

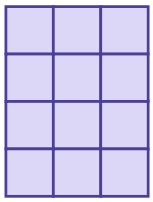

Area: Unit Squares & Multiplying · 14

A garden is 3 meters long and 4 meters wide. What is its area in square meters?

Area: Unit Squares & Multiplying · 15

Unit squares are being laid to cover the whole rectangle. Only some are drawn. What is the area of the whole rectangle in square units?

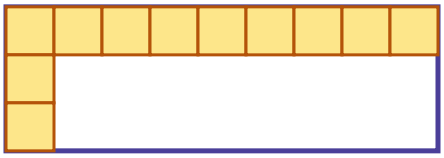

Area: Unit Squares & Multiplying · 16

The area of the rectangle is 45 square centimeters. How long is the side marked ?

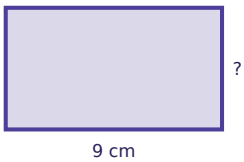

Area: Unit Squares & Multiplying · 10

ANSWER

20

Area: Unit Squares & Multiplying · 9

ANSWER

12

Area: Unit Squares & Multiplying · 12

ANSWER

4

Area: Unit Squares & Multiplying · 11

ANSWER

42

Area: Unit Squares & Multiplying · 14

ANSWER

12

Area: Unit Squares & Multiplying · 13

ANSWER

12

Area: Unit Squares & Multiplying · 16

ANSWER

5

Area: Unit Squares & Multiplying · 15

ANSWER

27

Area: Unit Squares & Multiplying · 17

What is the area of the shape in square units?



Area: Unit Squares & Multiplying · 18

Unit squares are being laid to cover the whole rectangle. Only some are drawn. What is the area of the whole rectangle in square units?

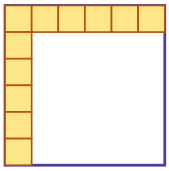

Area: Unit Squares & Multiplying · 19

What is the area of the rectangle in square feet?



Area: Unit Squares & Multiplying · 20

The area of the rectangle is 90 square meters. How long is the side marked ?



Area: Unit Squares & Multiplying · 21

What is the area of the shape in square units?

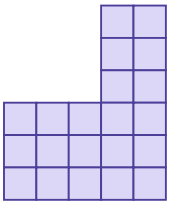

Area: Unit Squares & Multiplying · 22

A patio is 4 inches long and 3 inches wide. What is its area in square inches?

Area: Unit Squares & Multiplying · 23

Unit squares are being laid to cover the whole rectangle. Only some are drawn. What is the area of the whole rectangle in square units?

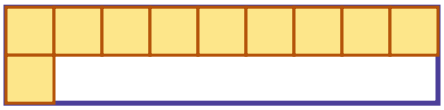

Area: Unit Squares & Multiplying · 24

The area of the rectangle is 18 square centimeters. How long is the side marked ?



Area: Unit Squares & Multiplying · 18

ANSWER

36

Area: Unit Squares & Multiplying · 17

ANSWER

12

Area: Unit Squares & Multiplying · 20

ANSWER

9

Area: Unit Squares & Multiplying · 19

ANSWER

36

Area: Unit Squares & Multiplying · 22

ANSWER

12

Area: Unit Squares & Multiplying · 21

ANSWER

21

Area: Unit Squares & Multiplying · 24

ANSWER

6

Area: Unit Squares & Multiplying · 23

ANSWER

18