Task card 1 Area & Perimeter

Find the area of a rectangle with length 9 and width 6.

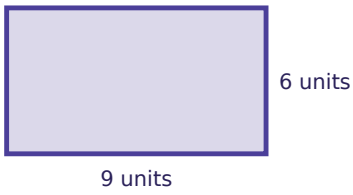

Task card 2 Area & Perimeter

Find the perimeter of a rectangle with length 9 and width 2.

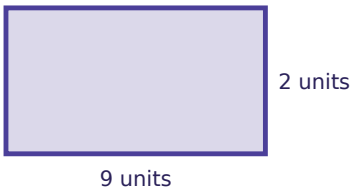

Task card 3 Area & Perimeter

Find the area of a rectangle with length 2 and width 8.

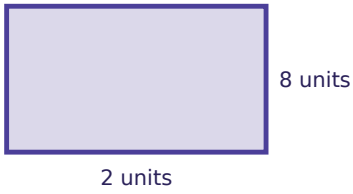

Task card 4 Area & Perimeter

Find the perimeter of a rectangle with length 5 and width 6.

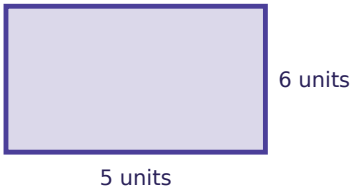

Task card 5 Area & Perimeter

Find the area of a rectangle with length 10 and width 9.

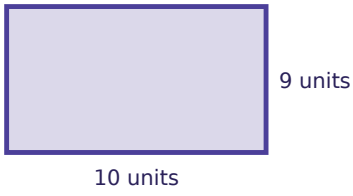

Task card 6 Area & Perimeter

Find the perimeter of a rectangle with length 10 and width 10.



Task card 7 Area & Perimeter

Find the area of a rectangle with length 7 and width 3.



Task card 8 Area & Perimeter

Find the perimeter of a rectangle with length 10 and width 8.



Task card 9 Area & Perimeter

Find the area of a rectangle with length 4 and width 2.



Task card 10 Area & Perimeter

Find the perimeter of a rectangle with length 2 and width 11.



Task card 11 Area & Perimeter

Find the area of a rectangle with length 2 and width 6.



Task card 12 Area & Perimeter

Find the perimeter of a rectangle with length 5 and width 4.



Task card 13 Area & Perimeter

Find the area of a rectangle with length 9 and width 4.



Task card 14 Area & Perimeter

Find the perimeter of a rectangle with length 11 and width 8.



Task card 15 Area & Perimeter

Find the area of a rectangle with length 10 and width 7.



Task card 16 Area & Perimeter

Find the perimeter of a rectangle with length 4 and width 8.



Task card 17 Area & Perimeter

Find the area of a rectangle with length 4 and width 10.



Task card 18 Area & Perimeter

Find the perimeter of a rectangle with length 8 and width 3.



Task card 19 Area & Perimeter

Find the area of a rectangle with length 8 and width 10.



Task card 20 Area & Perimeter

Find the perimeter of a rectangle with length 8 and width 8.



Task card 21 Area & Perimeter

Find the area of a rectangle with length 2 and width 3.



Task card 22 Area & Perimeter

Find the perimeter of a rectangle with length 6 and width 3.



Task card 23 Area & Perimeter

Find the area of a rectangle with length 9 and width 2.



Task card 24 Area & Perimeter

Find the perimeter of a rectangle with length 3 and width 3.



Area & Perimeter Task Cards

Recording sheet · Grade 3 · Solve each problem.

Name: _____ Date: _____

Scan to check your answers

1	2	3	4
5	6	7	8
9	10	11	12
13	14	15	16
17	18	19	20
21	22	23	24

Area & Perimeter Task Cards: Answer Key

Grade 3 · Hard

The answers online

1. 54	**2.** 22	**3.** 16
4. 22	**5.** 90	**6.** 40
7. 21	**8.** 36	**9.** 8
10. 26	**11.** 12	**12.** 18
13. 36	**14.** 38	**15.** 70
16. 24	**17.** 40	**18.** 22
19. 80	**20.** 32	**21.** 6
22. 18	**23.** 18	**24.** 12