Area & Perimeter · 1

Find the area of a rectangle with length 3 and width 4.

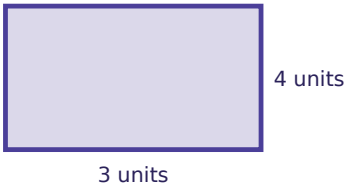

Area & Perimeter · 2

Find the perimeter of a rectangle with length 2 and width 2.



Area & Perimeter · 3

Find the area of a rectangle with length 3 and width 2.



Area & Perimeter · 4

Find the perimeter of a rectangle with length 4 and width 4.



Area & Perimeter · 5

Find the area of a rectangle with length 2 and width 4.



Area & Perimeter · 6

Find the perimeter of a rectangle with length 3 and width 4.



Area & Perimeter · 7

Find the area of a rectangle with length 4 and width 3.



Area & Perimeter · 8

Find the perimeter of a rectangle with length 4 and width 3.



Area & Perimeter · 2

ANSWER

8

Area & Perimeter · 1

ANSWER

12

Area & Perimeter · 4

ANSWER

16

Area & Perimeter · 3

ANSWER

6

Area & Perimeter · 6

ANSWER

14

Area & Perimeter · 5

ANSWER

8

Area & Perimeter · 8

ANSWER

14

Area & Perimeter · 7

ANSWER

12

Area & Perimeter · 9

Find the perimeter of a rectangle with length 5 and width 2.



Area & Perimeter · 10

Find the area of a rectangle with length 4 and width 4.



Area & Perimeter · 11

Find the perimeter of a rectangle with length 2 and width 5.



Area & Perimeter · 12

Find the area of a rectangle with length 3 and width 3.



Area & Perimeter · 13

Find the perimeter of a rectangle with length 5 and width 4.



Area & Perimeter · 14

Find the area of a rectangle with length 6 and width 4.



Area & Perimeter · 15

Find the perimeter of a rectangle with length 6 and width 5.



Area & Perimeter · 16

Find the area of a rectangle with length 5 and width 4.



Area & Perimeter · 10

ANSWER

16

Area & Perimeter · 9

ANSWER

14

Area & Perimeter · 12

ANSWER

9

Area & Perimeter · 11

ANSWER

14

Area & Perimeter · 14

ANSWER

24

Area & Perimeter · 13

ANSWER

18

Area & Perimeter · 16

ANSWER

20

Area & Perimeter · 15

ANSWER

22

Area & Perimeter · 17

Find the perimeter of a rectangle with length 2 and width 4.

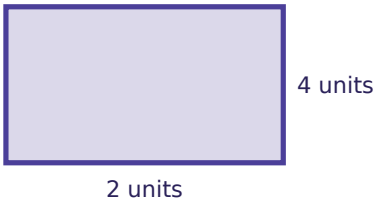

Area & Perimeter · 18

Find the area of a rectangle with length 2 and width 6.

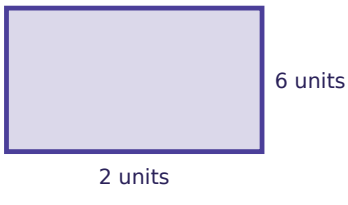

Area & Perimeter · 19

Find the area of a rectangle with length 4 and width 2.



Area & Perimeter · 20

Find the perimeter of a rectangle with length 5 and width 3.



Area & Perimeter · 21

Find the perimeter of a rectangle with length 3 and width 2.



Area & Perimeter · 22

Find the area of a rectangle with length 4 and width 6.



Area & Perimeter · 23

Find the perimeter of a rectangle with length 4 and width 6.



Area & Perimeter · 24

Find the area of a rectangle with length 6 and width 2.



Area & Perimeter · 18

ANSWER

12

Area & Perimeter · 17

ANSWER

12

Area & Perimeter · 20

ANSWER

16

Area & Perimeter · 19

ANSWER

8

Area & Perimeter · 22

ANSWER

24

Area & Perimeter · 21

ANSWER

10

Area & Perimeter · 24

ANSWER

12

Area & Perimeter · 23

ANSWER

20