**Task card 1** Area of Composite Figures

What is the area of the figure in square units?

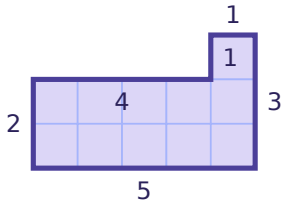


**Task card 2** Area of Composite Figures

What is the area of the figure in square units?

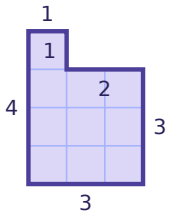


**Task card 3** Area of Composite Figures

What is the area of the figure in square units?

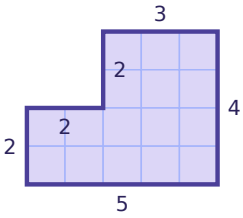


**Task card 4** Area of Composite Figures

Split the figure into two rectangles: one is 4 by 3 and the other is 1 by 2. 4 × 3 = 12 and 1 × 2 = 2. What is the area of the whole figure in square units?

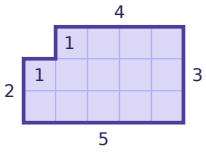


**Task card 5** Area of Composite Figures

Think of a rectangle that is 5 by 3. A corner that is 2 by 2 is cut out of it. 5 × 3 = 15 and 2 × 2 = 4. What is the area of the figure in square units?

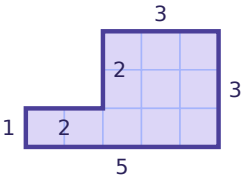


**Task card 6** Area of Composite Figures

Use the other sides to find the length of the side marked with a question mark.

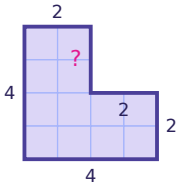

**Task card 7** Area of Composite Figures

A figure is made of two rectangles. Its area is 11 square units. One rectangle has an area of 9 square units. What is the area of the other rectangle?

**Task card 8** Area of Composite Figures

Two rectangles are joined to make one figure. One is 4 by 3 and the other is 1 by 1. They do not overlap. What is the area of the figure in square units?

**Task card 9** Area of Composite Figures

What is the area of the figure in square units?

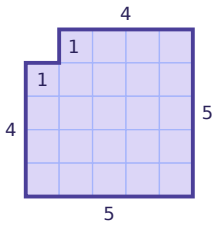


**Task card 10** Area of Composite Figures

What is the area of the figure in square units?

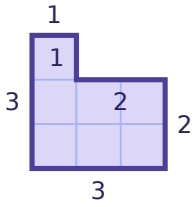


**Task card 11** Area of Composite Figures

What is the area of the figure in square units?

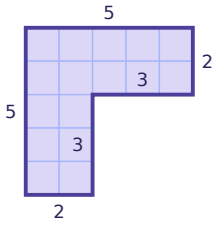


**Task card 12** Area of Composite Figures

Think of a rectangle that is 4 by 3. A corner that is 1 by 2 is cut out of it. 4 × 3 = 12 and 1 × 2 = 2. What is the area of the figure in square units?

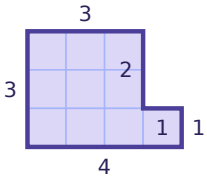

**Task card 13** Area of Composite Figures

Use the other sides to find the length of the side marked with a question mark.

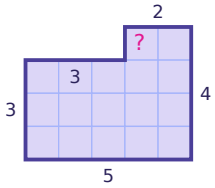


**Task card 14** Area of Composite Figures

A figure is made of two rectangles. Its area is 7 square units. One rectangle has an area of 5 square units. What is the area of the other rectangle?

**Task card 15** Area of Composite Figures

Two rectangles are joined to make one figure. One is 3 by 4 and the other is 1 by 1. They do not overlap. What is the area of the figure in square units?

**Task card 16** Area of Composite Figures

What is the area of the figure in square units?

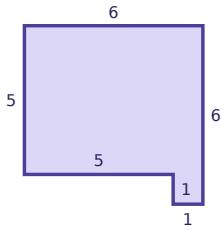


**Task card 17** Area of Composite Figures

What is the area of the figure in square units?

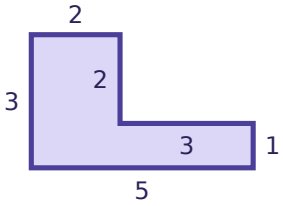


**Task card 18** Area of Composite Figures

What is the area of the figure in square units?

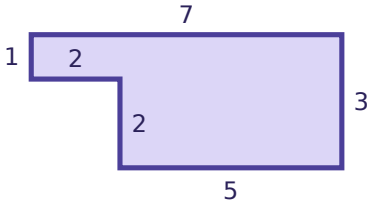

**Task card 19** Area of Composite Figures

Think of a rectangle that is 5 by 4. A corner that is 2 by 2 is cut out of it. 5 × 4 = 20 and 2 × 2 = 4. What is the area of the figure in square units?

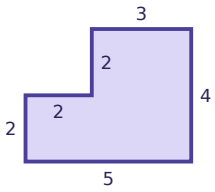


**Task card 20** Area of Composite Figures

Use the other sides to find the length of the side marked with a question mark.

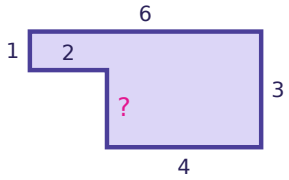


**Task card 21** Area of Composite Figures

A figure is made of two rectangles. Its area is 9 square units. One rectangle has an area of 6 square units. What is the area of the other rectangle?

**Task card 22** Area of Composite Figures

Two rectangles are joined to make one figure. One is 3 by 5 and the other is 2 by 4. They do not overlap. What is the area of the figure in square units?

**Task card 23** Area of Composite Figures

What is the area of the figure in square units?

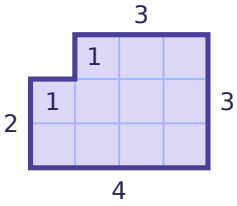


**Task card 24** Area of Composite Figures

What is the area of the figure in square units?

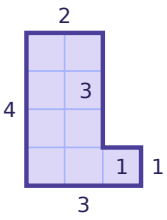

# Area of Composite Figures Task Cards

Recording sheet · Grade 3 · Find each area in square units. All corners are square corners. The same kind of figure comes in different questions.

Name: _____ Date: _____

Scan to check your answers

| | | | |
|---|---|---|---|
| 1 | 2 | 3 | 4 |
| 5 | 6 | 7 | 8 |
| 9 | 10 | 11 | 12 |
| 13 | 14 | 15 | 16 |
| 17 | 18 | 19 | 20 |
| 21 | 22 | 23 | 24 |

# Area of Composite Figures Task Cards: Answer Key

Grade 3 · Easy

The answers online

| | | |
|---|---|---|
| **1.** 11 | **2.** 10 | **3.** 16 |
| **4.** 14 | **5.** 11 | **6.** 2 |
| **7.** 2 | **8.** 13 | **9.** 24 |
| **10.** 7 | **11.** 16 | **12.** 10 |
| **13.** 1 | **14.** 2 | **15.** 13 |
| **16.** 31 | **17.** 9 | **18.** 17 |
| **19.** 16 | **20.** 2 | **21.** 3 |
| **22.** 23 | **23.** 11 | **24.** 9 |