Area of Composite Figures · 1

What is the area of the figure in square units?

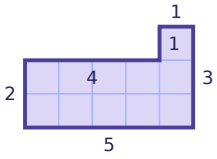


Area of Composite Figures · 2

What is the area of the figure in square units?

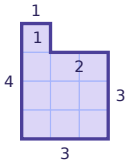


Area of Composite Figures · 3

What is the area of the figure in square units?

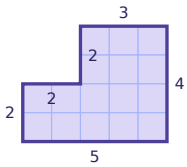


Area of Composite Figures · 4

Split the figure into two rectangles: one is 4 by 3 and the other is 1 by 2. 4 × 3 = 12 and 1 × 2 = 2. What is the area of the whole figure in square units?

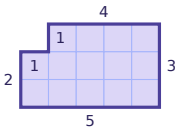


Area of Composite Figures · 5

Think of a rectangle that is 5 by 3. A corner that is 2 by 2 is cut out of it. 5 × 3 = 15 and 2 × 2 = 4. What is the area of the figure in square units?

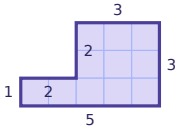


Area of Composite Figures · 6

Use the other sides to find the length of the side marked with a question mark.

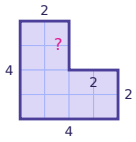


Area of Composite Figures · 7

A figure is made of two rectangles. Its area is 11 square units. One rectangle has an area of 9 square units. What is the area of the other rectangle?

Area of Composite Figures · 8

Two rectangles are joined to make one figure. One is 4 by 3 and the other is 1 by 1. They do not overlap. What is the area of the figure in square units?

Area of Composite Figures · 2

**ANSWER**

**10**

Area of Composite Figures · 1

**ANSWER**

**11**

Area of Composite Figures · 4

**ANSWER**

**14**

Area of Composite Figures · 3

**ANSWER**

**16**

Area of Composite Figures · 6

**ANSWER**

**2**

Area of Composite Figures · 5

**ANSWER**

**11**

Area of Composite Figures · 8

**ANSWER**

**13**

Area of Composite Figures · 7

**ANSWER**

**2**

Area of Composite Figures · 9

What is the area of the figure in square units?

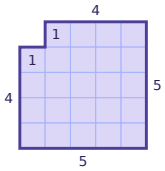


Area of Composite Figures · 10

What is the area of the figure in square units?

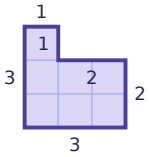


Area of Composite Figures · 11

What is the area of the figure in square units?

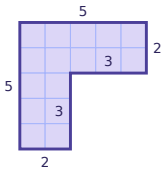


Area of Composite Figures · 12

Think of a rectangle that is 4 by 3. A corner that is 1 by 2 is cut out of it. 4 × 3 = 12 and 1 × 2 = 2. What is the area of the figure in square units?

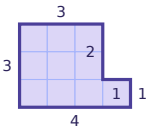


Area of Composite Figures · 13

Use the other sides to find the length of the side marked with a question mark.

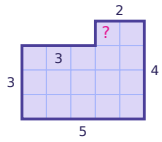


Area of Composite Figures · 14

A figure is made of two rectangles. Its area is 7 square units. One rectangle has an area of 5 square units. What is the area of the other rectangle?

Area of Composite Figures · 15

Two rectangles are joined to make one figure. One is 3 by 4 and the other is 1 by 1. They do not overlap. What is the area of the figure in square units?

Area of Composite Figures · 16

What is the area of the figure in square units?

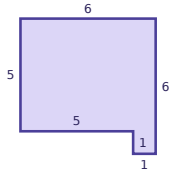

Area of Composite Figures · 10

**ANSWER**

# 7

Area of Composite Figures · 9

**ANSWER**

# 24

Area of Composite Figures · 12

**ANSWER**

# 10

Area of Composite Figures · 11

**ANSWER**

# 16

Area of Composite Figures · 14

**ANSWER**

# 2

Area of Composite Figures · 13

**ANSWER**

# 1

Area of Composite Figures · 16

**ANSWER**

# 31

Area of Composite Figures · 15

**ANSWER**

# 13

Area of Composite Figures · 17

What is the area of the figure in square units?

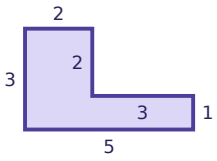


Area of Composite Figures · 18

What is the area of the figure in square units?

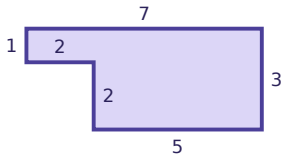


Area of Composite Figures · 19

Think of a rectangle that is 5 by 4. A corner that is 2 by 2 is cut out of it. 5 × 4 = 20 and 2 × 2 = 4. What is the area of the figure in square units?

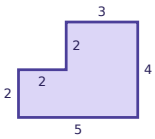


Area of Composite Figures · 20

Use the other sides to find the length of the side marked with a question mark.

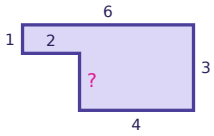


Area of Composite Figures · 21

A figure is made of two rectangles. Its area is 9 square units. One rectangle has an area of 6 square units. What is the area of the other rectangle?

Area of Composite Figures · 22

Two rectangles are joined to make one figure. One is 3 by 5 and the other is 2 by 4. They do not overlap. What is the area of the figure in square units?

Area of Composite Figures · 23

What is the area of the figure in square units?

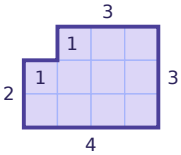


Area of Composite Figures · 24

What is the area of the figure in square units?

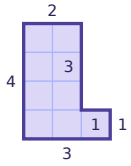

Area of Composite Figures · 18

**ANSWER**

**17**

Area of Composite Figures · 17

**ANSWER**

**9**

Area of Composite Figures · 20

**ANSWER**

**2**

Area of Composite Figures · 19

**ANSWER**

**16**

Area of Composite Figures · 22

**ANSWER**

**23**

Area of Composite Figures · 21

**ANSWER**

**3**

Area of Composite Figures · 24

**ANSWER**

**9**

Area of Composite Figures · 23

**ANSWER**

**11**