Task card 1 2-Digit × 1-Digit Multiplication (...

Multiply.

$$\begin{array}{r} 34 \\ \times\ 8 \\ \hline \end{array}$$

Task card 2 2-Digit × 1-Digit Multiplication (...

Multiply.

$$\begin{array}{r} 67 \\ \times\ 7 \\ \hline \end{array}$$

Task card 3 2-Digit × 1-Digit Multiplication (...

$7 \times 65 = ___$

Task card 4 2-Digit × 1-Digit Multiplication (...

The model breaks 76 into 70 and 6. Find the two parts and add them. $76 \times 6 = ___$

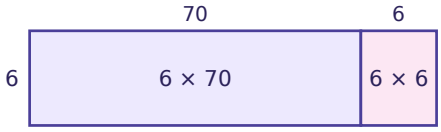

Task card 5 2-Digit × 1-Digit Multiplication (...

Break apart 79: $70 \times 9 = 630$ and $9 \times 9 = 81$. So $79 \times 9 = ___$

Task card 6 2-Digit × 1-Digit Multiplication (...

To find 53×9, multiply the tens first: $50 \times 9 = ___$

Task card 7 2-Digit × 1-Digit Multiplication (...

There are 9 shelves with 84 books on each shelf. How many books are there in all?

Task card 8 2-Digit × 1-Digit Multiplication (...

$72 \times ___ = 576$

Task card 9 2-Digit × 1-Digit Multiplication (...

Multiply.

$$\begin{array}{r} 65 \\ \times\ 6 \\ \hline \end{array}$$

Task card 10 2-Digit × 1-Digit Multiplication (...

Multiply.

$$\begin{array}{r} 54 \\ \times\ 6 \\ \hline \end{array}$$

Task card 11 2-Digit × 1-Digit Multiplication (...

$6 \times 92 = ___$

Task card 12 2-Digit × 1-Digit Multiplication (...

The model breaks 92 into 90 and 2. Find the two parts and add them. $92 \times 7 = ___$

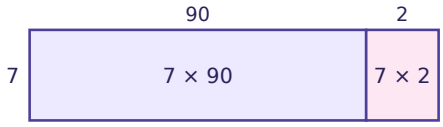

Task card 13 2-Digit × 1-Digit Multiplication (...

Break apart 85: 80 × 9 = 720 and 5 × 9 = 45. So 85 × 9 = ___

Task card 14 2-Digit × 1-Digit Multiplication (...

To find 68 × 8, multiply the tens first: 60 × 8 = ___

Task card 15 2-Digit × 1-Digit Multiplication (...

There are 6 teams with 68 players on each team. How many players are there in all?

Task card 16 2-Digit × 1-Digit Multiplication (...

94 × ___ = 658

Task card 17 2-Digit × 1-Digit Multiplication (...

Multiply.

$$\begin{array}{r} 59 \\ \times\ 6 \\ \hline \end{array}$$

Task card 18 2-Digit × 1-Digit Multiplication (...

Multiply.

$$\begin{array}{r} 88 \\ \times\ 9 \\ \hline \end{array}$$

Task card 19 2-Digit × 1-Digit Multiplication (...

$7 \times 58 = ___$

Task card 20 2-Digit × 1-Digit Multiplication (...

The model breaks 59 into 50 and 9. Find the two parts and add them. $59 \times 8 = ___$

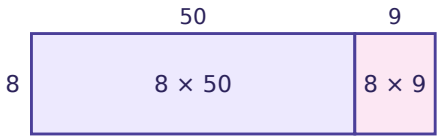

Task card 21 2-Digit × 1-Digit Multiplication (...

Break apart 53: $50 \times 9 = 450$ and $3 \times 9 = 27$. So $53 \times 9 = ___$

Task card 22 2-Digit × 1-Digit Multiplication (...

To find 52×8, multiply the tens first: $50 \times 8 = ___$

Task card 23 2-Digit × 1-Digit Multiplication (...

There are 7 teams with 25 players on each team. How many players are there in all?

Task card 24 2-Digit × 1-Digit Multiplication (...

$73 \times ___ = 657$

2-Digit × 1-Digit Multiplication (With Regrouping) Task Cards

Recording sheet · Grade 3 · Multiply. Every problem needs carrying. The same kind of product comes in different shapes.

Scan to check your answers

Name: _____ Date: _____

1	2	3	4
5	6	7	8
9	10	11	12
13	14	15	16
17	18	19	20
21	22	23	24

2-Digit × 1-Digit Multiplication (With Regrouping) Task Cards: Answer Key

Grade 3 · Hard

The answers online

1. 272	**2.** 469	**3.** 455
4. 456	**5.** 711	**6.** 450
7. 756	**8.** 8	**9.** 390
10. 324	**11.** 552	**12.** 644
13. 765	**14.** 480	**15.** 408
16. 7	**17.** 354	**18.** 792
19. 406	**20.** 472	**21.** 477
22. 400	**23.** 175	**24.** 9