Task card 1 2-Digit × 1-Digit Multiplication (...

Multiply.

$$\begin{array}{r} 78 \\ \times\ 3 \\ \hline \end{array}$$

Task card 2 2-Digit × 1-Digit Multiplication (...

Multiply.

$$\begin{array}{r} 68 \\ \times\ 5 \\ \hline \end{array}$$

Task card 3 2-Digit × 1-Digit Multiplication (...

$5 \times 47 = ___$

Task card 4 2-Digit × 1-Digit Multiplication (...

The model breaks 85 into 80 and 5. Find the two parts and add them. 85 × 5 = ___

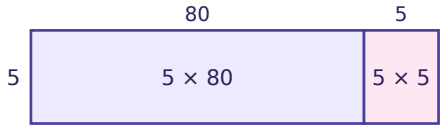

Task card 5 2-Digit × 1-Digit Multiplication (...

Break apart 34: 30 × 5 = 150 and 4 × 5 = 20. So 34 × 5 = ___

Task card 6 2-Digit × 1-Digit Multiplication (...

88 + 88 + 88 =

88 × 3 = ___

Task card 7 2-Digit × 1-Digit Multiplication (...

There are 5 plates with 52 cookies on each plate. How many cookies are there in all?

Task card 8 2-Digit × 1-Digit Multiplication (...

$76 \times ___ = 304$

Task card 9 2-Digit × 1-Digit Multiplication (...

Multiply.

$$\begin{array}{r} 33 \\ \times\ 7 \\ \hline \end{array}$$

Task card 10 2-Digit × 1-Digit Multiplication (...

Multiply.

$$\begin{array}{r} 18 \\ \times\ 6 \\ \hline \end{array}$$

Task card 11 2-Digit × 1-Digit Multiplication (...

$7 \times 23 = ___$

Task card 12 2-Digit × 1-Digit Multiplication (...

The model breaks 33 into 30 and 3. Find the two parts and add them. 33 × 7 = ___

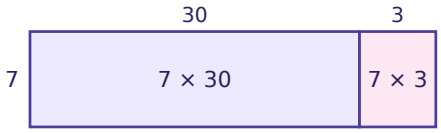

Task card 13 2-Digit × 1-Digit Multiplication (...

Break apart 29: 20 × 7 = 140 and 9 × 7 = 63. So 29 × 7 = ___

Task card 14 2-Digit × 1-Digit Multiplication (...

To find 89 × 9, multiply the tens first: 80 × 9 = ___

Task card 15 2-Digit × 1-Digit Multiplication (...

There are 9 baskets with 33 eggs in each basket. How many eggs are there in all?

Task card 16 2-Digit × 1-Digit Multiplication (...

86 × ___ = 516

Task card 17 2-Digit × 1-Digit Multiplication (...

Multiply.

$$\begin{array}{r} 54 \\ \times\ 4 \\ \hline \end{array}$$

Task card 18 2-Digit × 1-Digit Multiplication (...

Multiply.

$$\begin{array}{r} 97 \\ \times\ 4 \\ \hline \end{array}$$

Task card 19 2-Digit × 1-Digit Multiplication (...

$4 \times 54 = ___$

Task card 20 2-Digit × 1-Digit Multiplication (...

The model breaks 46 into 40 and 6. Find the two parts and add them. $46 \times 9 = ___$

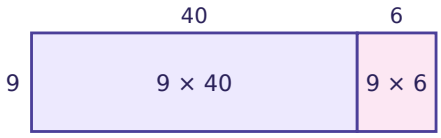

Task card 21 2-Digit × 1-Digit Multiplication (...

Break apart 86: $80 \times 8 = 640$ and $6 \times 8 = 48$. So $86 \times 8 = ___$

Task card 22 2-Digit × 1-Digit Multiplication (...

$59 + 59 = 59 \times 2 = ___$

Task card 23 2-Digit × 1-Digit Multiplication (...

There are 6 packs with 28 stickers in each pack. How many stickers are there in all?

Task card 24 2-Digit × 1-Digit Multiplication (...

$67 \times ___ = 536$

2-Digit × 1-Digit Multiplication (With Regrouping) Task Cards

Recording sheet · Grade 3 · Multiply. Every problem needs carrying. The same kind of product comes in different shapes.

Scan to check your answers

Name: _____ Date: _____

1	2	3	4
5	6	7	8
9	10	11	12
13	14	15	16
17	18	19	20
21	22	23	24

2-Digit × 1-Digit Multiplication (With Regrouping) Task Cards: Answer Key

Grade 3 · Medium

The answers online

1. 234	**2.** 340	**3.** 235
4. 425	**5.** 170	**6.** 264
7. 260	**8.** 4	**9.** 231
10. 108	**11.** 161	**12.** 231
13. 203	**14.** 720	**15.** 297
16. 6	**17.** 216	**18.** 388
19. 216	**20.** 414	**21.** 688
22. 118	**23.** 168	**24.** 8