Task card 1 2-Digit × 1-Digit Multiplication (...

Multiply.

$$\begin{array}{r} 26 \\ \times\ 2 \\ \hline \end{array}$$

Task card 2 2-Digit × 1-Digit Multiplication (...

Multiply.

$$\begin{array}{r} 37 \\ \times\ 2 \\ \hline \end{array}$$

Task card 3 2-Digit × 1-Digit Multiplication (...

$2 \times 25 = ___$

Task card 4 2-Digit × 1-Digit Multiplication (...

The model breaks 27 into 20 and 7. Find the two parts and add them. 27 × 3 = ___

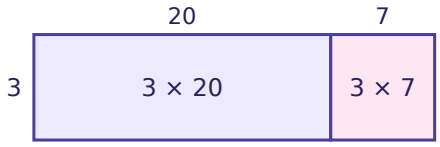

Task card 5 2-Digit × 1-Digit Multiplication (...

Break apart 49: 40 × 2 = 80 and 9 × 2 = 18. So 49 × 2 = ___

Task card 6 2-Digit × 1-Digit Multiplication (...

35 + 35 = 35 × 2 = ___

Task card 7 2-Digit × 1-Digit Multiplication (...

There are 3 rows with 24 chairs in each row. How many chairs are there in all?

Task card 8 2-Digit × 1-Digit Multiplication (...

$17 \times ___ = 34$

Task card 9 2-Digit × 1-Digit Multiplication (...

Multiply.

$$\begin{array}{r} 16 \\ \times\ 3 \\ \hline \end{array}$$

Task card 10 2-Digit × 1-Digit Multiplication (...

Multiply.

$$\begin{array}{r} 26 \\ \times\ 3 \\ \hline \end{array}$$

Task card 11 2-Digit × 1-Digit Multiplication (...

$3 \times 26 = ___$

Task card 12 2-Digit × 1-Digit Multiplication (...

The model breaks 39 into 30 and 9. Find the two parts and add them. $39 \times 2 = ___$

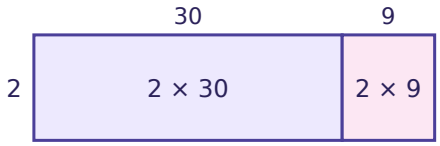

Task card 13 2-Digit × 1-Digit Multiplication (...

Break apart 28: 20 × 2 = 40 and 8 × 2 = 16. So 28 × 2 = ___

Task card 14 2-Digit × 1-Digit Multiplication (...

16 + 16 = 16 × 2 = ___

Task card 15 2-Digit × 1-Digit Multiplication (...

There are 2 teams with 19 players on each team. How many players are there in all?

Task card 16 2-Digit × 1-Digit Multiplication (...

28 × ___ = 56

Task card 17 2-Digit × 1-Digit Multiplication (...

Multiply.

$$\begin{array}{r} 13 \\ \times\ 4 \\ \hline \end{array}$$

Task card 18 2-Digit × 1-Digit Multiplication (...

Multiply.

$$\begin{array}{r} 39 \\ \times\ 2 \\ \hline \end{array}$$

Task card 19 2-Digit × 1-Digit Multiplication (...

$4 \times 18 = ___$

Task card 20 2-Digit × 1-Digit Multiplication (...

The model breaks 16 into 10 and 6. Find the two parts and add them. 16 × 6 = ___

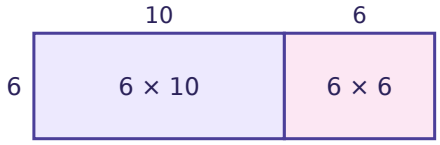

Task card 21 2-Digit × 1-Digit Multiplication (...

Break apart 14: 10 × 6 = 60 and 4 × 6 = 24. So 14 × 6 = ___

Task card 22 2-Digit × 1-Digit Multiplication (...

$19 + 19 = 19 \times 2 = ___$

Task card 23 2-Digit × 1-Digit Multiplication (...

There are 2 shelves with 29 books on each shelf. How many books are there in all?

Task card 24 2-Digit × 1-Digit Multiplication (...

$19 \times ___ = 95$

2-Digit × 1-Digit Multiplication (With Regrouping) Task Cards

Recording sheet · Grade 3 · Multiply. Every problem needs carrying. The same kind of product comes in different shapes.

Scan to check your answers

Name: _____ Date: _____

1	2	3	4
5	6	7	8
9	10	11	12
13	14	15	16
17	18	19	20
21	22	23	24

2-Digit × 1-Digit Multiplication (With Regrouping) Task Cards: Answer Key

Grade 3 · Easy

The answers online

1. 52	**2.** 74	**3.** 50
4. 81	**5.** 98	**6.** 70
7. 72	**8.** 2	**9.** 48
10. 78	**11.** 78	**12.** 78
13. 56	**14.** 32	**15.** 38
16. 2	**17.** 52	**18.** 78
19. 72	**20.** 96	**21.** 84
22. 38	**23.** 58	**24.** 5