Task card 1 2-Digit × 1-Digit Multiplication (...

Multiply.

$$\begin{array}{r} 12 \\ \times\ 3 \\ \hline \end{array}$$

Task card 2 2-Digit × 1-Digit Multiplication (...

Multiply.

$$\begin{array}{r} 51 \\ \times\ 2 \\ \hline \end{array}$$

Task card 3 2-Digit × 1-Digit Multiplication (...

$3 \times 63 = ___$

Task card 4 2-Digit × 1-Digit Multiplication (...

The model breaks 23 into 20 and 3. Find the two parts and add them. 23 × 2 = ___

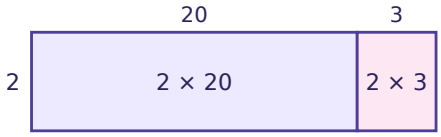

Task card 5 2-Digit × 1-Digit Multiplication (...

Break apart 31: 30 × 3 = 90 and 1 × 3 = 3. So 31 × 3 = ___

Task card 6 2-Digit × 1-Digit Multiplication (...

21 + 21 = 21 × 2 = ___

Task card 7 2-Digit × 1-Digit Multiplication (...

There are 4 boxes with 22 crayons in each box. How many crayons are there in all?

Task card 8 2-Digit × 1-Digit Multiplication (...

$41 \times ___ = 82$

Task card 9 2-Digit × 1-Digit Multiplication (...

Multiply.

$$\begin{array}{r} 72 \\ \times\ 3 \\ \hline \end{array}$$

Task card 10 2-Digit × 1-Digit Multiplication (...

Multiply.

$$\begin{array}{r} 10 \\ \times\ 3 \\ \hline \end{array}$$

Task card 11 2-Digit × 1-Digit Multiplication (...

$5 \times 40 = ___$

Task card 12 2-Digit × 1-Digit Multiplication (...

The model breaks 62 into 60 and 2. Find the two parts and add them. $62 \times 4 = ___$

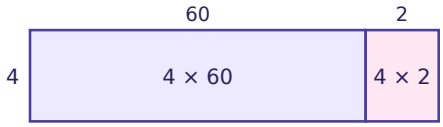

Task card 13 2-Digit × 1-Digit Multiplication (...

Break apart 53: 50 × 2 = 100 and 3 × 2 = 6. So 53 × 2 = ___

Task card 14 2-Digit × 1-Digit Multiplication (...

60 + 60 = 60 × 2 = ___

Task card 15 2-Digit × 1-Digit Multiplication (...

There are 2 baskets with 70 eggs in each basket. How many eggs are there in all?

Task card 16 2-Digit × 1-Digit Multiplication (...

11 × ___ = 55

Task card 17 2-Digit × 1-Digit Multiplication (...

Multiply.

$$\begin{array}{r} 31 \\ \times\ 6 \\ \hline \end{array}$$

Task card 18 2-Digit × 1-Digit Multiplication (...

Multiply.

$$\begin{array}{r} 50 \\ \times\ 9 \\ \hline \end{array}$$

Task card 19 2-Digit × 1-Digit Multiplication (...

$2 \times 41 = ___$

Task card 20 2-Digit × 1-Digit Multiplication (...

The model breaks 62 into 60 and 2. Find the two parts and add them. $62 \times 3 = ___$

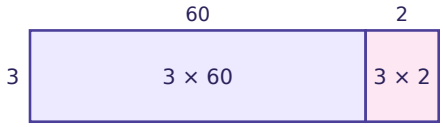

Task card 21 2-Digit × 1-Digit Multiplication (...

Break apart 42: $40 \times 4 = 160$ and $2 \times 4 = 8$. So $42 \times 4 = ___$

Task card 22 2-Digit × 1-Digit Multiplication (...

$10 + 10 + 10 = 10 \times 3 = ___$

Task card 23 2-Digit × 1-Digit Multiplication (...

There are 8 teams with 60 players on each team. How many players are there in all?

Task card 24 2-Digit × 1-Digit Multiplication (...

$41 \times ___ = 369$

2-Digit × 1-Digit Multiplication (No Regrouping) Task Cards

Recording sheet · Grade 3 · Multiply. No problem needs carrying. The same kind of product comes in different shapes.

Scan to check your answers

Name: _____ Date: _____

1	2	3	4
5	6	7	8
9	10	11	12
13	14	15	16
17	18	19	20
21	22	23	24

2-Digit × 1-Digit Multiplication (No Regrouping) Task Cards: Answer Key

Grade 3 · Medium

The answers online

1. 36	**2.** 102	**3.** 189
4. 46	**5.** 93	**6.** 42
7. 88	**8.** 2	**9.** 216
10. 30	**11.** 200	**12.** 248
13. 106	**14.** 120	**15.** 140
16. 5	**17.** 186	**18.** 450
19. 82	**20.** 186	**21.** 168
22. 30	**23.** 480	**24.** 9