Task card 1 100th Day of School Math

A party pizza is cut into 8 equal slices. The family eats 3 slices. What fraction of the party pizza did they eat?

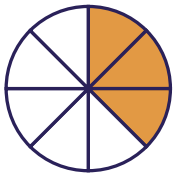

Task card 2 100th Day of School Math

Leo shares 60 cookies equally among 6 friends. How many cookies does each friend get?

Task card 3 100th Day of School Math

Mia shares 90 cupcakes equally among 9 friends. How many cupcakes does each friend get?

Task card 4 100th Day of School Math

The 100th Day party starts at 10:30. It lasts 3 hours. What time does the party end?



Task card 5 100th Day of School Math

At the 100th Day party there are 8 tables. 4 people sit at each table. How many people are there?

Task card 6 100th Day of School Math

The 100th Day party starts at 9:30. It lasts 5 hours. What time does the party end?



Task card 7 100th Day of School Math

A party pizza is cut into 8 equal slices. The family eats 1 slice. What fraction of the party pizza did they eat?

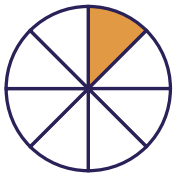

Task card 8 100th Day of School Math

At the 100th Day party there are 7 tables. 8 people sit at each table. How many people are there?

Task card 9 100th Day of School Math

Zoe shares 48 cupcakes equally among 8 friends. How many cupcakes does each friend get?

Task card 10 100th Day of School Math

At the 100th Day party there are 6 tables. 6 people sit at each table. How many people are there?

Task card 11 100th Day of School Math

The 100th Day party starts at 12:00. It lasts 4 hours. What time does the party end?



Task card 12 100th Day of School Math

At the 100th Day party there are 5 tables. 5 people sit at each table. How many people are there?

Task card 13 100th Day of School Math

The 100th Day party starts at 11:30. It lasts 2 hours. What time does the party end?



Task card 14 100th Day of School Math

A party pizza is cut into 6 equal slices. The family eats 5 slices. What fraction of the party pizza did they eat?

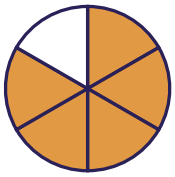

Task card 15 100th Day of School Math

Ava shares 16 cupcakes equally among 2 friends. How many cupcakes does each friend get?

Task card 16 100th Day of School Math

A party pizza is cut into 12 equal slices. The family eats 7 slices. What fraction of the party pizza did they eat?

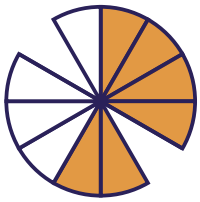

Task card 17 100th Day of School Math

A party pizza is cut into 10 equal slices. The family eats 7 slices. What fraction of the party pizza did they eat?

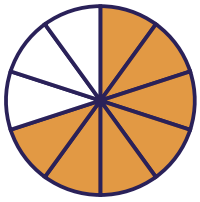

Task card 18 100th Day of School Math

At the 100th Day party there are 3 tables. 2 people sit at each table. How many people are there?

Task card 19 100th Day of School Math

Zoe shares 56 cupcakes equally among 8 friends. How many cupcakes does each friend get?

Task card 20 100th Day of School Math

The 100th Day party starts at 12:30. It lasts 3 hours. What time does the party end?



Task card 21 100th Day of School Math

At the 100th Day party there are 9 tables. 8 people sit at each table. How many people are there?

Task card 22 100th Day of School Math

Lily shares 81 pretzels equally among 9 friends. How many pretzels does each friend get?

Task card 23 100th Day of School Math

A party pizza is cut into 6 equal slices. The family eats 1 slice. What fraction of the party pizza did they eat?

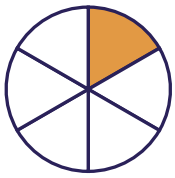

Task card 24 100th Day of School Math

A party pizza is cut into 12 equal slices. The family eats 11 slices. What fraction of the party pizza did they eat?

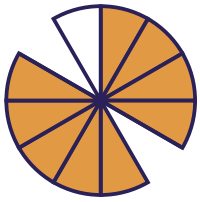

100th Day of School Math Task Cards

Recording sheet · Grade 3 · Read each story and solve. Write times like 3:00 and fractions like 3/8.

Name: _____ Date: _____

Scan to check your answers

1	2	3	4
5	6	7	8
9	10	11	12
13	14	15	16
17	18	19	20
21	22	23	24

100th Day of School Math Task Cards: Answer Key

Grade 3 · Hard

The answers online

1. $\frac{3}{8}$	**2.** 10	**3.** 10
4. 1:30	**5.** 32	**6.** 2:30
7. $\frac{1}{8}$	**8.** 56	**9.** 6
10. 36	**11.** 4:00	**12.** 25
13. 1:30	**14.** $\frac{5}{6}$	**15.** 8
16. $\frac{7}{12}$	**17.** $\frac{7}{10}$	**18.** 6
19. 7	**20.** 3:30	**21.** 72
22. 9	**23.** $\frac{1}{6}$	**24.** $\frac{11}{12}$