100th Day of School Math · 1

A party pizza is cut into 8 equal slices. The family eats 3 slices. What fraction of the party pizza did they eat?

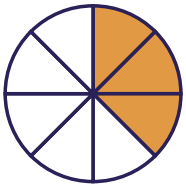

100th Day of School Math · 2

Leo shares 60 cookies equally among 6 friends. How many cookies does each friend get?

100th Day of School Math · 3

Mia shares 90 cupcakes equally among 9 friends. How many cupcakes does each friend get?

100th Day of School Math · 4

The 100th Day party starts at 10:30. It lasts 3 hours. What time does the party end?



100th Day of School Math · 5

At the 100th Day party there are 8 tables. 4 people sit at each table. How many people are there?

100th Day of School Math · 6

The 100th Day party starts at 9:30. It lasts 5 hours. What time does the party end?



100th Day of School Math · 7

A party pizza is cut into 8 equal slices. The family eats 1 slice. What fraction of the party pizza did they eat?

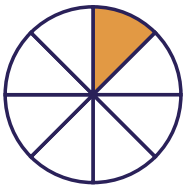

100th Day of School Math · 8

At the 100th Day party there are 7 tables. 8 people sit at each table. How many people are there?

100th Day of School Math · 2

ANSWER

10

100th Day of School Math · 1

ANSWER

$$\frac{3}{8}$$

100th Day of School Math · 4

ANSWER

1:30

100th Day of School Math · 3

ANSWER

10

100th Day of School Math · 6

ANSWER

2:30

100th Day of School Math · 5

ANSWER

32

100th Day of School Math · 8

ANSWER

56

100th Day of School Math · 7

ANSWER

$$\frac{1}{8}$$

100th Day of School Math · 9

Zoe shares 48 cupcakes equally among 8 friends. How many cupcakes does each friend get?

100th Day of School Math · 10

At the 100th Day party there are 6 tables. 6 people sit at each table. How many people are there?

100th Day of School Math · 11

The 100th Day party starts at 12:00. It lasts 4 hours. What time does the party end?



100th Day of School Math · 12

At the 100th Day party there are 5 tables. 5 people sit at each table. How many people are there?

100th Day of School Math · 13

The 100th Day party starts at 11:30. It lasts 2 hours. What time does the party end?



100th Day of School Math · 14

A party pizza is cut into 6 equal slices. The family eats 5 slices. What fraction of the party pizza did they eat?

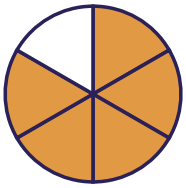

100th Day of School Math · 15

Ava shares 16 cupcakes equally among 2 friends. How many cupcakes does each friend get?

100th Day of School Math · 16

A party pizza is cut into 12 equal slices. The family eats 7 slices. What fraction of the party pizza did they eat?



100th Day of School Math · 10

ANSWER

36

100th Day of School Math · 9

ANSWER

6

100th Day of School Math · 12

ANSWER

25

100th Day of School Math · 11

ANSWER

4:00

100th Day of School Math · 14

ANSWER

$$\frac{5}{6}$$

100th Day of School Math · 13

ANSWER

1:30

100th Day of School Math · 16

ANSWER

$$\frac{7}{12}$$

100th Day of School Math · 15

ANSWER

8

100th Day of School Math · 17

A party pizza is cut into 10 equal slices. The family eats 7 slices. What fraction of the party pizza did they eat?

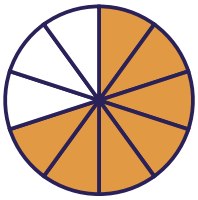

100th Day of School Math · 18

At the 100th Day party there are 3 tables. 2 people sit at each table. How many people are there?

100th Day of School Math · 19

Zoe shares 56 cupcakes equally among 8 friends. How many cupcakes does each friend get?

100th Day of School Math · 20

The 100th Day party starts at 12:30. It lasts 3 hours. What time does the party end?



100th Day of School Math · 21

At the 100th Day party there are 9 tables. 8 people sit at each table. How many people are there?

100th Day of School Math · 22

Lily shares 81 pretzels equally among 9 friends. How many pretzels does each friend get?

100th Day of School Math · 23

A party pizza is cut into 6 equal slices. The family eats 1 slice. What fraction of the party pizza did they eat?

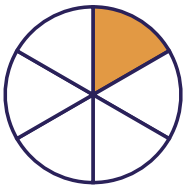

100th Day of School Math · 24

A party pizza is cut into 12 equal slices. The family eats 11 slices. What fraction of the party pizza did they eat?

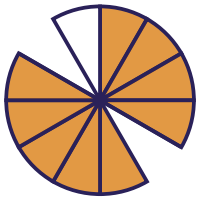

100th Day of School Math · 18

ANSWER

6

100th Day of School Math · 17

ANSWER

$$\frac{7}{10}$$

100th Day of School Math · 20

ANSWER

3:30

100th Day of School Math · 19

ANSWER

7

100th Day of School Math · 22

ANSWER

9

100th Day of School Math · 21

ANSWER

72

100th Day of School Math · 24

ANSWER

$$\frac{11}{12}$$

100th Day of School Math · 23

ANSWER

$$\frac{1}{6}$$