100th Day of School Math · 1

The 100th Day party starts at 11:00. It lasts 4 hours. What time does the party end?



100th Day of School Math · 2

The 100th Day party starts at 10:00. It lasts 3 hours. What time does the party end?



100th Day of School Math · 3

At the 100th Day party there are 5 tables. 3 people sit at each table. How many people are there?

100th Day of School Math · 4

Ava shares 12 cupcakes equally among 4 friends. How many cupcakes does each friend get?

100th Day of School Math · 5

A party pizza is cut into 8 equal slices. The family eats 5 slices. What fraction of the party pizza did they eat?

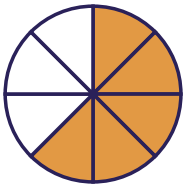

100th Day of School Math · 6

Ella shares 36 cookies equally among 9 friends. How many cookies does each friend get?

100th Day of School Math · 7

At the 100th Day party there are 6 tables. 4 people sit at each table. How many people are there?

100th Day of School Math · 8

Zoe shares 16 cupcakes equally among 4 friends. How many cupcakes does each friend get?

100th Day of School Math · 2

ANSWER

1:00

100th Day of School Math · 1

ANSWER

3:00

100th Day of School Math · 4

ANSWER

3

100th Day of School Math · 3

ANSWER

15

100th Day of School Math · 6

ANSWER

4

100th Day of School Math · 5

ANSWER

$$\frac{5}{8}$$

100th Day of School Math · 8

ANSWER

4

100th Day of School Math · 7

ANSWER

24

100th Day of School Math · 9

The 100th Day party starts at 9:00. It lasts 4 hours. What time does the party end?



100th Day of School Math · 10

Ben shares 14 cookies equally among 7 friends. How many cookies does each friend get?

100th Day of School Math · 11

Omar shares 20 cookies equally among 5 friends. How many cookies does each friend get?

100th Day of School Math · 12

A party pizza is cut into 4 equal slices. The family eats 1 slice. What fraction of the party pizza did they eat?



100th Day of School Math · 13

The 100th Day party starts at 10:00. It lasts 4 hours. What time does the party end?



100th Day of School Math · 14

A party pizza is cut into 6 equal slices. The family eats 5 slices. What fraction of the party pizza did they eat?

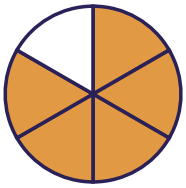

100th Day of School Math · 15

At the 100th Day party there are 6 tables. 3 people sit at each table. How many people are there?

100th Day of School Math · 16

At the 100th Day party there are 6 tables. 6 people sit at each table. How many people are there?

100th Day of School Math · 10

ANSWER

2

100th Day of School Math · 9

ANSWER

1:00

100th Day of School Math · 12

ANSWER

$\frac{1}{4}$

100th Day of School Math · 11

ANSWER

4

100th Day of School Math · 14

ANSWER

$\frac{5}{6}$

100th Day of School Math · 13

ANSWER

2:00

100th Day of School Math · 16

ANSWER

36

100th Day of School Math · 15

ANSWER

18

100th Day of School Math · 17

The 100th Day party starts at 10:00. It lasts 5 hours. What time does the party end?



100th Day of School Math · 18

Sam shares 9 pretzels equally among 3 friends. How many pretzels does each friend get?

100th Day of School Math · 19

A party pizza is cut into 8 equal slices. The family eats 1 slice. What fraction of the party pizza did they eat?

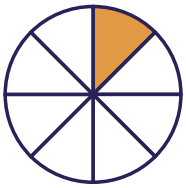

100th Day of School Math · 20

At the 100th Day party there are 3 tables. 7 people sit at each table. How many people are there?

100th Day of School Math · 21

Ben shares 28 cupcakes equally among 4 friends. How many cupcakes does each friend get?

100th Day of School Math · 22

At the 100th Day party there are 4 tables. 4 people sit at each table. How many people are there?

100th Day of School Math · 23

The 100th Day party starts at 11:00. It lasts 3 hours. What time does the party end?



100th Day of School Math · 24

The 100th Day party starts at 11:00. It lasts 2 hours. What time does the party end?



100th Day of School Math · 18

ANSWER

3

100th Day of School Math · 17

ANSWER

3:00

100th Day of School Math · 20

ANSWER

21

100th Day of School Math · 19

ANSWER

$$\frac{1}{8}$$

100th Day of School Math · 22

ANSWER

16

100th Day of School Math · 21

ANSWER

7

100th Day of School Math · 24

ANSWER

1:00

100th Day of School Math · 23

ANSWER

2:00