Task card 1 Winter Math

Sam puts 3 snowball cookies on each of 3 plates. How many snowball cookies is that in all?



Task card 2 Winter Math

The school bakes 23 cinnamon rolls and 26 cocoa muffins for the bake sale. How many treats is that in all?

Task card 3 Winter Math

Noah buys a paper snowflake for 35¢ and a blue streamer for 20¢. How many cents does Noah spend?

Task card 4 Winter Math

The school bakes 23 snowball cookies and 63 cocoa muffins for the bake sale. How many treats is that in all?

Task card 5 Winter Math

The bakery makes 32 snowball cookies. It sells 16 of them. How many snowball cookies are left?

Task card 6 Winter Math

Ella buys a paper snowflake for 20¢ and a blue streamer for 5¢. How many cents does Ella spend?

Task card 7 Winter Math

The bakery makes 95 cinnamon rolls. It sells 37 of them. How many cinnamon rolls are left?

Task card 8 Winter Math

Sam puts 4 snowball cookies on each of 2 plates. How many snowball cookies is that in all?



Task card 9 Winter Math

The school bakes 151 snowball cookies and 74 cocoa muffins for the bake sale. How many treats is that in all?

Task card 10 Winter Math

The school bakes 244 cinnamon rolls and 120 cocoa muffins for the bake sale. How many treats is that in all?

Task card 11 Winter Math

The bakery makes 228 cinnamon rolls. It sells 176 of them. How many cinnamon rolls are left?

Task card 12 Winter Math

Ella buys a snowman sticker for 35¢ and a paper snowflake for 30¢. How many cents does Ella spend?

Task card 13 Winter Math

The bakery makes 300 snowball cookies. It sells 254 of them. How many snowball cookies are left?

Task card 14 Winter Math

Ava puts 3 cocoa muffins on each of 3 plates. How many cocoa muffins is that in all?



Task card 15 Winter Math

Ella puts 3 cocoa muffins on each of 3 plates. How many cocoa muffins is that in all?



Task card 16 Winter Math

Mia buys a blue streamer for 30¢ and a paper snowflake for 25¢. How many cents does Mia spend?

Task card 17 Winter Math

The school bakes 31 cinnamon rolls and 198 snowball cookies for the bake sale. How many treats is that in all?

Task card 18 Winter Math

Lily buys a snowman sticker for 45¢ and a blue streamer for 10¢. How many cents does Lily spend?

Task card 19 Winter Math

Lily buys a blue streamer for 45¢ and a snowman sticker for 20¢. How many cents does Lily spend?

Task card 20 Winter Math

The bakery makes 221 snowball cookies. It sells 59 of them. How many snowball cookies are left?

Task card 21 Winter Math

Lily puts 5 snowball cookies on each of 2 plates. How many snowball cookies is that in all?



Task card 22 Winter Math

Mia puts 3 cocoa muffins on each of 2 plates. How many cocoa muffins is that in all?



Task card 23 Winter Math

The bakery makes 448 cocoa muffins. It sells 299 of them. How many cocoa muffins are left?

Task card 24 Winter Math

The school bakes 145 cocoa muffins and 308 cinnamon rolls for the bake sale. How many treats is that in all?

Winter Math Task Cards

Recording sheet · Grade 2 · Read each story and solve.

Name: _____ Date: _____

Scan to check your answers

1	2	3	4
5	6	7	8
9	10	11	12
13	14	15	16
17	18	19	20
21	22	23	24

Winter Math Task Cards: Answer Key

Grade 2 · Medium

The answers online

1. 9	**2.** 49	**3.** 55
4. 86	**5.** 16	**6.** 25
7. 58	**8.** 8	**9.** 225
10. 364	**11.** 52	**12.** 65
13. 46	**14.** 9	**15.** 9
16. 55	**17.** 229	**18.** 55
19. 65	**20.** 162	**21.** 10
22. 6	**23.** 149	**24.** 453