**Task card 1** Winter Math

The bakery makes 336 cocoa muffins. It sells 68 of them. How many cocoa muffins are left?

**Task card 2** Winter Math

Zoe buys a snowman sticker for 20¢ and a blue streamer for 55¢. How many cents does Zoe spend?

**Task card 3** Winter Math

Ava buys a paper snowflake for 10¢ and a blue streamer for 25¢. How many cents does Ava spend?

**Task card 4** Winter Math

The school bakes 222 snowball cookies and 254 cinnamon rolls for the bake sale. How many treats is that in all?

**Task card 5** Winter Math

Sam puts 2 cocoa muffins on each of 3 plates. How many cocoa muffins is that in all?



**Task card 6** Winter Math

The bakery makes 404 cocoa muffins. It sells 240 of them. How many cocoa muffins are left?

**Task card 7** Winter Math

The school bakes 126 snowball cookies and 129 cinnamon rolls for the bake sale. How many treats is that in all?

**Task card 8** Winter Math

Mia puts 2 snowball cookies on each of 4 plates. How many snowball cookies is that in all?



**Task card 9** Winter Math

The bakery makes 346 cocoa muffins. It sells 341 of them. How many cocoa muffins are left?

**Task card 10** Winter Math

Lily buys a paper snowflake for 40¢ and a snowman sticker for 10¢. How many cents does Lily spend?

**Task card 11** Winter Math

Omar puts 5 cocoa muffins on each of 2 plates. How many cocoa muffins is that in all?



**Task card 12** Winter Math

Leo buys a blue streamer for 10¢ and a snowman sticker for 60¢. How many cents does Leo spend?

**Task card 13** Winter Math

The bakery makes 426 cocoa muffins. It sells 63 of them. How many cocoa muffins are left?

**Task card 14** Winter Math

The school bakes 103 snowball cookies and 146 cocoa muffins for the bake sale. How many treats is that in all?

**Task card 15** Winter Math

The school bakes 193 snowball cookies and 67 cocoa muffins for the bake sale. How many treats is that in all?

**Task card 16** Winter Math

Zoe puts 3 cinnamon rolls on each of 3 plates. How many cinnamon rolls is that in all?



**Task card 17** Winter Math

Sam puts 4 snowball cookies on each of 5 plates. How many snowball cookies is that in all?



**Task card 18** Winter Math

Ava buys a paper snowflake for 35¢ and a snowman sticker for 40¢. How many cents does Ava spend?

**Task card 19** Winter Math

The school bakes 248 snowball cookies and 70 cocoa muffins for the bake sale. How many treats is that in all?

**Task card 20** Winter Math

The bakery makes 315 snowball cookies. It sells 24 of them. How many snowball cookies are left?

**Task card 21** Winter Math

Noah puts 2 cinnamon rolls on each of 4 plates. How many cinnamon rolls is that in all?



**Task card 22** Winter Math

The bakery makes 161 cinnamon rolls. It sells 131 of them. How many cinnamon rolls are left?

**Task card 23** Winter Math

The school bakes 124 snowball cookies and 198 cocoa muffins for the bake sale. How many treats is that in all?

**Task card 24** Winter Math

Zoe buys a paper snowflake for 10¢ and a blue streamer for 15¢. How many cents does Zoe spend?

# Winter Math Task Cards

Recording sheet · Grade 2 · Read each story and solve.

Name: _____ Date: _____

Scan to check your answers

| | | | |
|---|---|---|---|
| 1 | 2 | 3 | 4 |
| 5 | 6 | 7 | 8 |
| 9 | 10 | 11 | 12 |
| 13 | 14 | 15 | 16 |
| 17 | 18 | 19 | 20 |
| 21 | 22 | 23 | 24 |

# Winter Math Task Cards: Answer Key

Grade 2 · Hard

The answers online

| | | |
|---|---|---|
| **1.** 268 | **2.** 75 | **3.** 35 |
| **4.** 476 | **5.** 6 | **6.** 164 |
| **7.** 255 | **8.** 8 | **9.** 5 |
| **10.** 50 | **11.** 10 | **12.** 70 |
| **13.** 363 | **14.** 249 | **15.** 260 |
| **16.** 9 | **17.** 20 | **18.** 75 |
| **19.** 318 | **20.** 291 | **21.** 8 |
| **22.** 30 | **23.** 322 | **24.** 25 |