Winter Math · 1

Sam puts 3 snowball cookies on each of 3 plates. How many snowball cookies is that in all?



Winter Math · 2

The school bakes 23 cinnamon rolls and 26 cocoa muffins for the bake sale. How many treats is that in all?

Winter Math · 3

Noah buys a paper snowflake for 35¢ and a blue streamer for 20¢. How many cents does Noah spend?

Winter Math · 4

The school bakes 23 snowball cookies and 63 cocoa muffins for the bake sale. How many treats is that in all?

Winter Math · 5

The bakery makes 32 snowball cookies. It sells 16 of them. How many snowball cookies are left?

Winter Math · 6

Ella buys a paper snowflake for 20¢ and a blue streamer for 5¢. How many cents does Ella spend?

Winter Math · 7

The bakery makes 95 cinnamon rolls. It sells 37 of them. How many cinnamon rolls are left?

Winter Math · 8

Sam puts 4 snowball cookies on each of 2 plates. How many snowball cookies is that in all?



Winter Math · 2

ANSWER

49

Winter Math · 1

ANSWER

9

Winter Math · 4

ANSWER

86

Winter Math · 3

ANSWER

55

Winter Math · 6

ANSWER

25

Winter Math · 5

ANSWER

16

Winter Math · 8

ANSWER

8

Winter Math · 7

ANSWER

58

Winter Math · 9

The school bakes 151 snowball cookies and 74 cocoa muffins for the bake sale. How many treats is that in all?

Winter Math · 10

The school bakes 244 cinnamon rolls and 120 cocoa muffins for the bake sale. How many treats is that in all?

Winter Math · 11

The bakery makes 228 cinnamon rolls. It sells 176 of them. How many cinnamon rolls are left?

Winter Math · 12

Ella buys a snowman sticker for 35¢ and a paper snowflake for 30¢. How many cents does Ella spend?

Winter Math · 13

The bakery makes 300 snowball cookies. It sells 254 of them. How many snowball cookies are left?

Winter Math · 14

Ava puts 3 cocoa muffins on each of 3 plates. How many cocoa muffins is that in all?



Winter Math · 15

Ella puts 3 cocoa muffins on each of 3 plates. How many cocoa muffins is that in all?



Winter Math · 16

Mia buys a blue streamer for 30¢ and a paper snowflake for 25¢. How many cents does Mia spend?

Winter Math · 10

ANSWER

364

Winter Math · 9

ANSWER

225

Winter Math · 12

ANSWER

65

Winter Math · 11

ANSWER

52

Winter Math · 14

ANSWER

9

Winter Math · 13

ANSWER

46

Winter Math · 16

ANSWER

55

Winter Math · 15

ANSWER

9

Winter Math · 17

The school bakes 31 cinnamon rolls and 198 snowball cookies for the bake sale. How many treats is that in all?

Winter Math · 18

Lily buys a snowman sticker for 45¢ and a blue streamer for 10¢. How many cents does Lily spend?

Winter Math · 19

Lily buys a blue streamer for 45¢ and a snowman sticker for 20¢. How many cents does Lily spend?

Winter Math · 20

The bakery makes 221 snowball cookies. It sells 59 of them. How many snowball cookies are left?

Winter Math · 21

Lily puts 5 snowball cookies on each of 2 plates. How many snowball cookies is that in all?



Winter Math · 22

Mia puts 3 cocoa muffins on each of 2 plates. How many cocoa muffins is that in all?



Winter Math · 23

The bakery makes 448 cocoa muffins. It sells 299 of them. How many cocoa muffins are left?

Winter Math · 24

The school bakes 145 cocoa muffins and 308 cinnamon rolls for the bake sale. How many treats is that in all?

Winter Math · 18

ANSWER

55

Winter Math · 17

ANSWER

229

Winter Math · 20

ANSWER

162

Winter Math · 19

ANSWER

65

Winter Math · 22

ANSWER

6

Winter Math · 21

ANSWER

10

Winter Math · 24

ANSWER

453

Winter Math · 23

ANSWER

149